Trovare gli angoli nelle figure

Nome:

Conta il nuemro di angoli 'acuti', 'ottusi' e 'retti' in ogni forma.

Es)

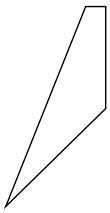

1)

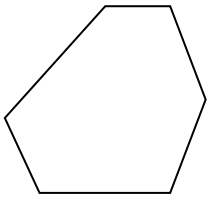

2)

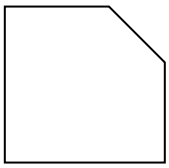

3)

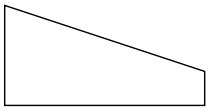

4)

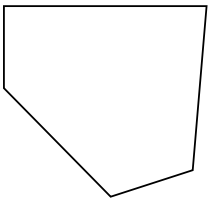

5)



6)

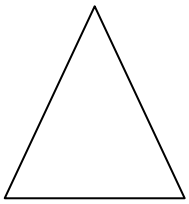

7)

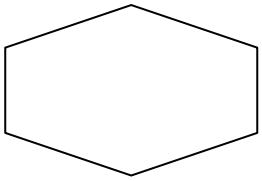

8)



9)



10)

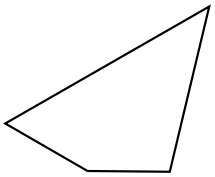

11)

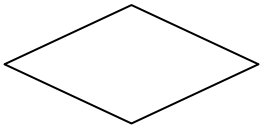

Risposte

Es.	1	2	1
1.			
2.			
3.			
4.			
5.			
6.			
7.			
8.			
9.			
10.			
11.			

1-10	91	82	73	64	55	45	36	27	18	9
11	0									

Trovare gli angoli nelle figure

Nome: **Soluzioni**

Conta il nuemro di angoli 'acuti', 'ottusi' e 'retti' in ogni forma.

Es)

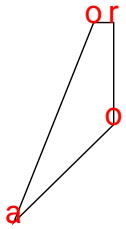

1)

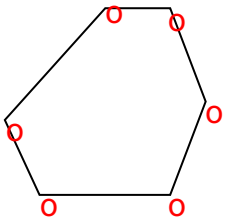

2)

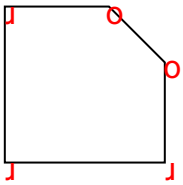

3)

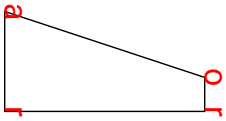

4)

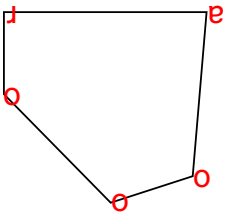

5)

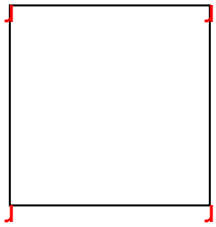

6)

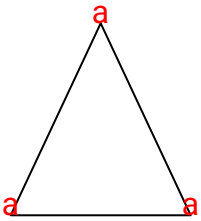

7)

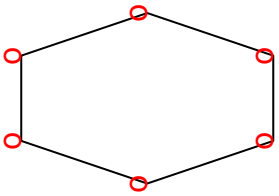

8)

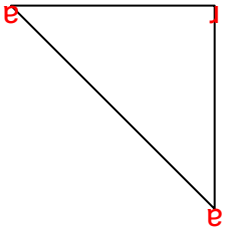

9)

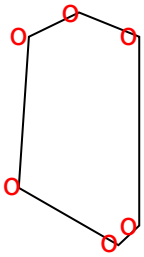

10)

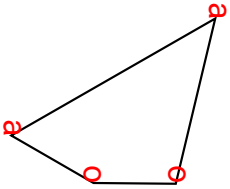

11)

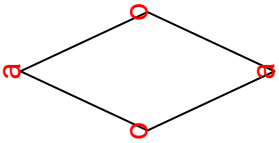

Risposte

Es.	1	2	1
1.	0	6	0
2.	0	2	3
3.	1	1	2
4.	1	3	1
5.	0	0	4
6.	3	0	0
7.	0	6	0
8.	2	0	1
9.	0	6	0
10.	2	2	0
11.	2	2	0