Trovare gli angoli nelle figure

Nome:

Conta il nuemro di angoli 'acuti', 'ottusi', 'retti' e 'concavi' in ogni forma.

Es)

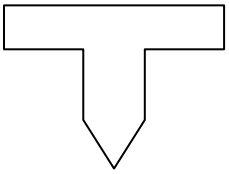

1)

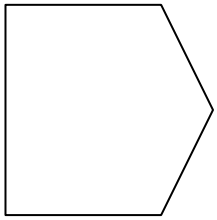

2)

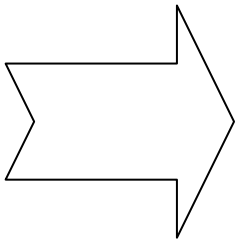

3)

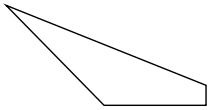

4)

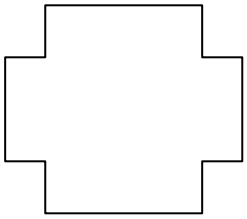

5)

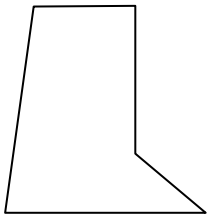

6)



7)



8)

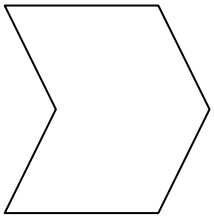

9)

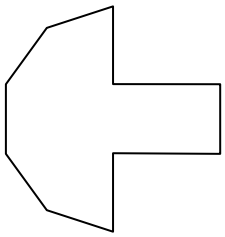

10)

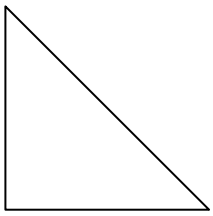

11)

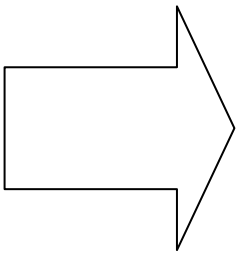

Risposte

Es.	1	2	4	2
1.				
2.				
3.				
4.				
5.				
6.				
7.				
8.				
9.				
10.				
11.				

1-10	91	82	73	64	55	45	36	27	18	9
11	0									

Trovare gli angoli nelle figure

Nome: **Soluzioni**

Conta il nuemro di angoli 'acuti', 'ottusi', 'retti' e 'concavi' in ogni forma.

Es)

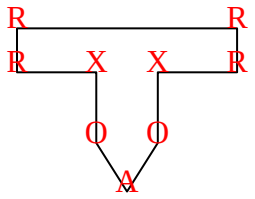

1)

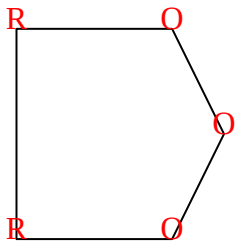

2)

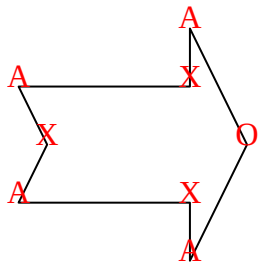

3)

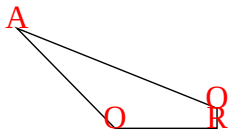

4)

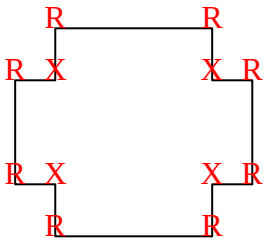

5)

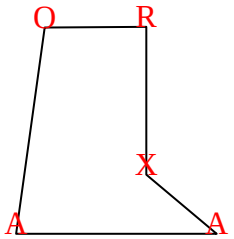

6)

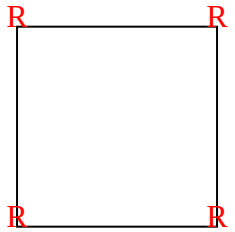

7)



8)

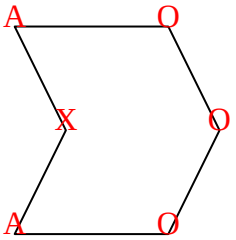

9)

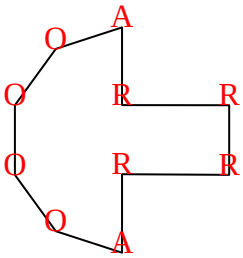

10)

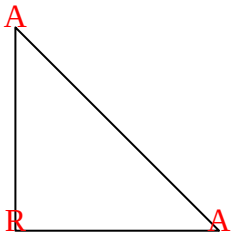

11)

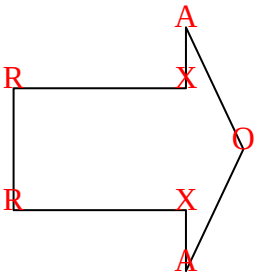

Risposte

Es.	1	2	4	2
1.	0	3	2	0
2.	4	1	0	3
3.	1	2	1	0
4.	0	0	8	4
5.	2	1	1	1
6.	0	0	4	0
7.	0	0	4	0
8.	2	3	0	1
9.	2	4	4	0
10.	2	0	1	0
11.	2	1	2	2

1-10	91	82	73	64	55	45	36	27	18	9
11	0									