Divisioni con la linea numerata

Nome:

Usa la linea numerata per risolvere ogni problema.

1) 16:8=

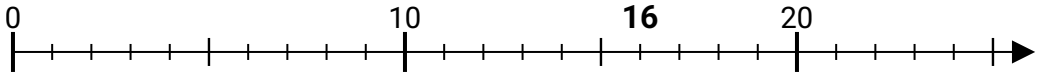

2) 27:9=

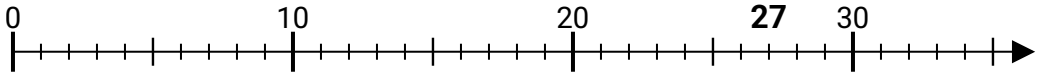

3) 18:6=

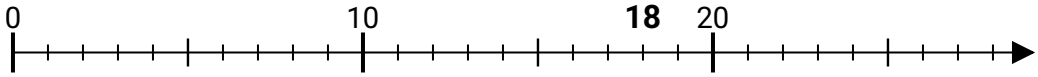

4) 21:7=

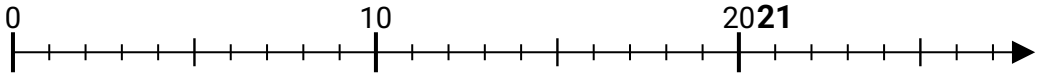

5) 24:6=

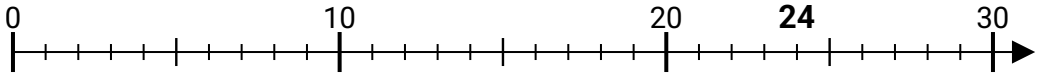

6) 32:8=

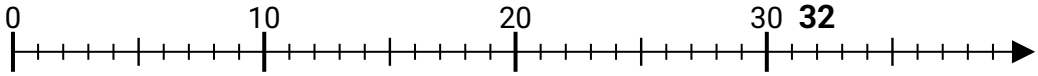

7) 50:10=

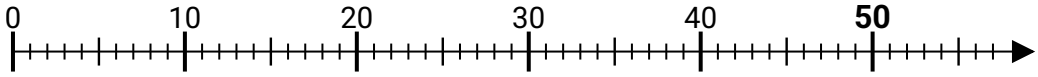

8) 28:7=

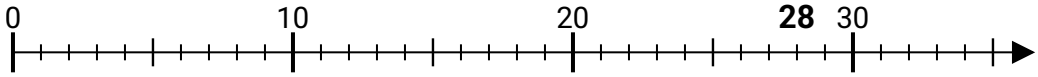

9) 12:4=

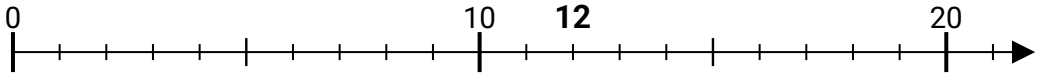

10) 40:8=

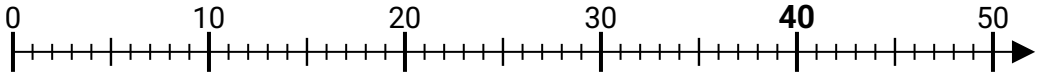

11) 6:2=

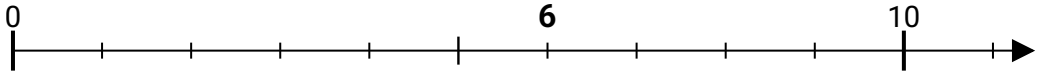

Risposte

1. _____
2. _____
3. _____
4. _____
5. _____
6. _____
7. _____
8. _____
9. _____
10. _____
11. _____

Divisioni con la linea numerata

Nome: **Soluzioni**

Usa la linea numerata per risolvere ogni problema.

1) 16:8=

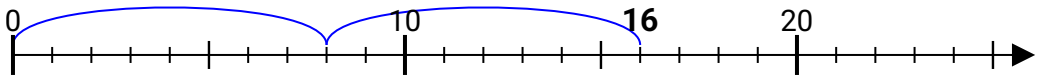

2) 27:9=

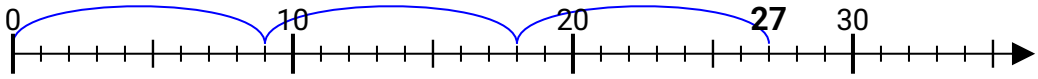

3) 18:6=

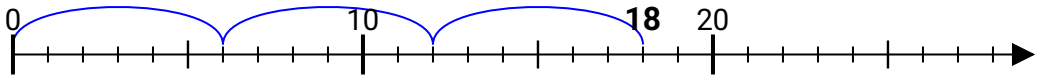

4) 21:7=

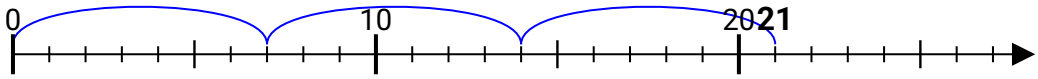

5) 24:6=

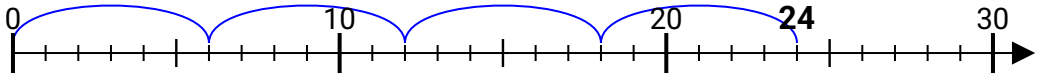

6) 32:8=

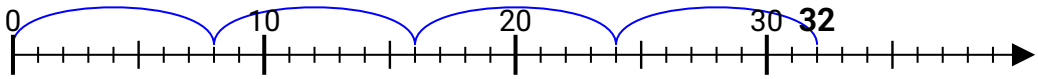

7) 50:10=

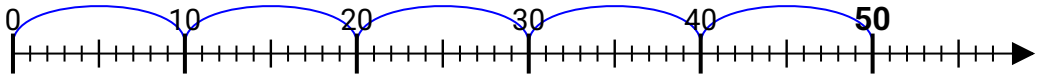

8) 28:7=

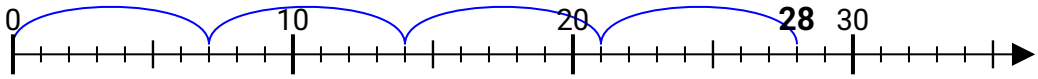

9) 12:4=

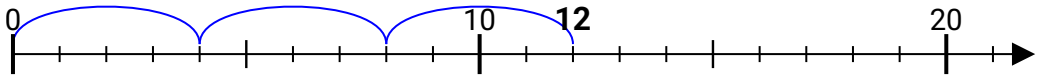

10) 40:8=

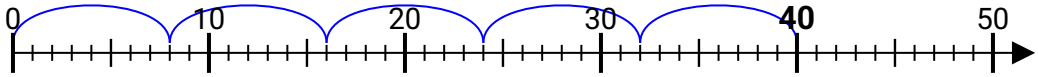

11) 6:2=

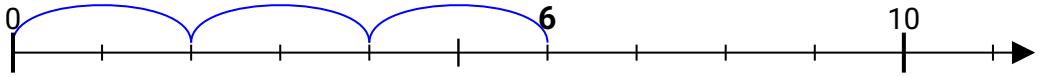

Risposte

1. 2
2. 3
3. 3
4. 3
5. 4
6. 4
7. 5
8. 4
9. 3
10. 5
11. 3