Usa la linea numerata per risolvere ogni problema.

1) 12:6=

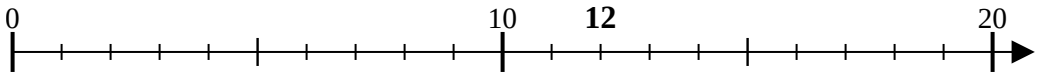

2) 50:10=

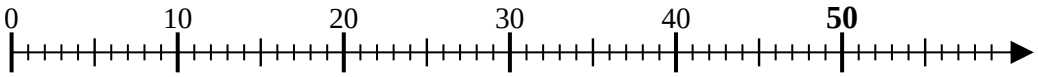

3) 6:2=

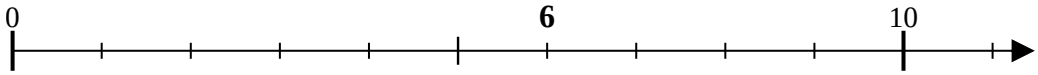

4) 10:5=

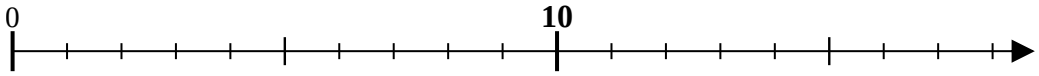

5) 16:8=

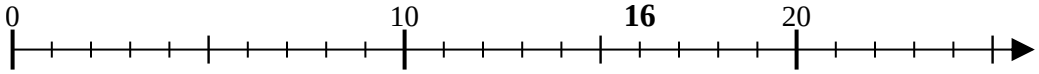

6) 8:2=

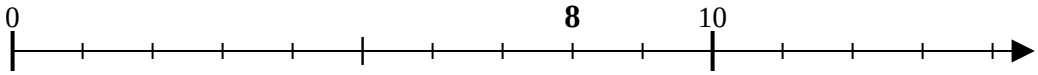

7) 35:7=

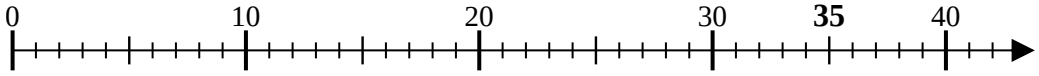

8) 40:10=

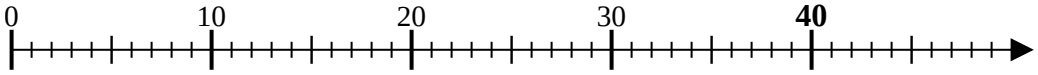

9) 18:6=

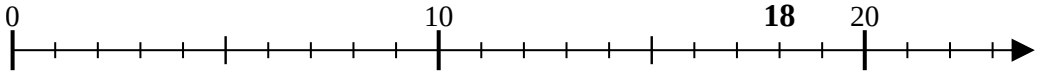

10) 25:5=

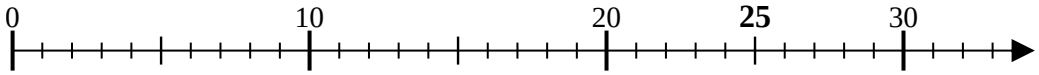

11) 30:6=

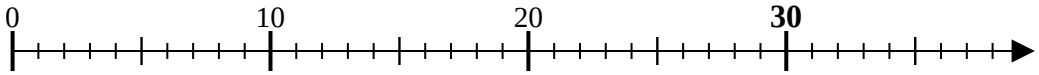

Risposte

1. _____
2. _____
3. _____
4. _____
5. _____
6. _____
7. _____
8. _____
9. _____
10. _____
11. _____

1-10	91	82	73	64	55	45	36	27	18	9
11	0									

Divisioni con la linea numerata Nome: **Soluzioni**

Usa la linea numerata per risolvere ogni problema.

1) 12:6=

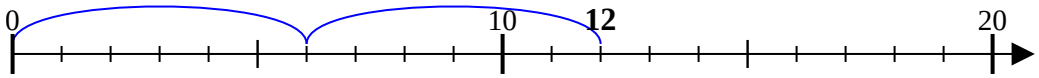

2) 50:10=

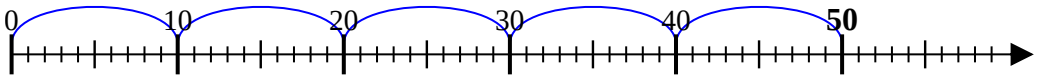

3) 6:2=

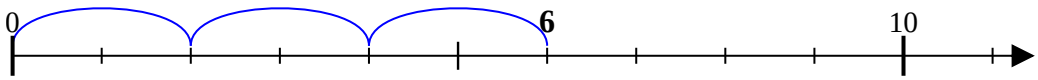

4) 10:5=

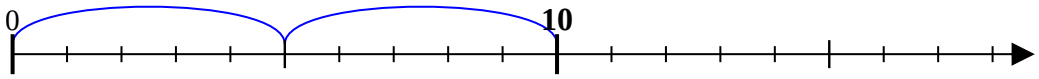

5) 16:8=

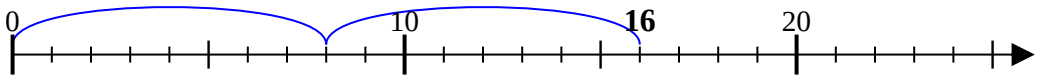

6) 8:2=

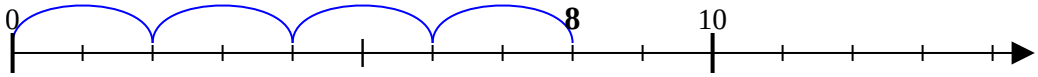

7) 35:7=

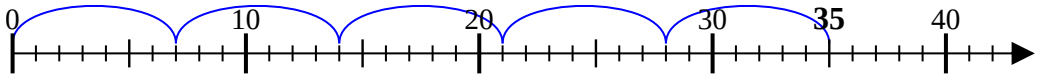

8) 40:10=

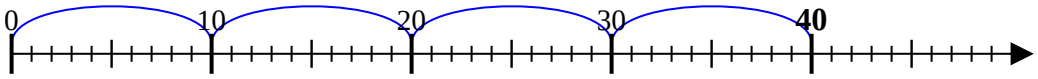

9) 18:6=

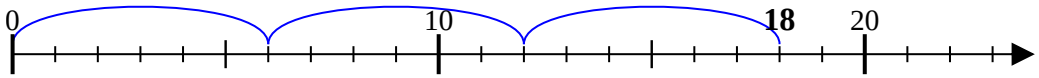

10) 25:5=

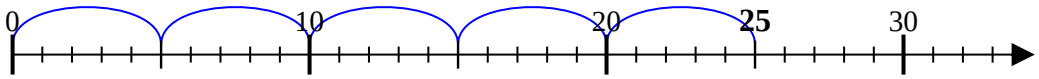

11) 30:6=

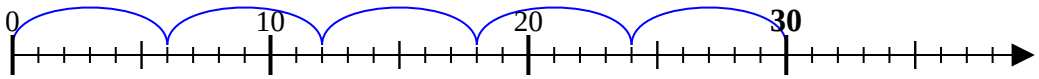

Risposte

1. 2
2. 5
3. 3
4. 2
5. 2
6. 4
7. 5
8. 4
9. 3
10. 5
11. 5

1-10	91	82	73	64	55	45	36	27	18	9
11	0									