Divisioni con la linea numerata Nome:

Usa la linea numerata per risolvere ogni problema.

1) 50:10=

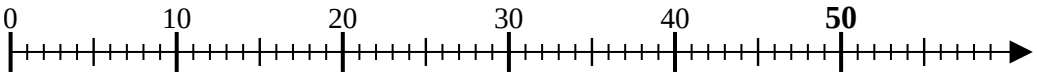

2) 16:4=

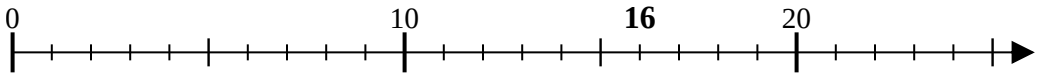

3) 14:7=

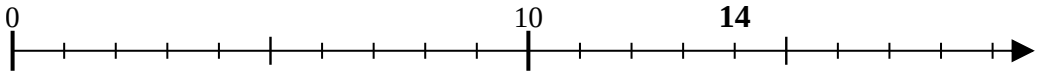

4) 28:7=

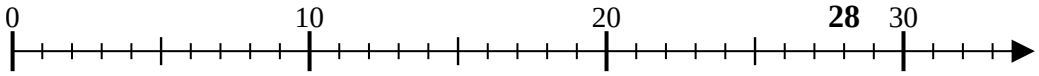

5) 20:4=

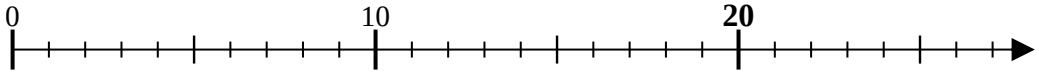

6) 45:9=

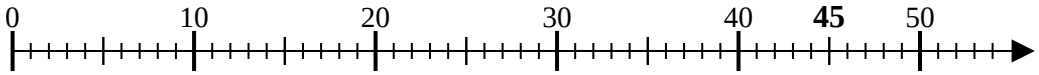

7) 20:10=

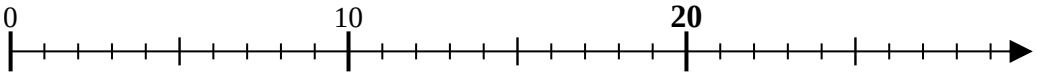

8) 16:8=

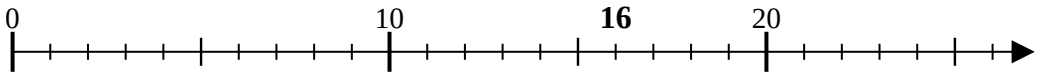

9) 12:4=

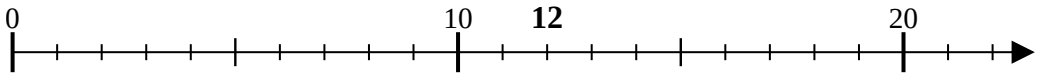

10) 4:2=

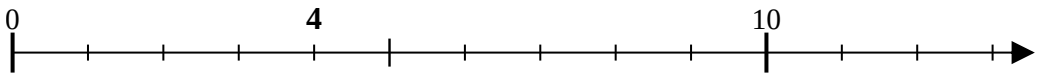

11) 36:9=

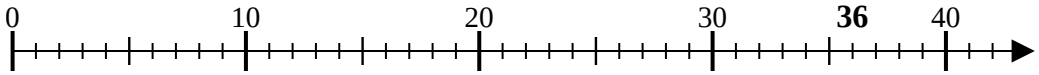

Risposte

1. _____
2. _____
3. _____
4. _____
5. _____
6. _____
7. _____
8. _____
9. _____
10. _____
11. _____

1-10	91	82	73	64	55	45	36	27	18	9
11	0									

Usa la linea numerata per risolvere ogni problema.

1) 50:10=

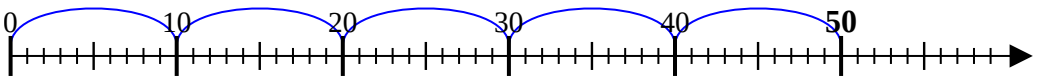

2) 16:4=

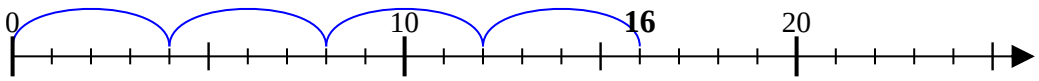

3) 14:7=

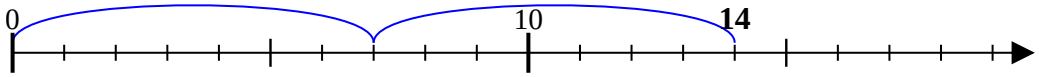

4) 28:7=

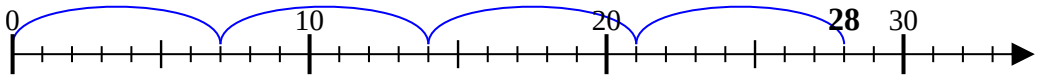

5) 20:4=

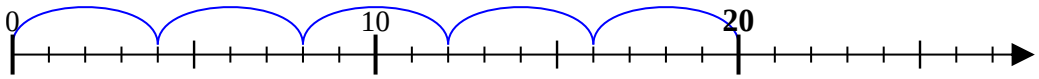

6) 45:9=

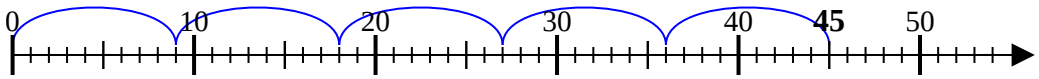

7) 20:10=

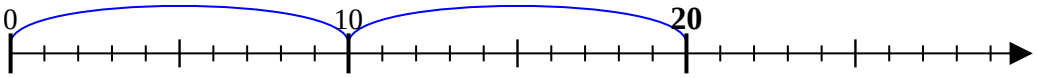

8) 16:8=

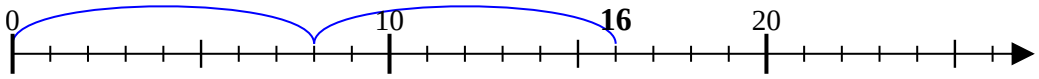

9) 12:4=

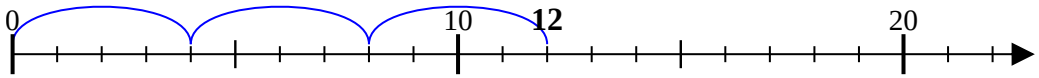

10) 4:2=

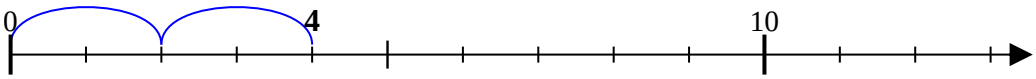

11) 36:9=

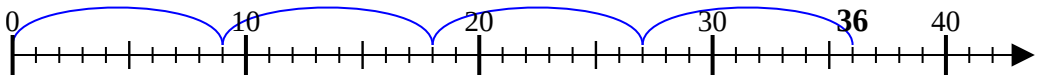

Risposte

1. 5
2. 4
3. 2
4. 4
5. 5
6. 5
7. 2
8. 2
9. 3
10. 2
11. 4

1-10	91	82	73	64	55	45	36	27	18	9
11	0									