Divisioni con la linea numerata Nome:

Usa la linea numerata per risolvere ogni problema.

1) 40:8=

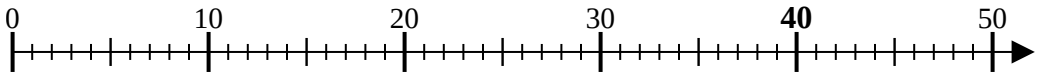

2) 20:4=

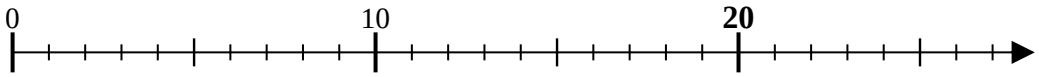

3) 6:2=

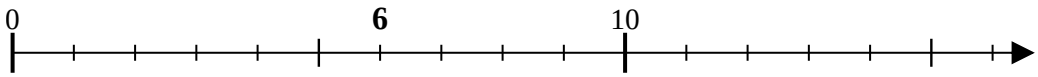

4) 27:9=

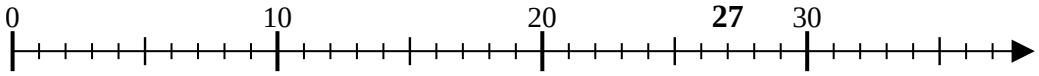

5) 20:5=

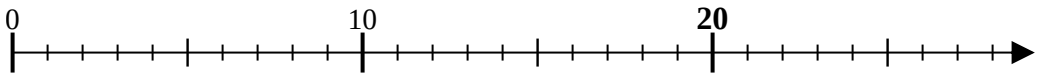

6) 9:3=

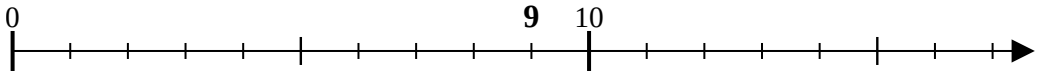

7) 10:5=

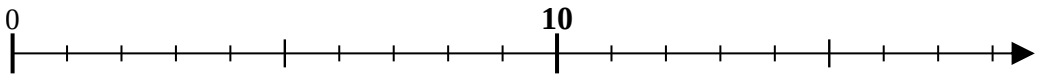

8) 6:3=

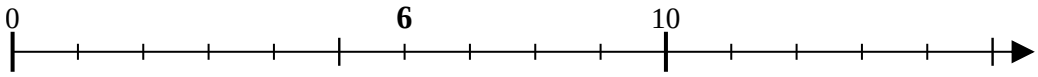

9) 30:6=

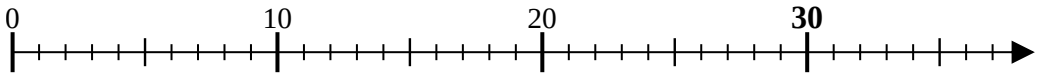

10) 12:3=

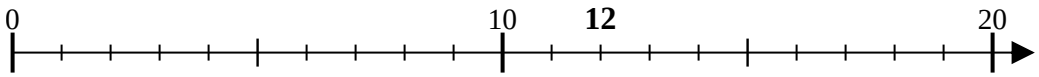

11) 40:10=

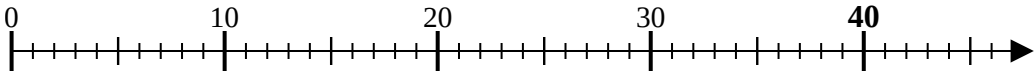

Risposte

1. _____
2. _____
3. _____
4. _____
5. _____
6. _____
7. _____
8. _____
9. _____
10. _____
11. _____

1-10	91	82	73	64	55	45	36	27	18	9
11	0									

Divisioni con la linea numerata Nome: **Soluzioni**

Usa la linea numerata per risolvere ogni problema.

1) 40:8=

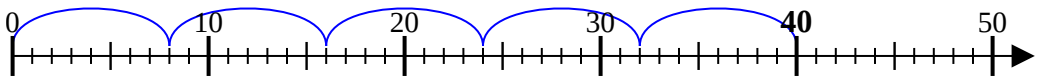

2) 20:4=

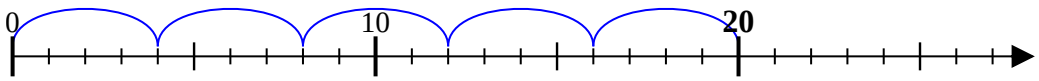

3) 6:2=

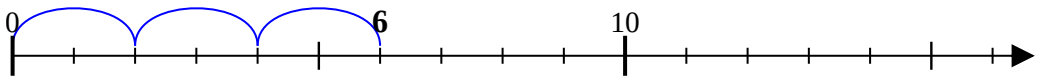

4) 27:9=

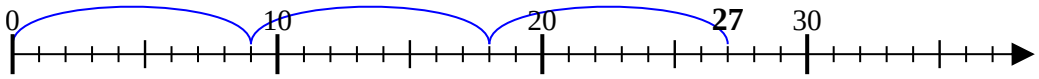

5) 20:5=

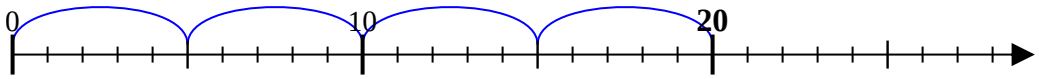

6) 9:3=

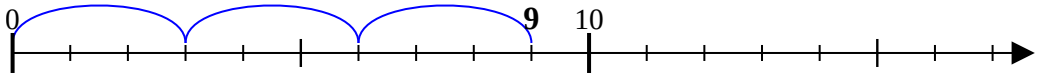

7) 10:5=

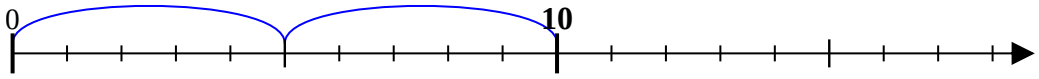

8) 6:3=

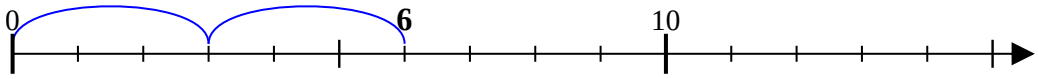

9) 30:6=

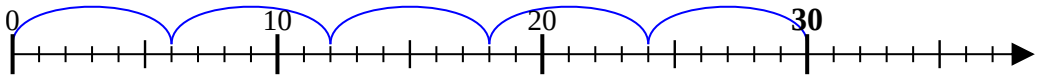

10) 12:3=

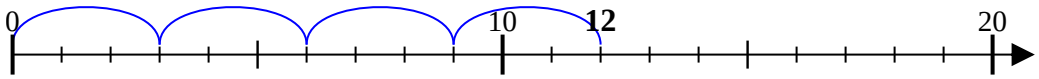

11) 40:10=

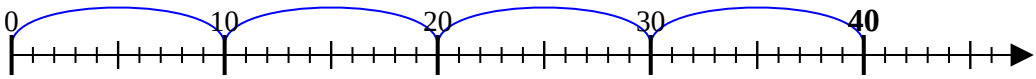

Risposte

1. 5
2. 5
3. 3
4. 3
5. 4
6. 3
7. 2
8. 2
9. 5
10. 4
11. 4