Frazioni, decimali e percentuali (visivamente) Nome:

Determina il valore sotto forma di frazione, decimale e percentuale.

Es)

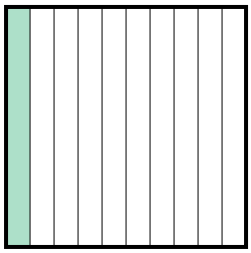

Frazione $^{1}/_{10}$
Decimale 0,1
Percentuale 10

1)

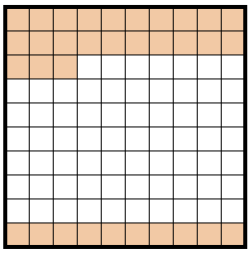

Frazione _____
Decimale _____
Percentuale _____

2)

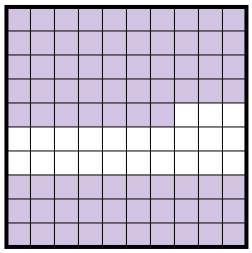

Frazione _____
Decimale _____
Percentuale _____

3)

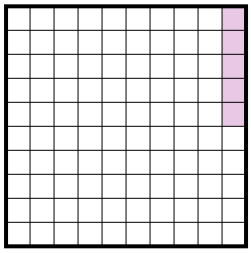

Frazione _____
Decimale _____
Percentuale _____

4)

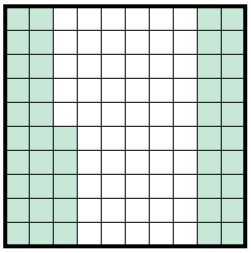

Frazione _____
Decimale _____
Percentuale _____

5)

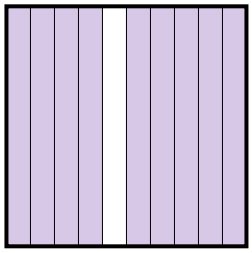

Frazione _____
Decimale _____
Percentuale _____

6)



Frazione _____
Decimale _____
Percentuale _____

7)



Frazione _____
Decimale _____
Percentuale _____

8)



Frazione _____
Decimale _____
Percentuale _____

9)

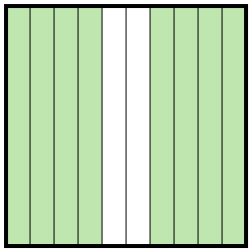

Frazione _____
Decimale _____
Percentuale _____

10)

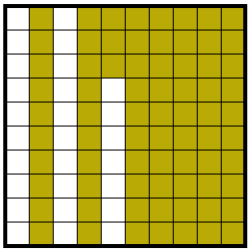

Frazione _____
Decimale _____
Percentuale _____

11)

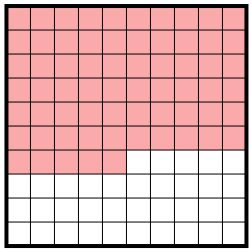

Frazione _____
Decimale _____
Percentuale _____

Risposte

Es.	$^{1}/_{10}$	0,1	10%
1.			
2.			
3.			
4.			
5.			
6.			
7.			
8.			
9.			
10.			
11.			

1-10	91	82	73	64	55	45	36	27	18	9
11	0									

Frazioni, decimali e percentuali (visivamente) Nome: **Soluzioni**

Determina il valore sotto forma di frazione, decimale e percentuale.

Es)

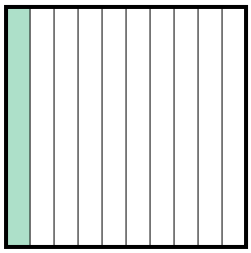

Frazione $1/10$
Decimale 0,1
Percentuale 10

1)

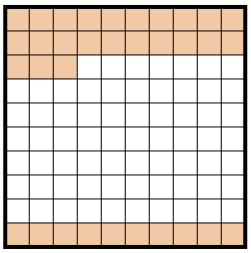

Frazione $33/100$
Decimale 0,33
Percentuale 33

2)

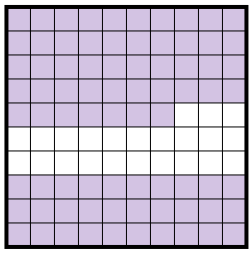

Frazione $77/100$
Decimale 0,77
Percentuale 77

3)

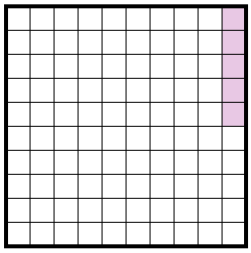

Frazione $5/100$
Decimale 0,05
Percentuale 5

4)

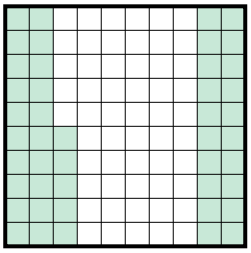

Frazione $45/100$
Decimale 0,45
Percentuale 45

5)

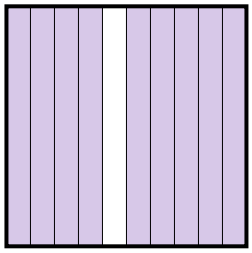

Frazione $9/10$
Decimale 0,9
Percentuale 90

6)



Frazione $7/10$
Decimale 0,7
Percentuale 70

7)



Frazione $3/10$
Decimale 0,3
Percentuale 30

8)



Frazione $2/10$
Decimale 0,2
Percentuale 20

9)

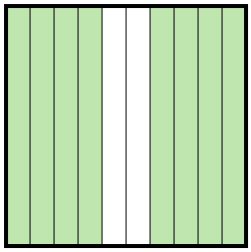

Frazione $8/10$
Decimale 0,8
Percentuale 80

10)

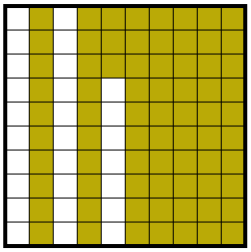

Frazione $73/100$
Decimale 0,73
Percentuale 73

11)

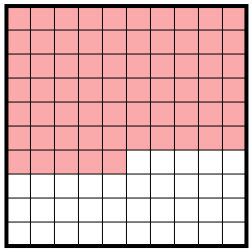

Frazione $65/100$
Decimale 0,65
Percentuale 65

Risposte

Es.	$1/10$	0,1	10%
1.	$33/100$	0,33	33%
2.	$77/100$	0,77	77%
3.	$5/100$	0,05	5%
4.	$45/100$	0,45	45%
5.	$9/10$	0,9	90%
6.	$7/10$	0,7	70%
7.	$3/10$	0,3	30%
8.	$2/10$	0,2	20%
9.	$8/10$	0,8	80%
10.	$73/100$	0,73	73%
11.	$65/100$	0,65	65%

1-10	91	82	73	64	55	45	36	27	18	9
11	0									