Frazioni di quantità relative al tutto

Nome:

Risolvi ogni problema.

Es) Indica triangoli come una frazione dell'intero.

1) Indica cerchi come una frazione dell'intero.

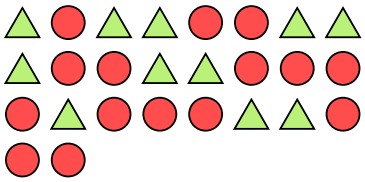

2) Indica pentagoni come una frazione dell'intero.

3) Indica quadrati come una frazione dell'intero.

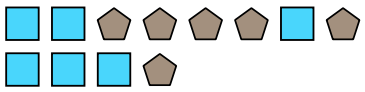

4) Indica moons come una frazione dell'intero.



5) Indica cerchi come una frazione dell'intero.

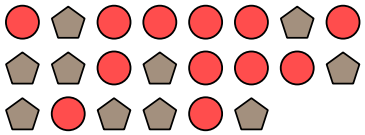

6) Indica triangoli come una frazione dell'intero.

7) Indica hearts come una frazione dell'intero.



8) Indica hearts come una frazione dell'intero.



9) Indica hearts come una frazione dell'intero.



10) Indica quadrati come una frazione dell'intero.



11) Indica triangoli come una frazione dell'intero.

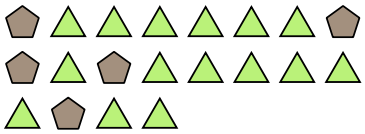

Risposte

Es. $\frac{3}{12}$

1. _____
2. _____
3. _____
4. _____
5. _____
6. _____
7. _____
8. _____
9. _____
10. _____
11. _____

1-10	91	82	73	64	55	45	36	27	18	9
11	0									

Frazioni di quantità relative al tutto

Nome: **Soluzioni**

Risolvi ogni problema.

Es) Indica triangoli come una frazione dell'intero.

1) Indica cerchi come una frazione dell'intero.

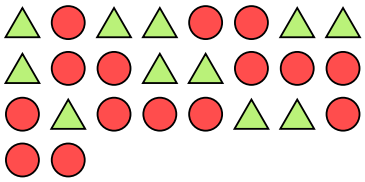

2) Indica pentagoni come una frazione dell'intero.

3) Indica quadrati come una frazione dell'intero.

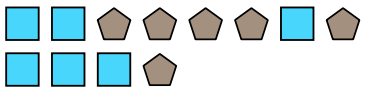

4) Indica moons come una frazione dell'intero.



5) Indica cerchi come una frazione dell'intero.

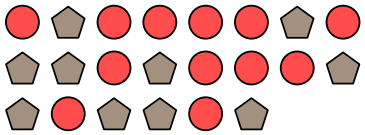

6) Indica triangoli come una frazione dell'intero.

7) Indica hearts come una frazione dell'intero.



8) Indica hearts come una frazione dell'intero.



9) Indica hearts come una frazione dell'intero.



10) Indica quadrati come una frazione dell'intero.



11) Indica triangoli come una frazione dell'intero.

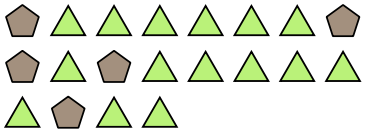

Risposte

Es.	3/12
1.	15/26
2.	4/15
3.	6/12
4.	8/22
5.	12/22
6.	6/10
7.	8/19
8.	15/23
9.	5/14
10.	6/19
11.	15/20

1-10	91	82	73	64	55	45	36	27	18	9
11	0									