Frazioni improprie e miste rappresentate Nome:

**Scrivi ogni quantità come un numero misto.**

**1)**

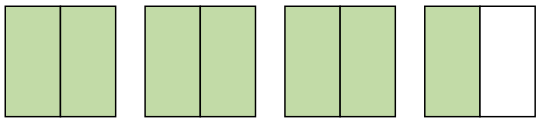

**2)**

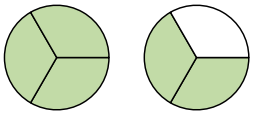

**3)**

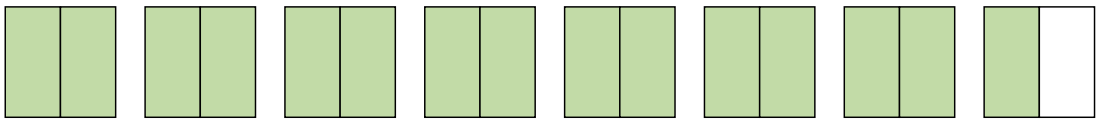

**4)**

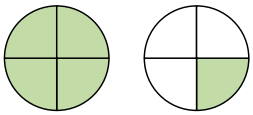

**5)**

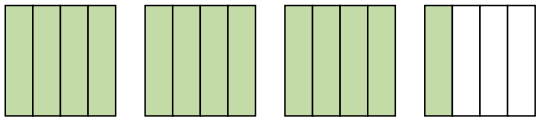

**Scrivi ogni quantità come una frazione impropria.**

**6)**

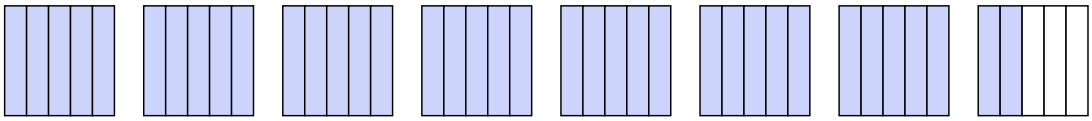

**7)**

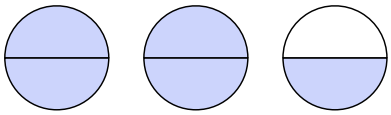

**8)**

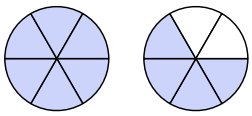

**9)**

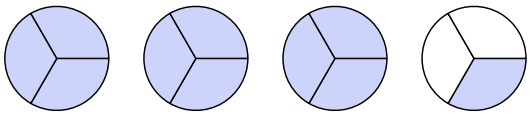

**10)**

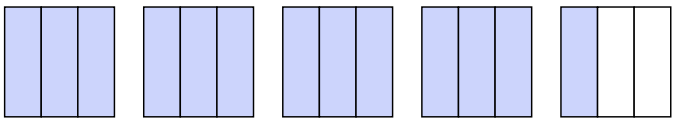

**11)**

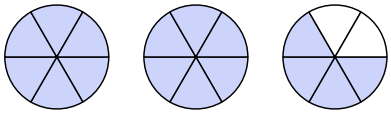

**Risposte**

1. _____
2. _____
3. _____
4. _____
5. _____
6. _____
7. _____
8. _____
9. _____
10. _____
11. _____



| | | | | | | | | | | |
|---|---|---|---|---|---|---|---|---|---|---|
| 1-10 | 91 | 82 | 73 | 64 | 55 | 45 | 36 | 27 | 18 | 9 |
| 11 | 0 | | | | | | | | | |

Frazioni improprie e miste rappresentate Nome: **Soluzioni**

**Scrivi ogni quantità come un numero misto.**

1) 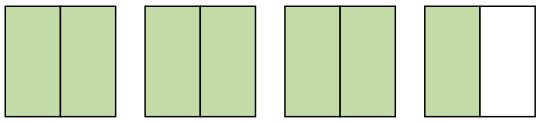

2) 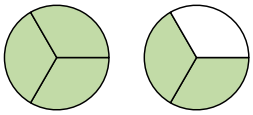

3) 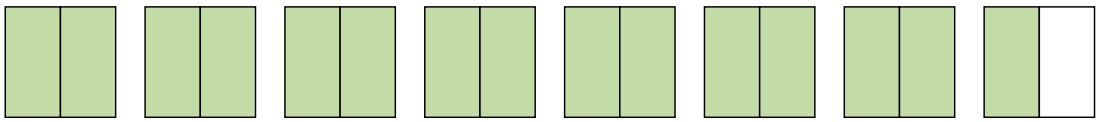

4) 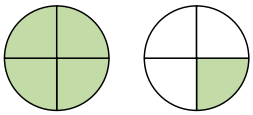

5) 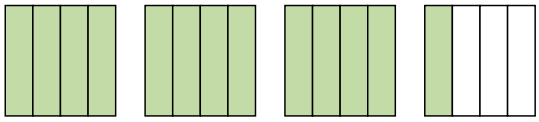

**Scrivi ogni quantità come una frazione impropria.**

6) 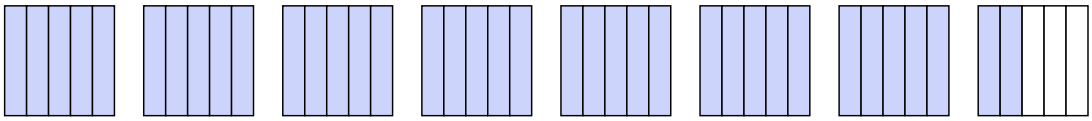

7) 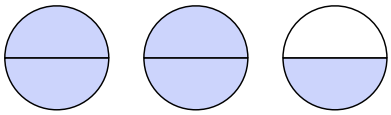

8) 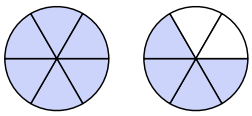

9) 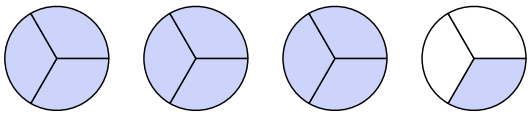

10) 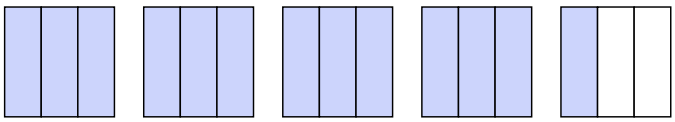

11) 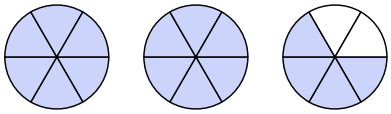

**Risposte**

1. $3\frac{1}{2}$
2. $1\frac{2}{3}$
3. $7\frac{1}{2}$
4. $1\frac{1}{4}$
5. $3\frac{1}{4}$
6. $\frac{37}{5}$
7. $\frac{5}{2}$
8. $\frac{10}{6}$
9. $\frac{10}{3}$
10. $\frac{13}{3}$
11. $\frac{16}{6}$



| | | | | | | | | | | |
|---|---|---|---|---|---|---|---|---|---|---|
| 1-10 | 91 | 82 | 73 | 64 | 55 | 45 | 36 | 27 | 18 | 9 |
| 11 | 0 | | | | | | | | | |