Frazioni improprie e miste rappresentate Nome:

Scrivi ogni quantità come un numero misto.

1)

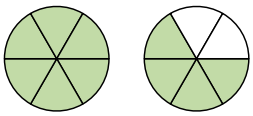

2)

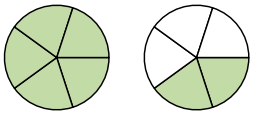

3)

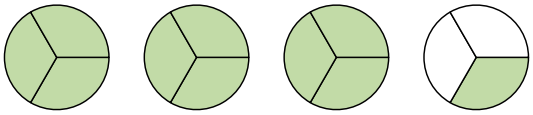

4)

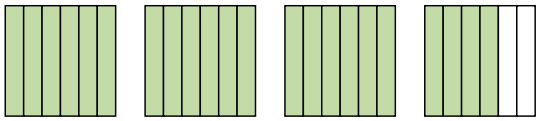

5)

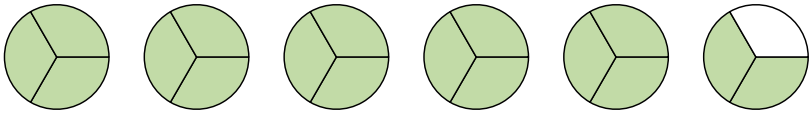

Scrivi ogni quantità come una frazione impropria.

6)



7)

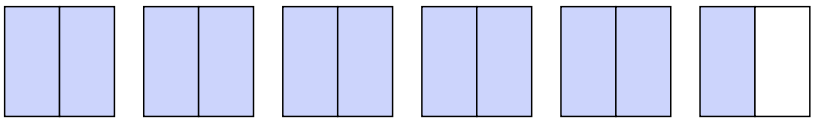

8)

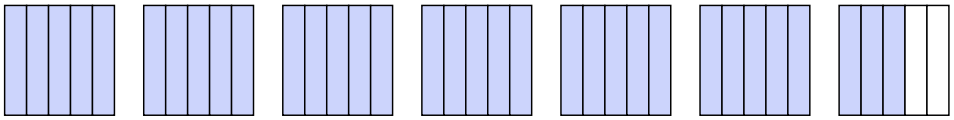

9)

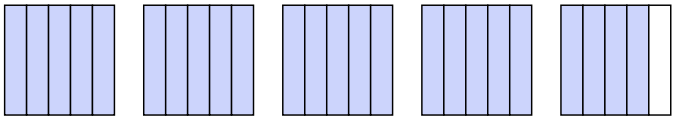

10)

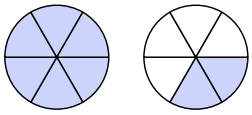

11)

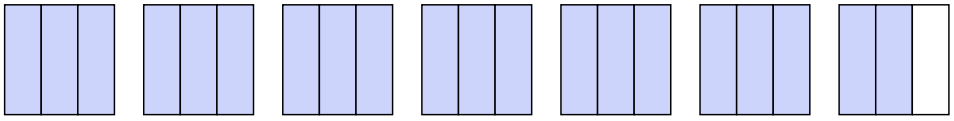

Risposte

1. _____
2. _____
3. _____
4. _____
5. _____
6. _____
7. _____
8. _____
9. _____
10. _____
11. _____

1-10	91	82	73	64	55	45	36	27	18	9
11	0									

Scrivi ogni quantità come un numero misto.

1) 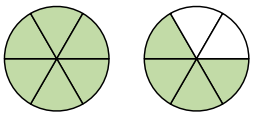

2) 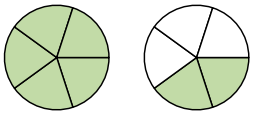

3) 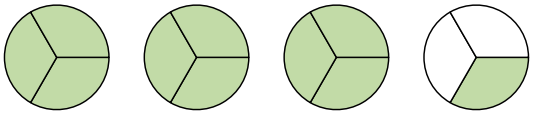

4) 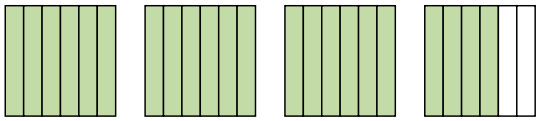

5) 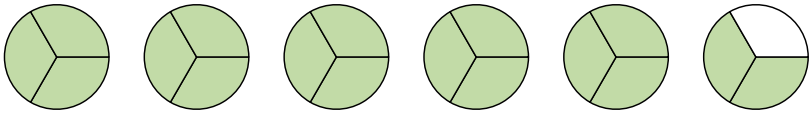

Scrivi ogni quantità come una frazione impropria.

6) 

7) 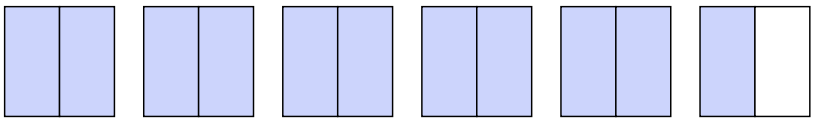

8) 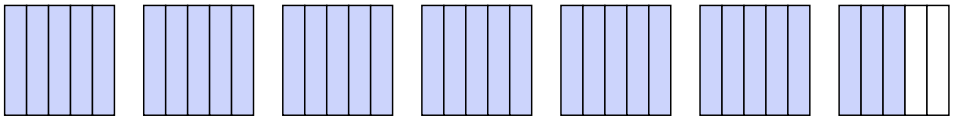

9) 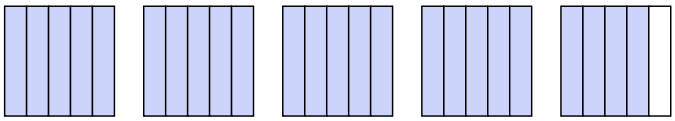

10) 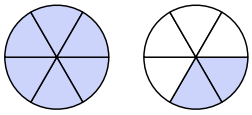

11) 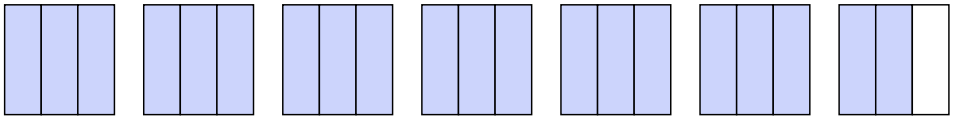

Risposte

1. $1\frac{4}{6}$
2. $1\frac{2}{5}$
3. $3\frac{1}{3}$
4. $3\frac{4}{6}$
5. $5\frac{2}{3}$
6. $\frac{5}{2}$
7. $\frac{11}{2}$
8. $\frac{33}{5}$
9. $\frac{24}{5}$
10. $\frac{8}{6}$
11. $\frac{20}{3}$

1-10	91	82	73	64	55	45	36	27	18	9
11	0									