Moltiplicazioni con le frazioni (graficamente)

Nome:

Usa i quadrati per rappresentare la moltiplicazione indicata.

Es) $\frac{3}{6} \times \frac{1}{9} =$

1) $\frac{2}{3} \times \frac{2}{6} =$

2) $\frac{2}{3} \times \frac{2}{3} =$

3) $\frac{6}{7} \times \frac{1}{3} =$

4) $\frac{1}{7} \times \frac{1}{2} =$

5) $\frac{3}{8} \times \frac{5}{9} =$

6) $\frac{3}{4} \times \frac{1}{7} =$

7) $\frac{2}{8} \times \frac{2}{5} =$

8) $\frac{3}{7} \times \frac{3}{8} =$

9) $\frac{4}{5} \times \frac{1}{4} =$

10) $\frac{2}{4} \times \frac{6}{8} =$

11) $\frac{2}{7} \times \frac{1}{4} =$

Risposte

Es. $3/54$

1. _____
2. _____
3. _____
4. _____
5. _____
6. _____
7. _____
8. _____
9. _____
10. _____
11. _____

1-10	91	82	73	64	55	45	36	27	18	9
11	0									

Moltiplicazioni con le frazioni (graficamente) Nome: **Soluzioni**

Usa i quadrati per rappresentare la moltiplicazione indicata.

Es) $\frac{3}{6} \times \frac{1}{9} =$

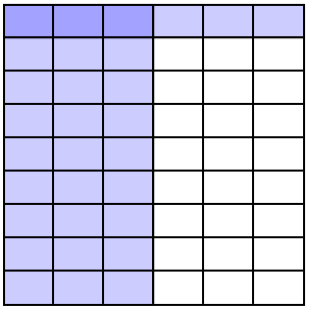

1) $\frac{2}{3} \times \frac{2}{6} =$

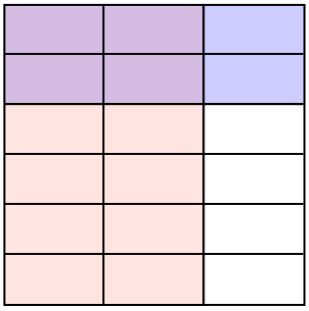

2) $\frac{2}{3} \times \frac{2}{3} =$



3) $\frac{6}{7} \times \frac{1}{3} =$

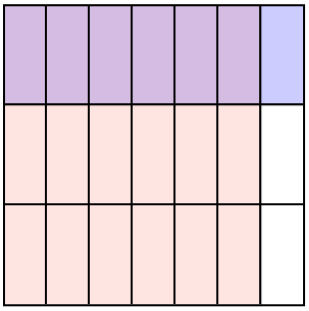

4) $\frac{1}{7} \times \frac{1}{2} =$

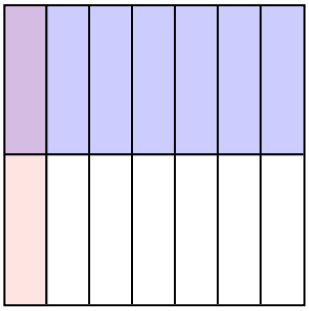

5) $\frac{3}{8} \times \frac{5}{9} =$

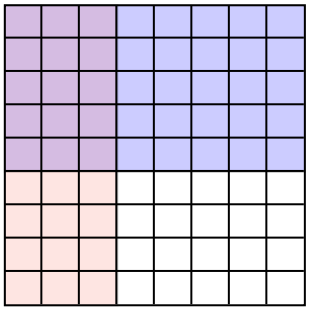

6) $\frac{3}{4} \times \frac{1}{7} =$

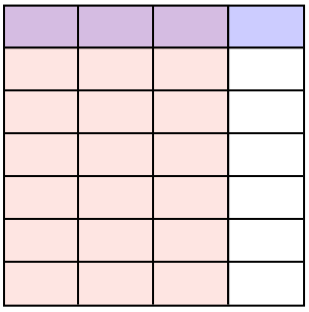

7) $\frac{2}{8} \times \frac{2}{5} =$

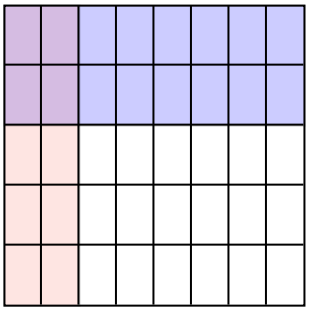

8) $\frac{3}{7} \times \frac{3}{8} =$

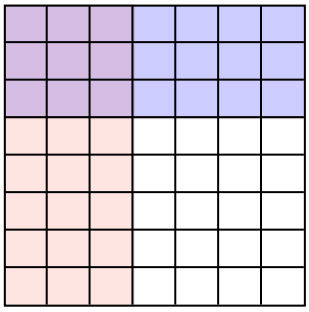

9) $\frac{4}{5} \times \frac{1}{4} =$



10) $\frac{2}{4} \times \frac{6}{8} =$



11) $\frac{2}{7} \times \frac{1}{4} =$

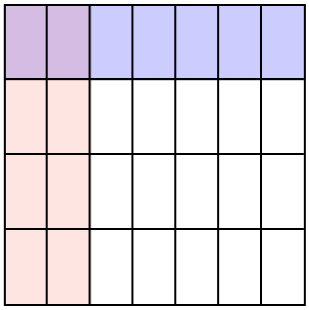

Risposte

Es. $\frac{3}{54}$

1. $\frac{4}{18}$
2. $\frac{4}{9}$
3. $\frac{6}{21}$
4. $\frac{1}{14}$
5. $\frac{15}{72}$
6. $\frac{3}{28}$
7. $\frac{4}{40}$
8. $\frac{9}{56}$
9. $\frac{4}{20}$
10. $\frac{12}{32}$
11. $\frac{2}{28}$

1-10	91	82	73	64	55	45	36	27	18	9
11	0									