# Moltiplicazioni con le frazioni (graficamente)

Nome:

**Usa i quadrati per rappresentare la moltiplicazione indicata.**

**Es)** $\frac{1}{3} \times \frac{2}{4} =$

**1)** $\frac{1}{6} \times \frac{3}{6} =$

**2)** $\frac{4}{7} \times \frac{4}{5} =$

**3)** $\frac{1}{4} \times \frac{1}{3} =$

**4)** $\frac{2}{8} \times \frac{5}{8} =$

**5)** $\frac{3}{4} \times \frac{7}{9} =$

**6)** $\frac{5}{6} \times \frac{1}{2} =$

**7)** $\frac{4}{5} \times \frac{3}{7} =$

**8)** $\frac{8}{9} \times \frac{1}{2} =$

**9)** $\frac{7}{8} \times \frac{4}{8} =$

**10)** $\frac{2}{6} \times \frac{4}{7} =$

**11)** $\frac{1}{2} \times \frac{1}{2} =$

## Risposte

Es. $^{2}/_{12}$

1. _____
2. _____
3. _____
4. _____
5. _____
6. _____
7. _____
8. _____
9. _____
10. _____
11. _____



| | | | | | | | | | | |
|---|---|---|---|---|---|---|---|---|---|---|
| 1-10 | 91 | 82 | 73 | 64 | 55 | 45 | 36 | 27 | 18 | 9 |
| 11 | 0 | | | | | | | | | |

Moltiplicazioni con le frazioni (graficamente) Nome: **Soluzioni**

**Usa i quadrati per rappresentare la moltiplicazione indicata.**

**Es)** $\frac{1}{3} \times \frac{2}{4} =$



**1)** $\frac{1}{6} \times \frac{3}{6} =$

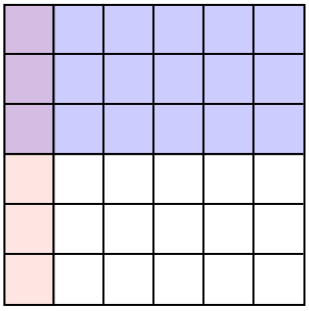

**2)** $\frac{4}{7} \times \frac{4}{5} =$

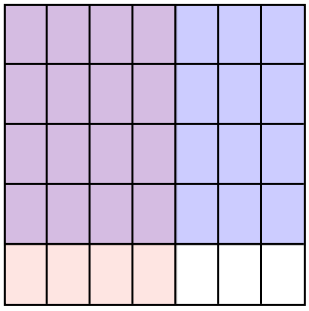

**3)** $\frac{1}{4} \times \frac{1}{3} =$



**4)** $\frac{2}{8} \times \frac{5}{8} =$

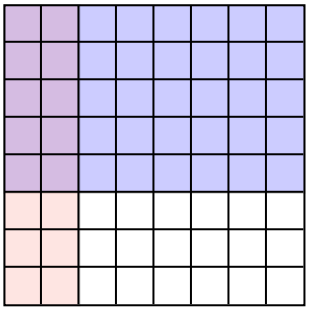

**5)** $\frac{3}{4} \times \frac{7}{9} =$

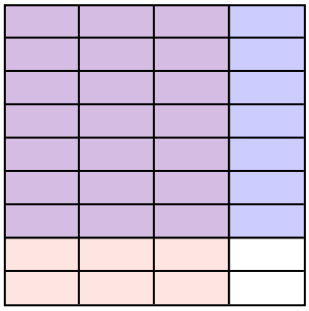

**6)** $\frac{5}{6} \times \frac{1}{2} =$

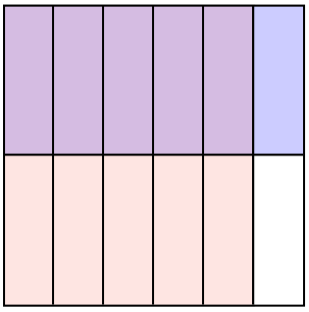

**7)** $\frac{4}{5} \times \frac{3}{7} =$

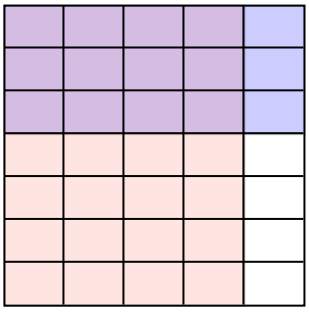

**8)** $\frac{8}{9} \times \frac{1}{2} =$

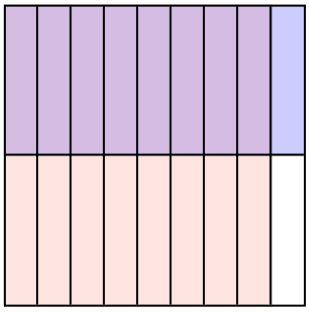

**9)** $\frac{7}{8} \times \frac{4}{8} =$

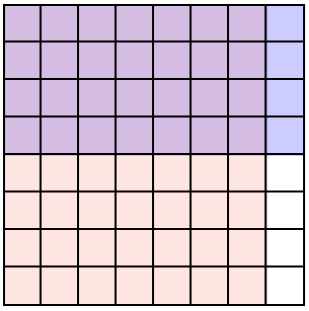

**10)** $\frac{2}{6} \times \frac{4}{7} =$

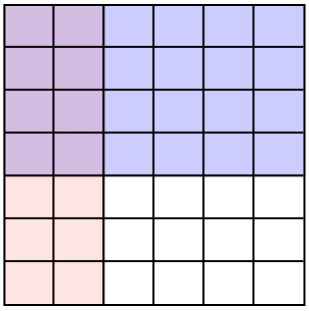

**11)** $\frac{1}{2} \times \frac{1}{2} =$



## Risposte

Es. $\frac{2}{12}$

1. $\frac{3}{36}$

2. $\frac{16}{35}$

3. $\frac{1}{12}$

4. $\frac{10}{64}$

5. $\frac{21}{36}$

6. $\frac{5}{12}$

7. $\frac{12}{35}$

8. $\frac{8}{18}$

9. $\frac{28}{64}$

10. $\frac{8}{42}$

11. $\frac{1}{4}$



| | | | | | | | | | | |
|---|---|---|---|---|---|---|---|---|---|---|
| 1-10 | 91 | 82 | 73 | 64 | 55 | 45 | 36 | 27 | 18 | 9 |
| 11 | 0 | | | | | | | | | |