Moltiplicazioni con le frazioni (graficamente) Nome:

Usa i quadrati per rappresentare la moltiplicazione indicata.

Es) $\frac{8}{9} \times \frac{5}{8} =$

1) $\frac{1}{3} \times \frac{3}{4} =$

2) $\frac{3}{4} \times \frac{2}{9} =$

3) $\frac{1}{2} \times \frac{1}{2} =$

4) $\frac{1}{4} \times \frac{1}{2} =$

5) $\frac{1}{9} \times \frac{2}{4} =$

6) $\frac{5}{6} \times \frac{1}{6} =$

7) $\frac{6}{9} \times \frac{2}{3} =$

8) $\frac{5}{6} \times \frac{7}{9} =$

9) $\frac{2}{4} \times \frac{2}{6} =$

10) $\frac{1}{2} \times \frac{1}{6} =$

11) $\frac{5}{7} \times \frac{4}{6} =$

Risposte

Es. 40/72

1. _____
2. _____
3. _____
4. _____
5. _____
6. _____
7. _____
8. _____
9. _____
10. _____
11. _____

1-10	91	82	73	64	55	45	36	27	18	9
11	0									

Moltiplicazioni con le frazioni (graficamente) Nome: **Soluzioni**

Usa i quadrati per rappresentare la moltiplicazione indicata.

Es) $\frac{8}{9} \times \frac{5}{8} =$

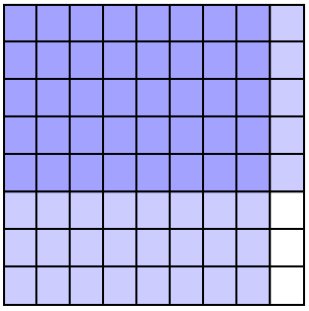

1) $\frac{1}{3} \times \frac{3}{4} =$



2) $\frac{3}{4} \times \frac{2}{9} =$

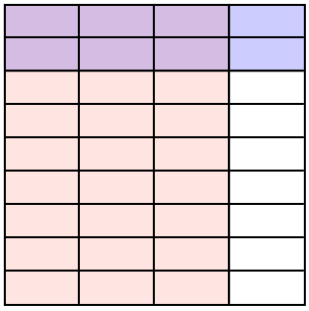

3) $\frac{1}{2} \times \frac{1}{2} =$



4) $\frac{1}{4} \times \frac{1}{2} =$



5) $\frac{1}{9} \times \frac{2}{4} =$

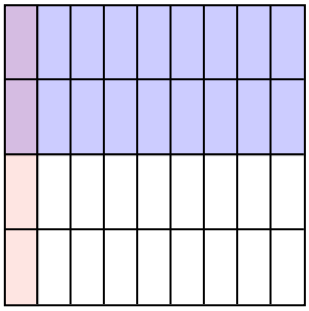

6) $\frac{5}{6} \times \frac{1}{6} =$

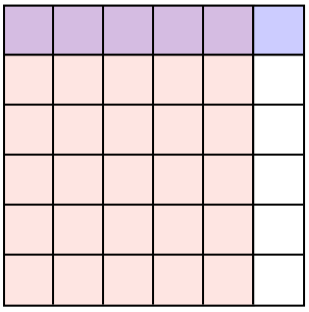

7) $\frac{6}{9} \times \frac{2}{3} =$

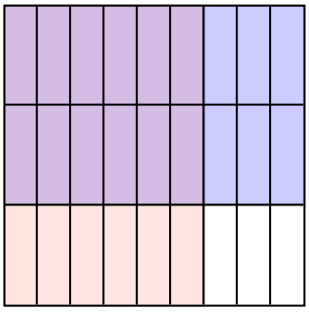

8) $\frac{5}{6} \times \frac{7}{9} =$

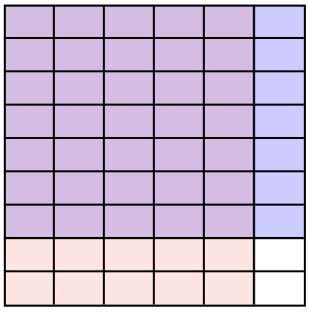

9) $\frac{2}{4} \times \frac{2}{6} =$



10) $\frac{1}{2} \times \frac{1}{6} =$



11) $\frac{5}{7} \times \frac{4}{6} =$

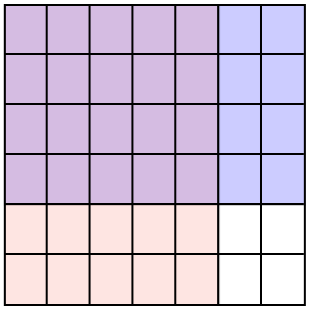

Risposte

Es. $\frac{40}{72}$

1. $\frac{3}{12}$
2. $\frac{6}{36}$
3. $\frac{1}{4}$
4. $\frac{1}{8}$
5. $\frac{2}{36}$
6. $\frac{5}{36}$
7. $\frac{12}{27}$
8. $\frac{35}{54}$
9. $\frac{4}{24}$
10. $\frac{1}{12}$
11. $\frac{20}{42}$

1-10	91	82	73	64	55	45	36	27	18	9
11	0									