Moltiplicazioni con le frazioni (graficamente) Nome:

Usa i quadrati per rappresentare la moltiplicazione indicata.

Es) $\frac{2}{4} \times \frac{1}{3} =$

1) $\frac{1}{2} \times \frac{3}{7} =$

2) $\frac{5}{9} \times \frac{3}{6} =$

3) $\frac{1}{3} \times \frac{1}{4} =$

4) $\frac{4}{7} \times \frac{2}{8} =$

5) $\frac{1}{2} \times \frac{2}{4} =$

6) $\frac{7}{8} \times \frac{4}{7} =$

7) $\frac{2}{9} \times \frac{1}{4} =$

8) $\frac{3}{4} \times \frac{5}{8} =$

9) $\frac{2}{7} \times \frac{1}{2} =$

10) $\frac{1}{5} \times \frac{2}{5} =$

11) $\frac{2}{9} \times \frac{2}{5} =$

Risposte

Es. $^{2}/_{12}$

1. _____
2. _____
3. _____
4. _____
5. _____
6. _____
7. _____
8. _____
9. _____
10. _____
11. _____

1-10	91	82	73	64	55	45	36	27	18	9
11	0									

Moltiplicazioni con le frazioni (graficamente) Nome: **Soluzioni**

Usa i quadrati per rappresentare la moltiplicazione indicata.

Es) $\frac{2}{4} \times \frac{1}{3} =$



1) $\frac{1}{2} \times \frac{3}{7} =$

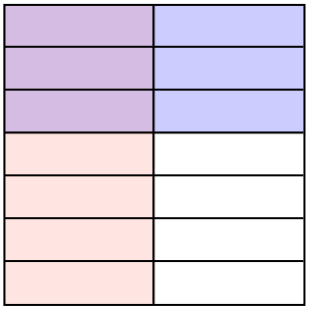

2) $\frac{5}{9} \times \frac{3}{6} =$

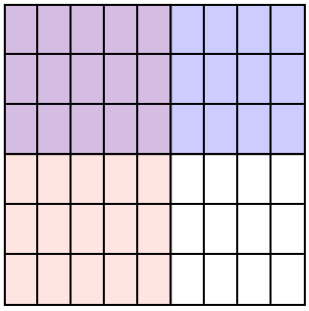

3) $\frac{1}{3} \times \frac{1}{4} =$



4) $\frac{4}{7} \times \frac{2}{8} =$

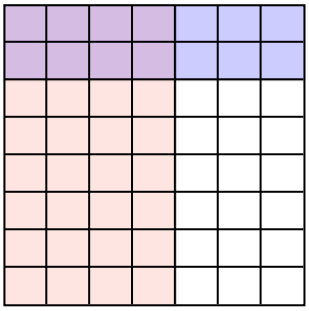

5) $\frac{1}{2} \times \frac{2}{4} =$



6) $\frac{7}{8} \times \frac{4}{7} =$

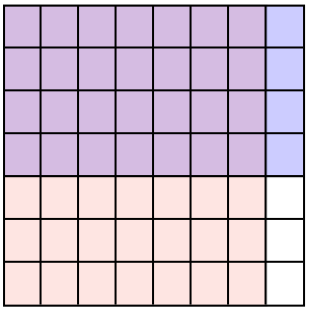

7) $\frac{2}{9} \times \frac{1}{4} =$

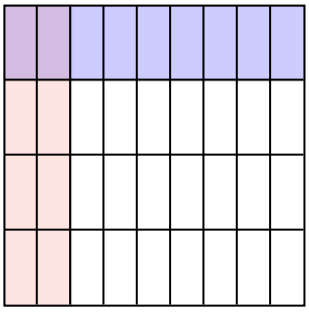

8) $\frac{3}{4} \times \frac{5}{8} =$

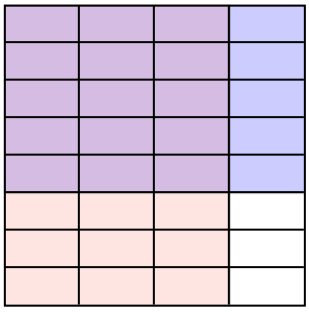

9) $\frac{2}{7} \times \frac{1}{2} =$

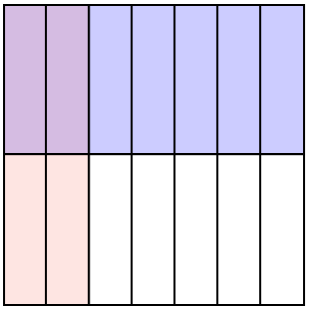

10) $\frac{1}{5} \times \frac{2}{5} =$

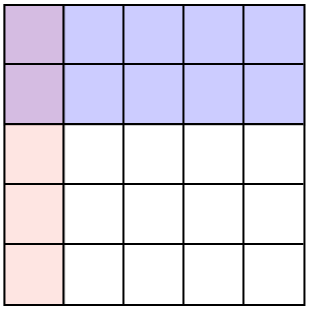

11) $\frac{2}{9} \times \frac{2}{5} =$

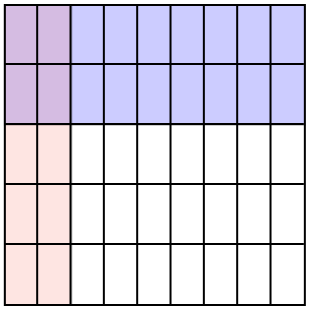

Risposte

Es. $\frac{2}{12}$

1. $\frac{3}{14}$

2. $\frac{15}{54}$

3. $\frac{1}{12}$

4. $\frac{8}{56}$

5. $\frac{2}{8}$

6. $\frac{28}{56}$

7. $\frac{2}{36}$

8. $\frac{15}{32}$

9. $\frac{2}{14}$

10. $\frac{2}{25}$

11. $\frac{4}{45}$

1-10	91	82	73	64	55	45	36	27	18	9
11	0									