Trova la distante sulla griglia

Nome:

Trova la distanza tra i punti. Arrotonda il risultato alla decina più vicina.

Es)

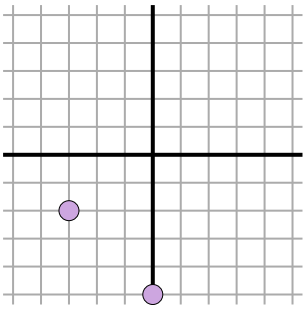

1)

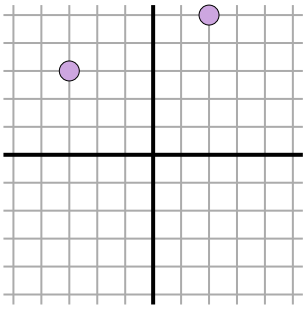

2)

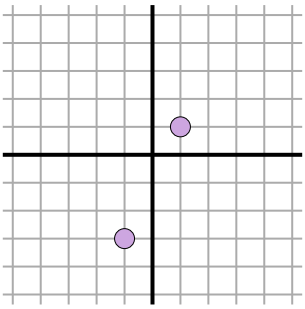

3)

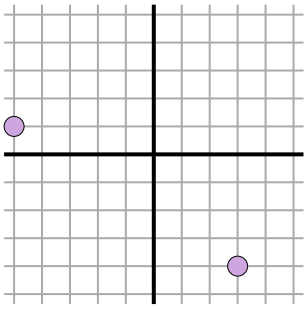

4)

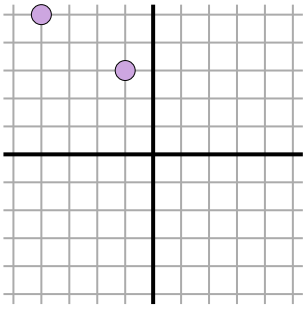

5)

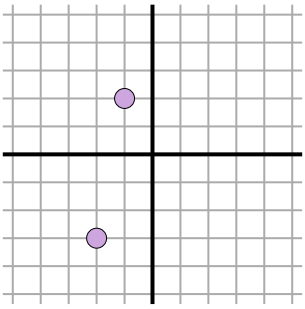

6)

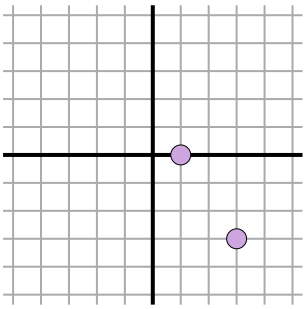

7)

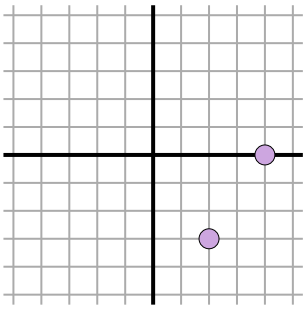

8)

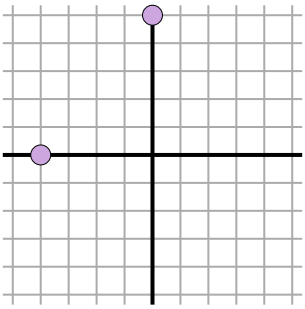

9)

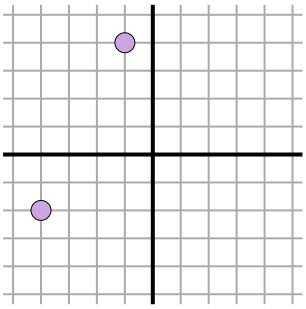

10)

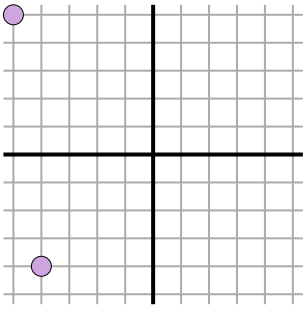

11)

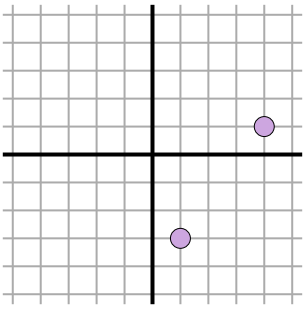

Risposte

Es. 4,2

1. _____

2. _____

3. _____

4. _____

5. _____

6. _____

7. _____

8. _____

9. _____

10. _____

11. _____

1-10	91	82	73	64	55	45	36	27	18	9
11	0									

Trova la distante sulla griglia

Nome: **Soluzioni**

Trova la distanza tra i punti. Arrotonda il risultato alla decina più vicina.

Es)

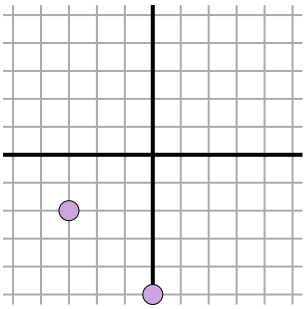

$\sqrt{(0--3)^2 + (-5--2)^2}$

$\sqrt{(9) + (9)}$

1)

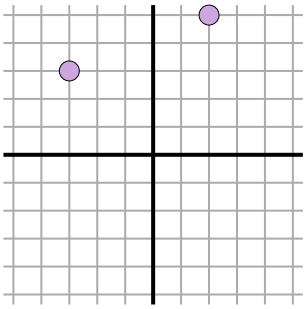

$\sqrt{(2--3)^2 + (5-3)^2}$

$\sqrt{(25) + (4)}$

2)

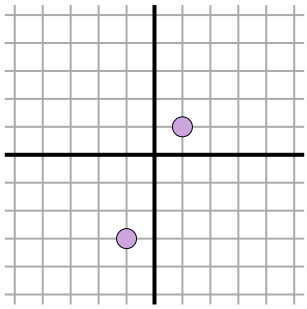

$\sqrt{(-1-1)^2 + (-3-1)^2}$

$\sqrt{(4) + (16)}$

3)

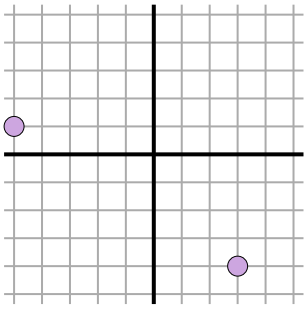

$\sqrt{(3--5)^2 + (-4-1)^2}$

$\sqrt{(64) + (25)}$

4)

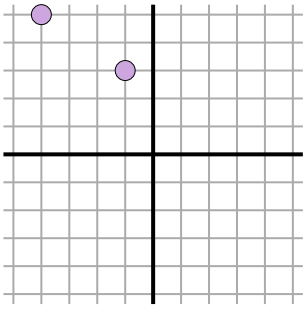

$\sqrt{(-4--1)^2 + (5-3)^2}$

$\sqrt{(9) + (4)}$

5)

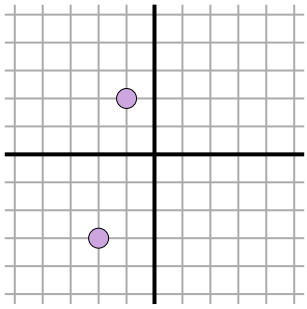

$\sqrt{(-2--1)^2 + (-3-2)^2}$

$\sqrt{(1) + (25)}$

6)

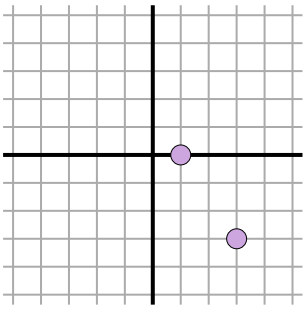

$\sqrt{(1-3)^2 + (0--3)^2}$

$\sqrt{(4) + (9)}$

7)

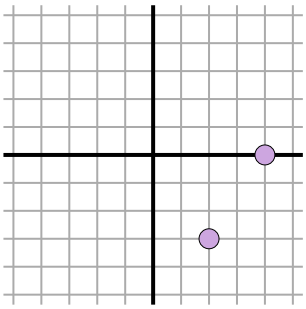

$\sqrt{(4-2)^2 + (0--3)^2}$

$\sqrt{(4) + (9)}$

8)

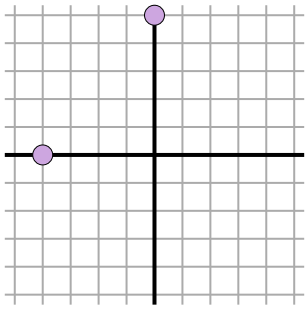

$\sqrt{(0--4)^2 + (5-0)^2}$

$\sqrt{(16) + (25)}$

9)

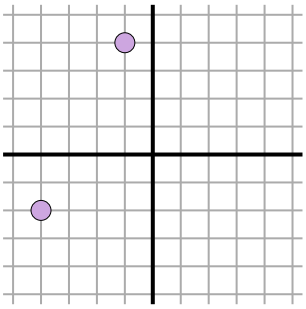

$\sqrt{(-1--4)^2 + (4--2)^2}$

$\sqrt{(9) + (36)}$

10)

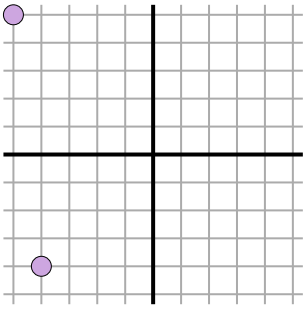

$\sqrt{(-5--4)^2 + (5--4)^2}$

$\sqrt{(1) + (81)}$

11)

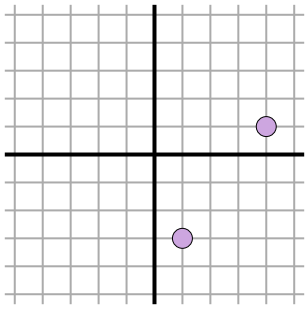

$\sqrt{(1-4)^2 + (-3-1)^2}$

$\sqrt{(9) + (16)}$

Risposte

Es.	4,2
1.	5,4
2.	4,5
3.	9,4
4.	3,6
5.	5,1
6.	3,6
7.	3,6
8.	6,4
9.	6,7
10.	9,1
11.	5

1-10	91	82	73	64	55	45	36	27	18	9
11	0									