Trova la distante sulla griglia

Nome:

Trova la distanza tra i punti. Arrotonda il risultato alla decina più vicina.

Es)

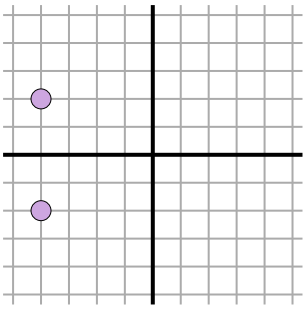

1)

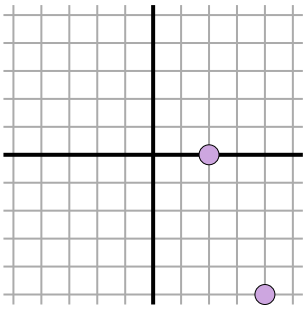

2)

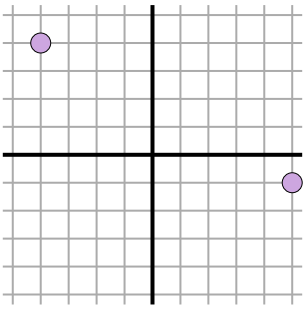

3)

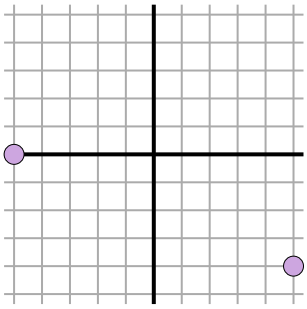

4)

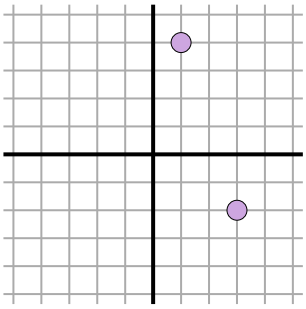

5)

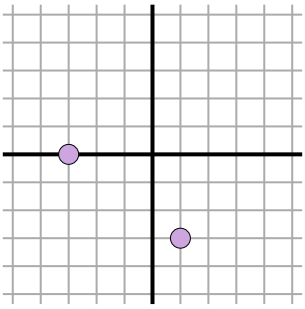

6)

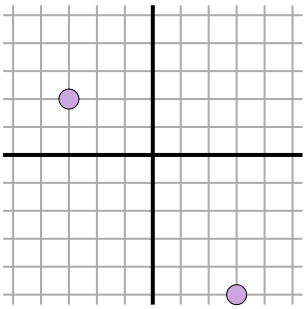

7)

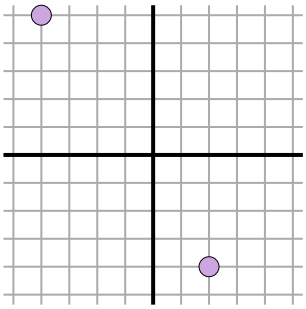

8)

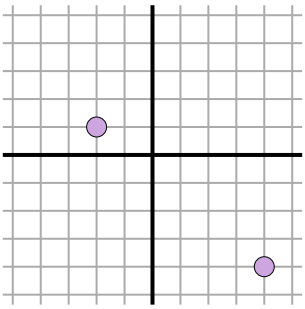

9)

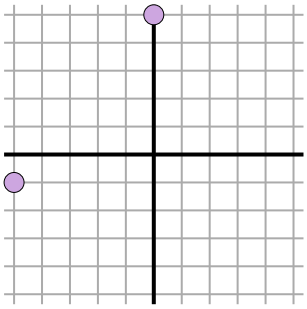

10)

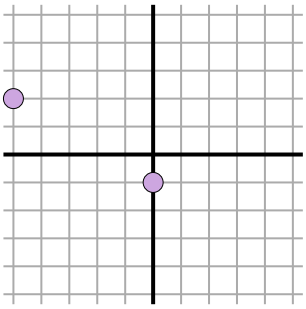

11)

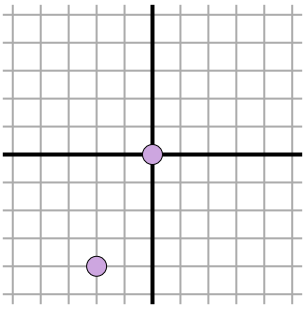

Risposte

Es. 4

1. _____
2. _____
3. _____
4. _____
5. _____
6. _____
7. _____
8. _____
9. _____
10. _____
11. _____

1-10	91	82	73	64	55	45	36	27	18	9
11	0									

Trova la distante sulla griglia

Nome: **Soluzioni**

Trova la distanza tra i punti. Arrotonda il risultato alla decina più vicina.

Es)

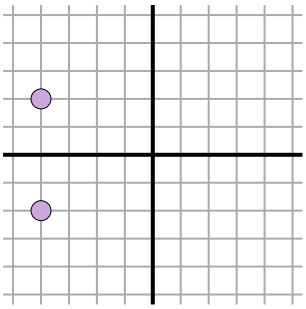

$\sqrt{(-4--4)^2 + (-2-2)^2}$

$\sqrt{(0) + (16)}$

1)

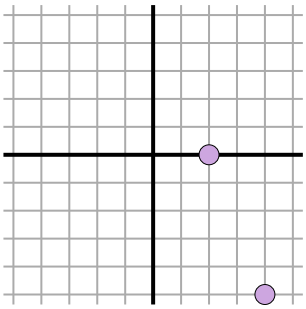

$\sqrt{(4-2)^2 + (-5-0)^2}$

$\sqrt{(4) + (25)}$

2)

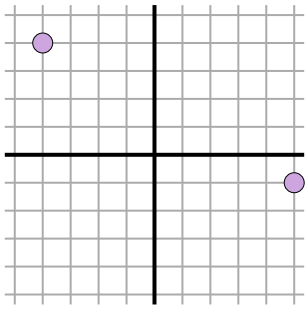

$\sqrt{(5--4)^2 + (-1-4)^2}$

$\sqrt{(81) + (25)}$

3)

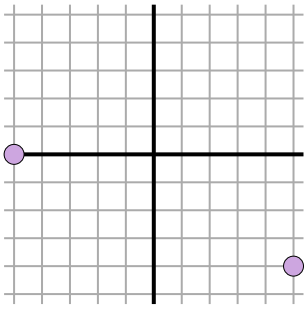

$\sqrt{(5--5)^2 + (-4-0)^2}$

$\sqrt{(100) + (16)}$

4)

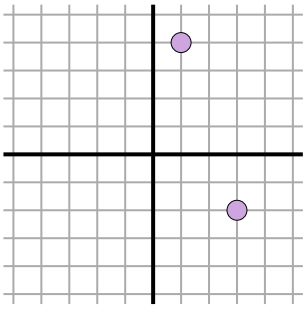

$\sqrt{(3-1)^2 + (-2-4)^2}$

$\sqrt{(4) + (36)}$

5)

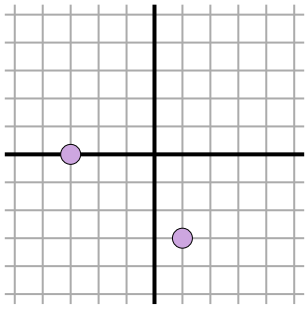

$\sqrt{(-3-1)^2 + (0--3)^2}$

$\sqrt{(16) + (9)}$

6)

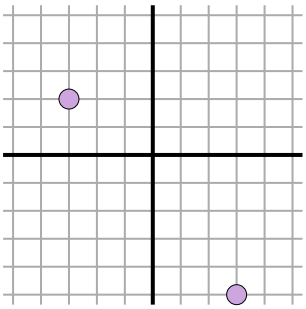

$\sqrt{(-3-3)^2 + (2--5)^2}$

$\sqrt{(36) + (49)}$

7)

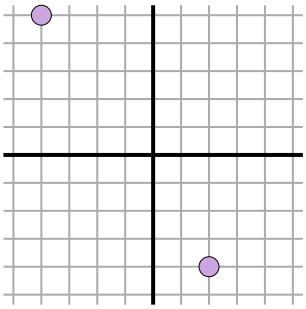

$\sqrt{(2--4)^2 + (-4-5)^2}$

$\sqrt{(36) + (81)}$

8)

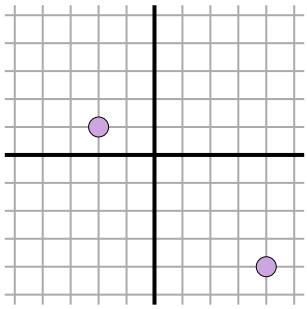

$\sqrt{(4--2)^2 + (-4-1)^2}$

$\sqrt{(36) + (25)}$

9)

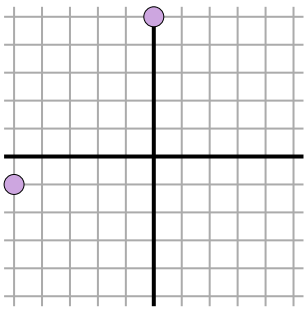

$\sqrt{(-5-0)^2 + (-1-5)^2}$

$\sqrt{(25) + (36)}$

10)

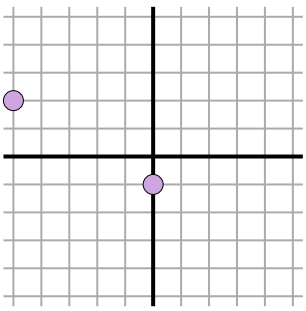

$\sqrt{(0--5)^2 + (-1-2)^2}$

$\sqrt{(25) + (9)}$

11)

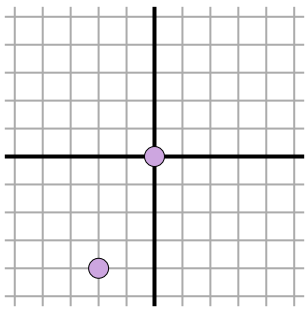

$\sqrt{(0--2)^2 + (0--4)^2}$

$\sqrt{(4) + (16)}$

Risposte

Es.	4
1.	5,4
2.	10,3
3.	10,8
4.	6,3
5.	5
6.	9,2
7.	10,8
8.	7,8
9.	7,8
10.	5,8
11.	4,5