Trova la distanza sulla griglia

Nome:

Trova la distanza tra i due punti.

Es)

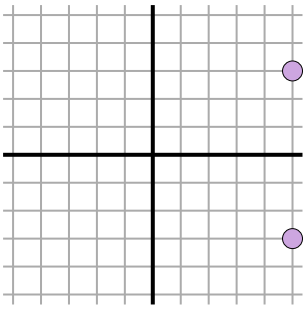

1)

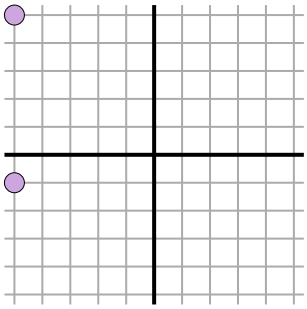

2)

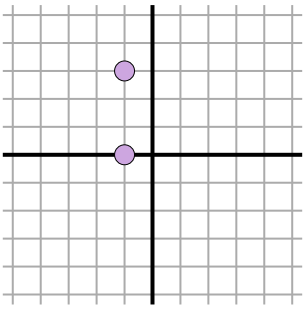

3)

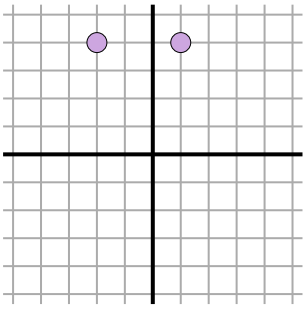

4)

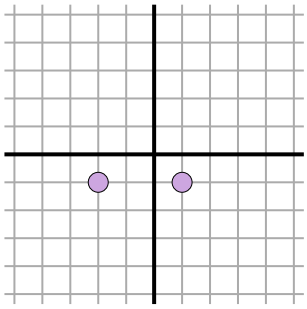

5)

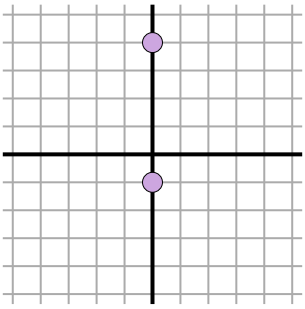

6)

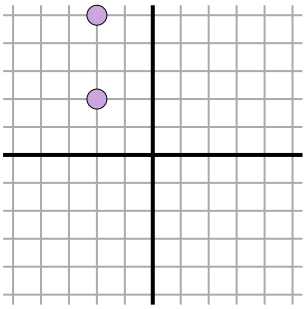

7)

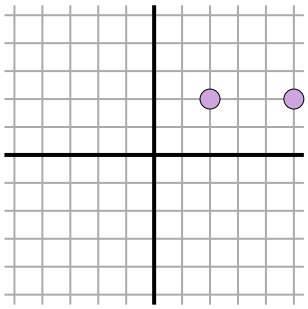

8)

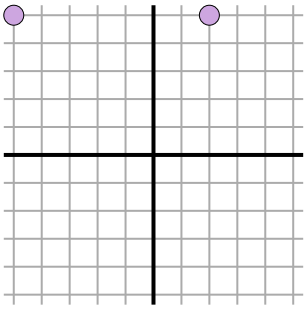

9)

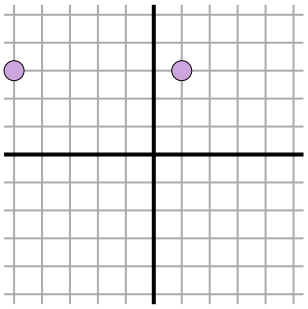

10)

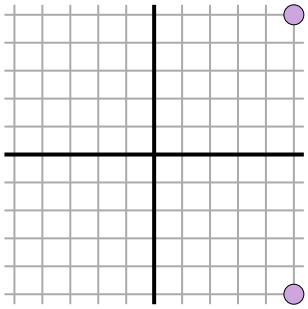

11)

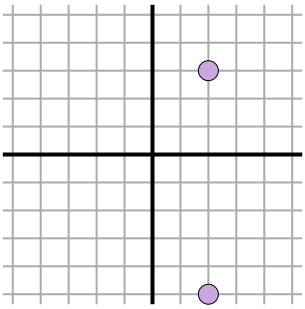

Risposte

Es. 6

1. _____
2. _____
3. _____
4. _____
5. _____
6. _____
7. _____
8. _____
9. _____
10. _____
11. _____

1-10	91	82	73	64	55	45	36	27	18	9
11	0									

Trova la distanza sulla griglia

Nome: **Soluzioni**

Trova la distanza tra i due punti.

Es)

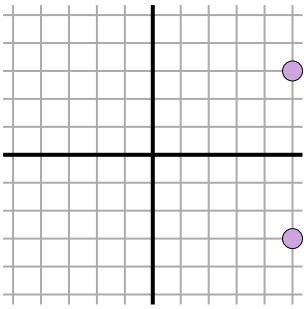

$\sqrt{(5-5)^2 + (-3-3)^2}$

$\sqrt{(0) + (36)}$

1)

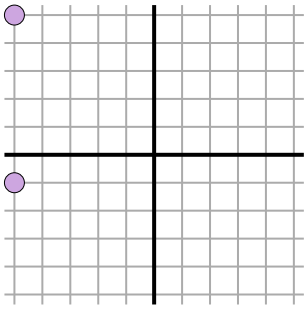

$\sqrt{(-5--5)^2 + (-1-5)^2}$

$\sqrt{(0) + (36)}$

2)

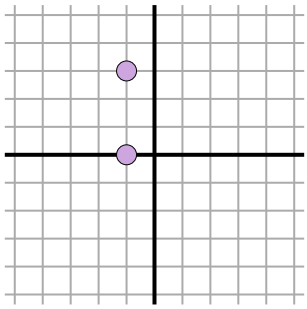

$\sqrt{(-1--1)^2 + (0-3)^2}$

$\sqrt{(0) + (9)}$

3)

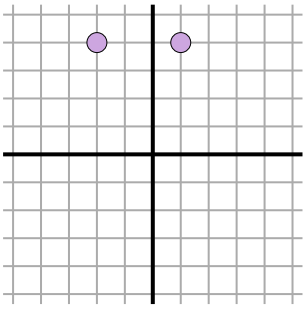

$\sqrt{(-2-1)^2 + (4-4)^2}$

$\sqrt{(9) + (0)}$

4)

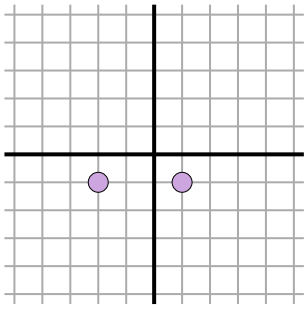

$\sqrt{(1--2)^2 + (-1--1)^2}$

$\sqrt{(9) + (0)}$

5)

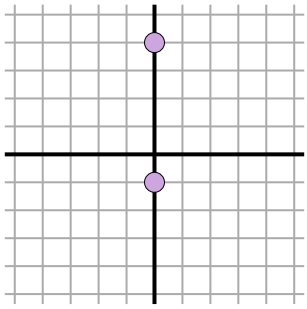

$\sqrt{(0-0)^2 + (-1-4)^2}$

$\sqrt{(0) + (25)}$

6)

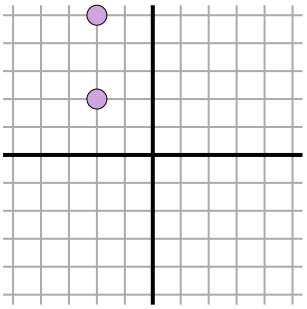

$\sqrt{(-2--2)^2 + (2-5)^2}$

$\sqrt{(0) + (9)}$

7)

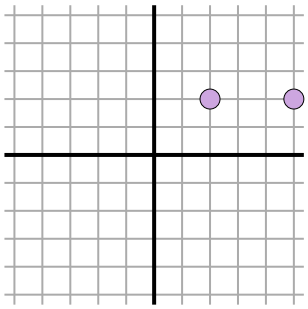

$\sqrt{(2-5)^2 + (2-2)^2}$

$\sqrt{(9) + (0)}$

8)

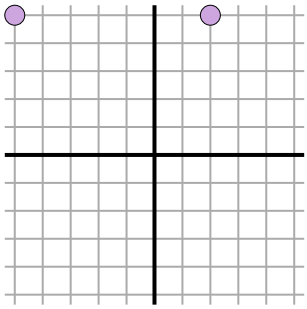

$\sqrt{(2--5)^2 + (5-5)^2}$

$\sqrt{(49) + (0)}$

9)

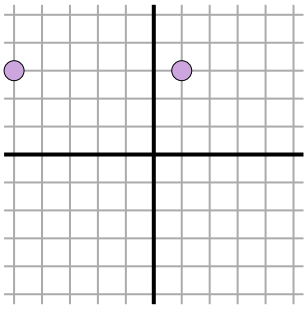

$\sqrt{(-5-1)^2 + (3-3)^2}$

$\sqrt{(36) + (0)}$

10)

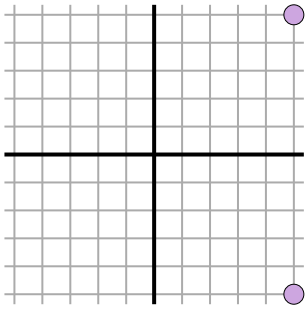

$\sqrt{(5-5)^2 + (5--5)^2}$

$\sqrt{(0) + (100)}$

11)

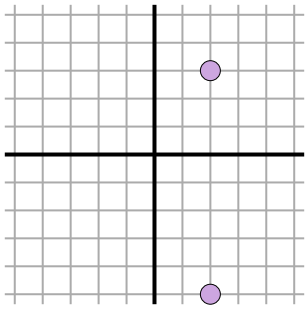

$\sqrt{(2-2)^2 + (3--5)^2}$

$\sqrt{(0) + (64)}$

Risposte

Es.	6
1.	6
2.	3
3.	3
4.	3
5.	5
6.	3
7.	3
8.	7
9.	6
10.	10
11.	8