Esprimi le disuguaglianze sulla linea numerata Nome:

Usa la linea numerata per esprimere le disuguaglianze.

Es) $X \geq -71$

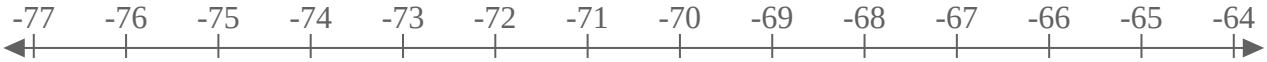

1) $X \geq 50$

2) $X < -10$



3) $X < 33$

4) $X \geq 160$

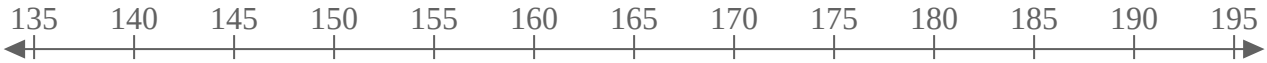

5) $X \leq -71$

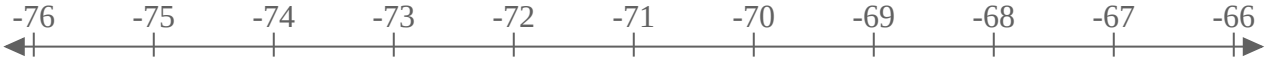

6) $X \leq 70$

7) $X \geq 10$

8) $X > -20$

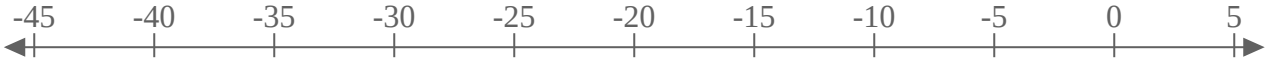

9) $X \leq -61$

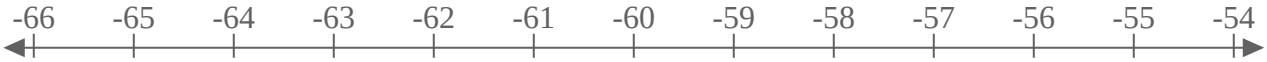

10) $X > 144$

11) $X > 190$

12) $X < -80$

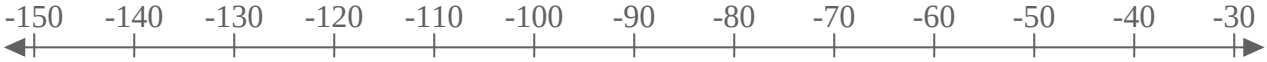

13) $X \geq -180$

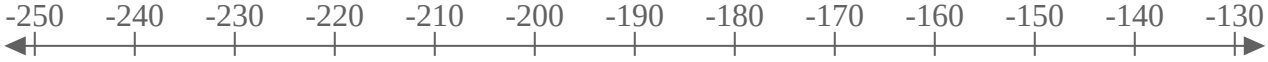

1-10	92	85	77	69	62	54	46	38	31	23
11-13	15	8	0							

Esprimi le disuguaglianze sulla linea numerata Nome: **Soluzioni**

Usa la linea numerata per esprimere le disuguaglianze.

Es) $X \geq -71$

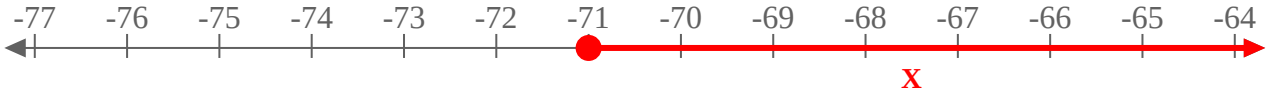

1) $X \geq 50$

2) $X < -10$

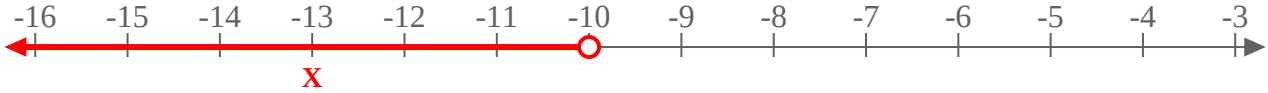

3) $X < 33$

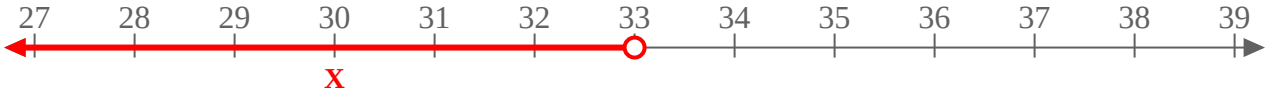

4) $X \geq 160$

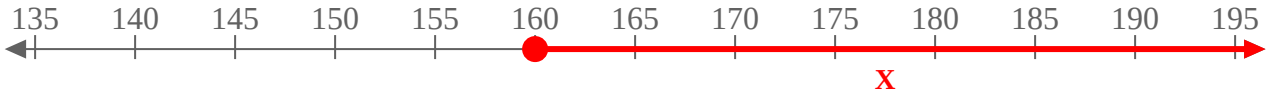

5) $X \leq -71$

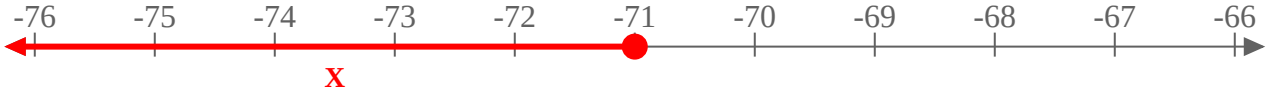

6) $X \leq 70$

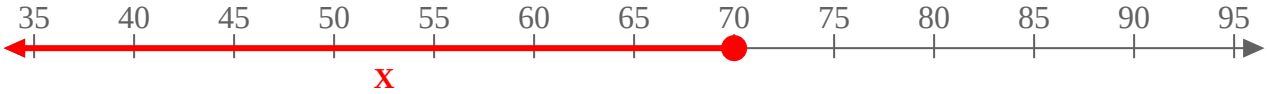

7) $X \geq 10$

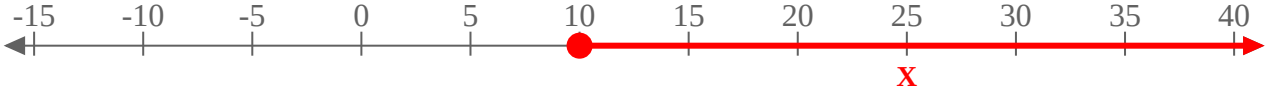

8) $X > -20$

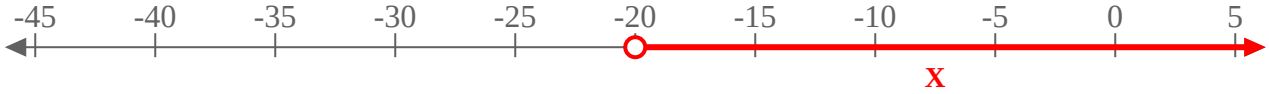

9) $X \leq -61$

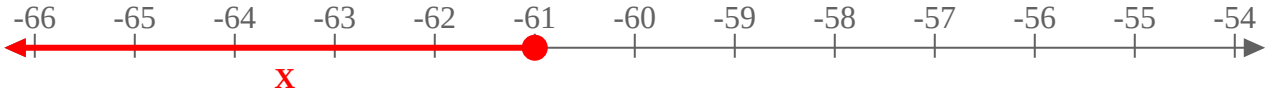

10) $X > 144$

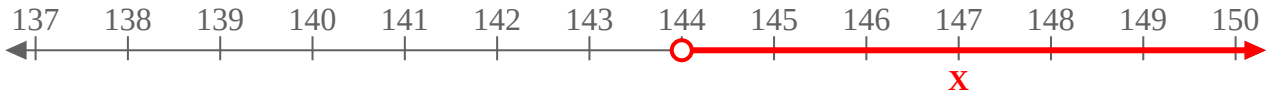

11) $X > 190$

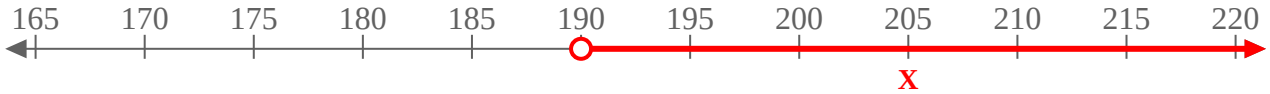

12) $X < -80$

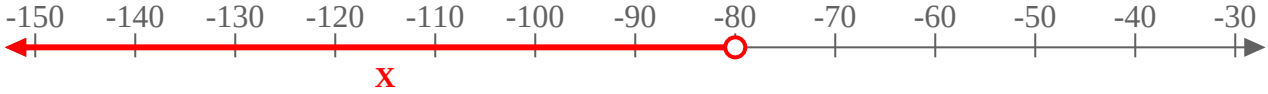

13) $X \geq -180$

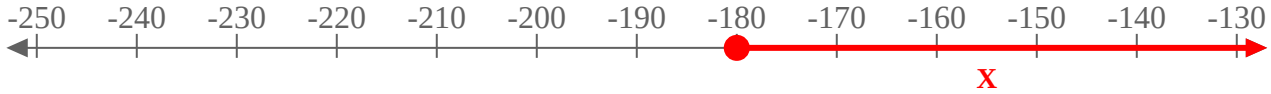

1-10	92	85	77	69	62	54	46	38	31	23
11-13	15	8	0							