Moltiplicazioni con la linea numerata

Nome:

Usa la linea numerata per risolvere ogni operazione.

1) 5 × 7 =
7 × 5 =

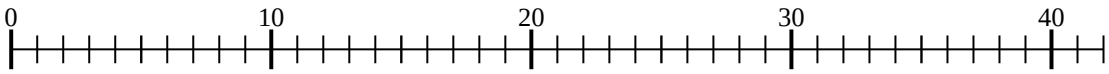

2) 3 × 7 =
7 × 3 =

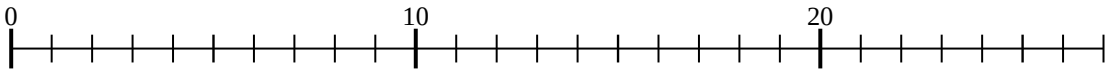

3) 2 × 6 =
6 × 2 =

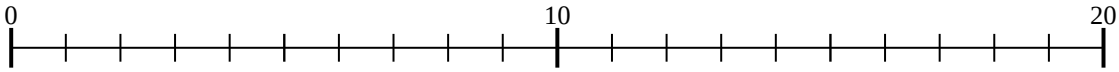

4) 3 × 2 =
2 × 3 =

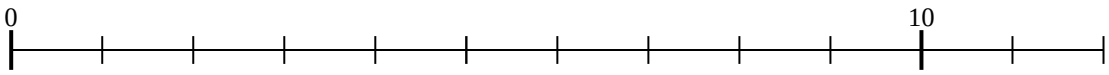

5) 4 × 8 =
8 × 4 =

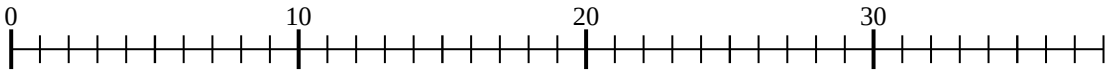

6) 5 × 2 =
2 × 5 =

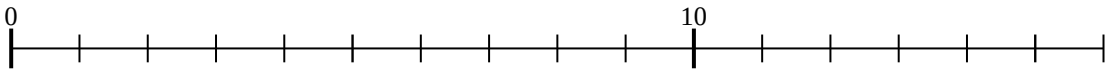

7) 5 × 8 =
8 × 5 =

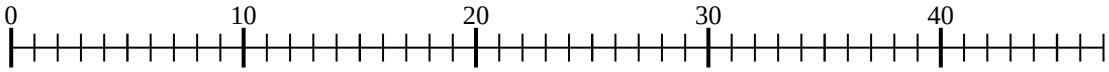

8) 2 × 7 =
7 × 2 =

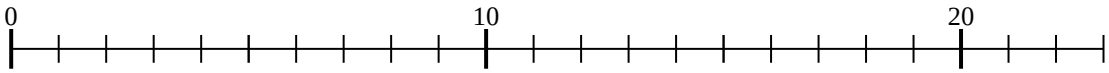

9) 2 × 5 =
5 × 2 =

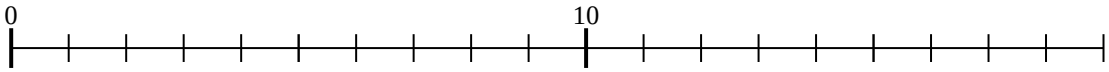

10) 2 × 9 =
9 × 2 =

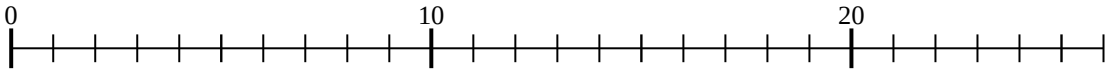

11) 4 × 6 =
6 × 4 =

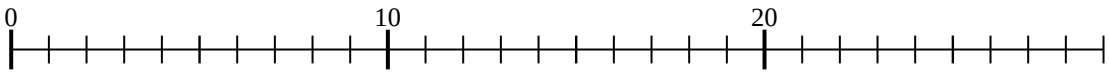

Risposte

1. _____
2. _____
3. _____
4. _____
5. _____
6. _____
7. _____
8. _____
9. _____
10. _____
11. _____

1-10	91	82	73	64	55	45	36	27	18	9
11	0									

Moltiplicazioni con la linea numerata Nome: **Soluzioni**

Usa la linea numerata per risolvere ogni operazione.

1) 5 × 7 =
7 × 5 =

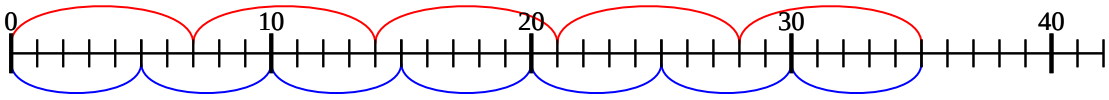

2) 3 × 7 =
7 × 3 =

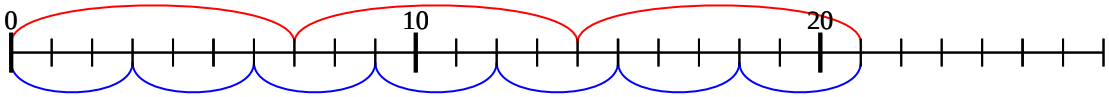

3) 2 × 6 =
6 × 2 =

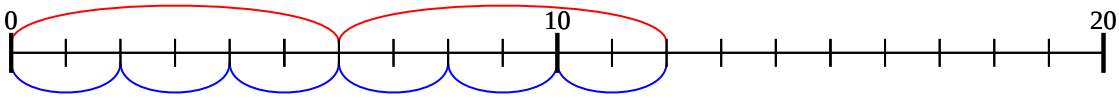

4) 3 × 2 =
2 × 3 =

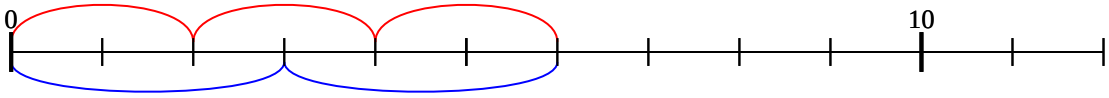

5) 4 × 8 =
8 × 4 =

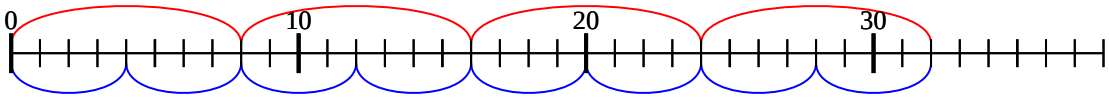

6) 5 × 2 =
2 × 5 =

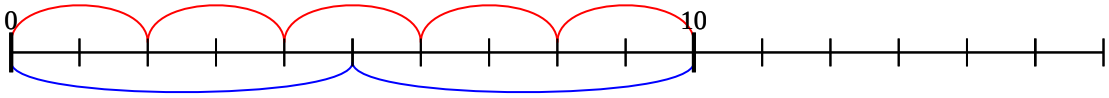

7) 5 × 8 =
8 × 5 =

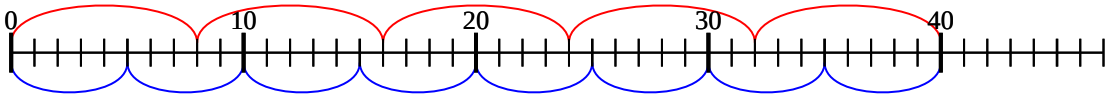

8) 2 × 7 =
7 × 2 =

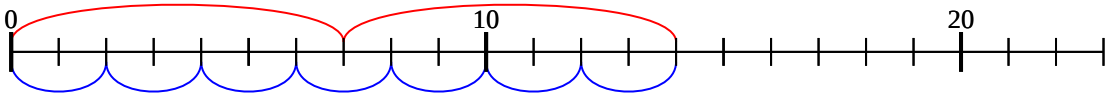

9) 2 × 5 =
5 × 2 =

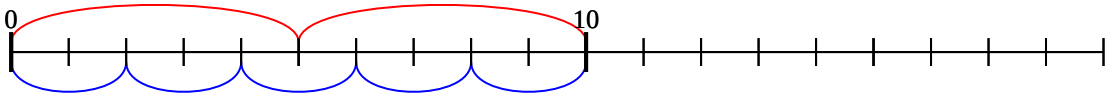

10) 2 × 9 =
9 × 2 =

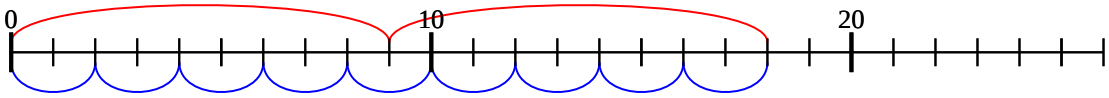

11) 4 × 6 =
6 × 4 =

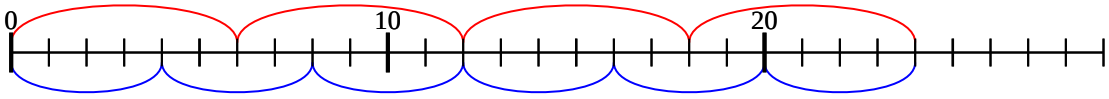

Risposte

1. **35**
2. **21**
3. **12**
4. **6**
5. **32**
6. **10**
7. **40**
8. **14**
9. **10**
10. **18**
11. **24**

1-10	91	82	73	64	55	45	36	27	18	9
11	0									