Moltiplicazioni con la linea numerata

Nome:

Usa la linea numerata per risolvere ogni operazione.

1) 4 × 6 =

6 × 4 =

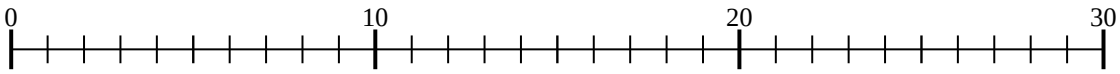

2) 2 × 8 =

8 × 2 =

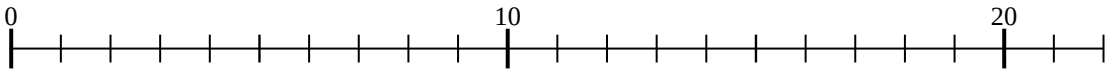

3) 5 × 2 =

2 × 5 =

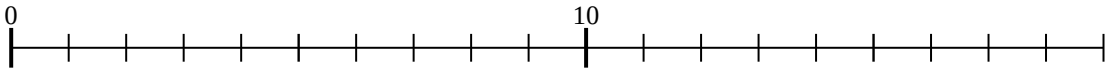

4) 5 × 8 =

8 × 5 =

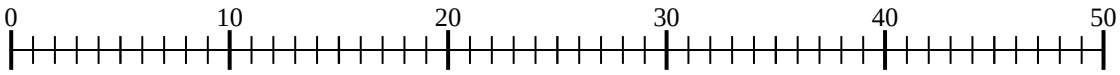

5) 3 × 2 =

2 × 3 =

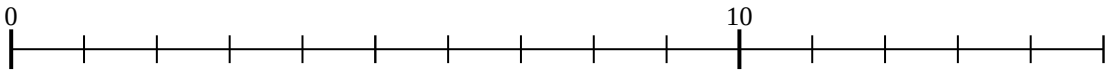

6) 4 × 10 =

10 × 4 =

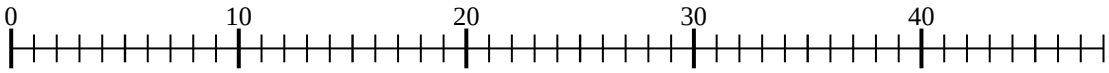

7) 5 × 4 =

4 × 5 =

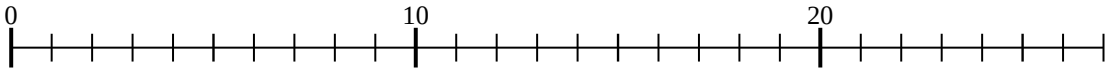

8) 2 × 9 =

9 × 2 =

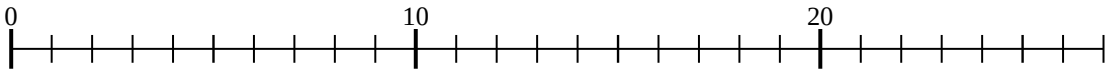

9) 3 × 9 =

9 × 3 =

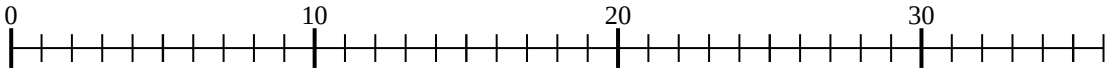

10) 4 × 9 =

9 × 4 =

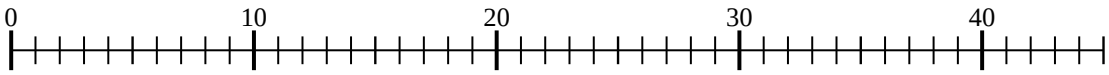

11) 2 × 4 =

4 × 2 =

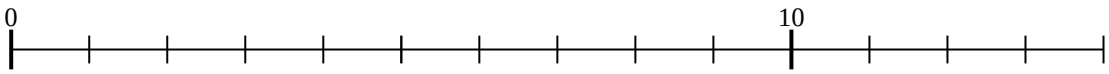

Risposte

1. _____
2. _____
3. _____
4. _____
5. _____
6. _____
7. _____
8. _____
9. _____
10. _____
11. _____

1-10	91	82	73	64	55	45	36	27	18	9
11	0									

Usa la linea numerata per risolvere ogni operazione.

1) 4 × 6 =
6 × 4 =

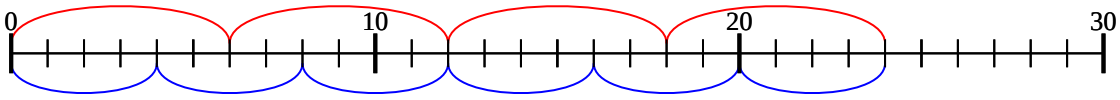

2) 2 × 8 =
8 × 2 =

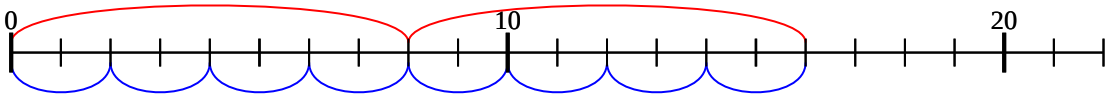

3) 5 × 2 =
2 × 5 =

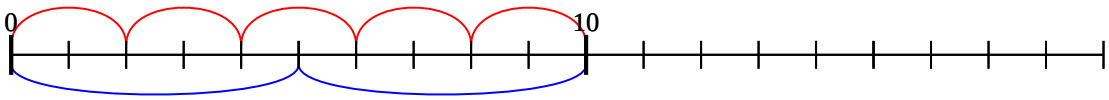

4) 5 × 8 =
8 × 5 =

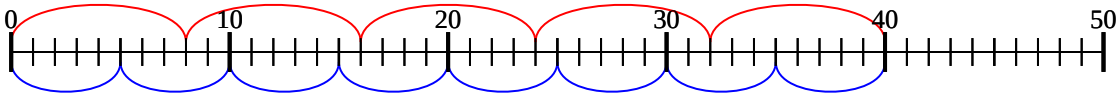

5) 3 × 2 =
2 × 3 =

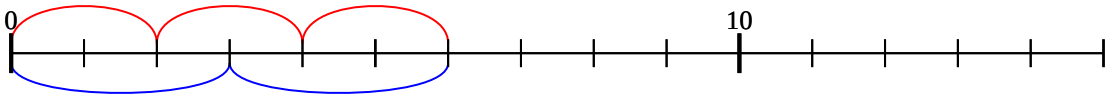

6) 4 × 10 =
10 × 4 =

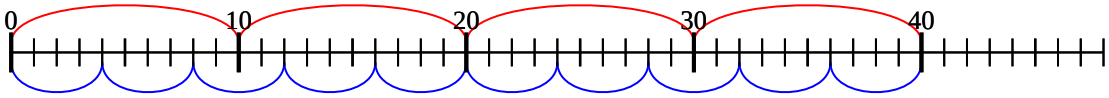

7) 5 × 4 =
4 × 5 =

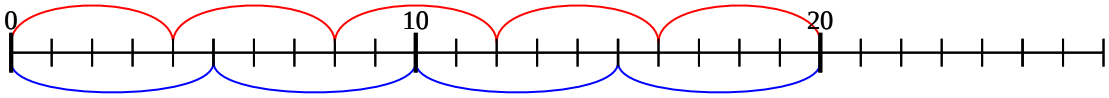

8) 2 × 9 =
9 × 2 =

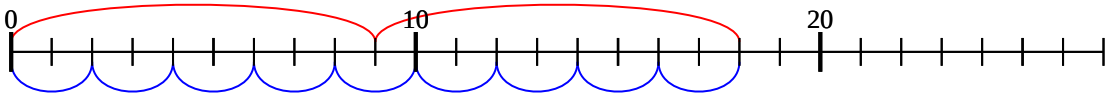

9) 3 × 9 =
9 × 3 =

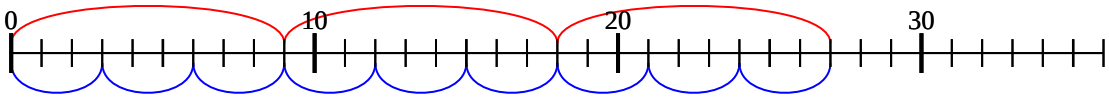

10) 4 × 9 =
9 × 4 =

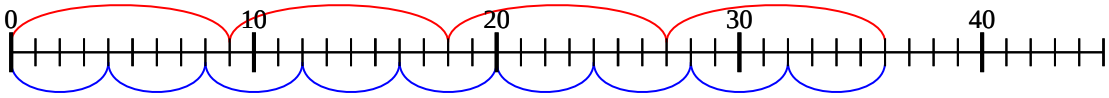

11) 2 × 4 =
4 × 2 =

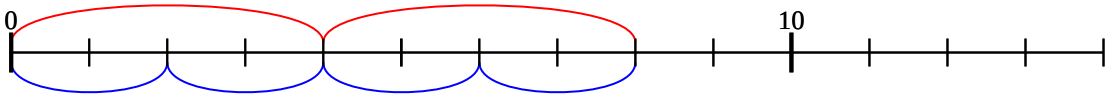

Risposte

1. **24**
2. **16**
3. **10**
4. **40**
5. **6**
6. **40**
7. **20**
8. **18**
9. **27**
10. **36**
11. **8**

1-10	91	82	73	64	55	45	36	27	18	9
11	0									