Moltiplicazioni con la linea numerata

Nome:

Usa la linea numerata per risolvere ogni operazione.

1) 3 × 3 =

3 × 3 =

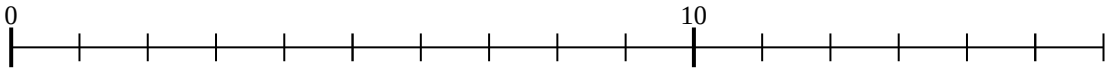

2) 3 × 2 =

2 × 3 =

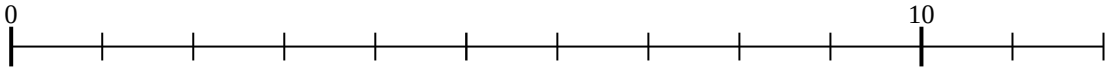

3) 3 × 4 =

4 × 3 =

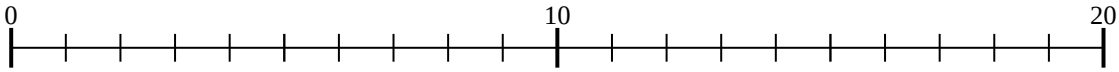

4) 3 × 5 =

5 × 3 =

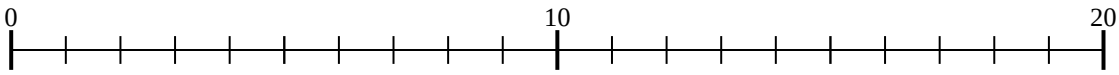

5) 4 × 7 =

7 × 4 =

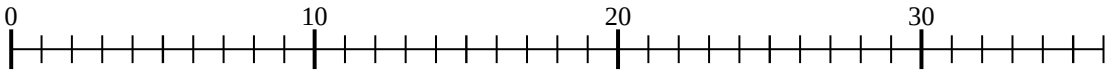

6) 4 × 10 =

10 × 4 =

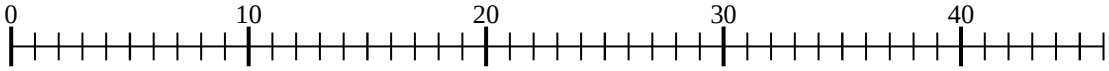

7) 4 × 6 =

6 × 4 =

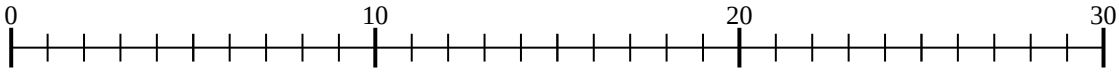

8) 3 × 10 =

10 × 3 =

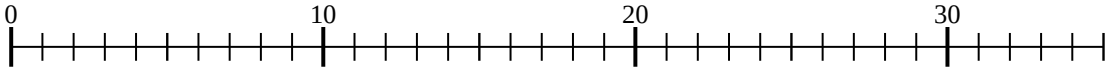

9) 5 × 6 =

6 × 5 =

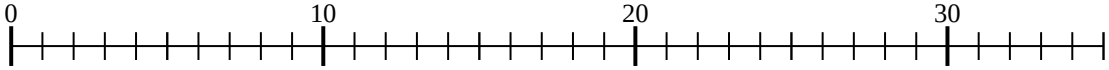

10) 4 × 3 =

3 × 4 =

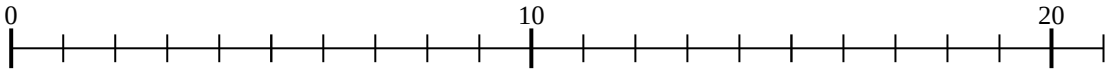

11) 3 × 6 =

6 × 3 =

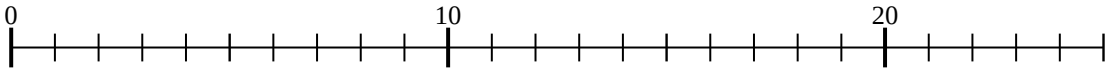

Risposte

1. _____
2. _____
3. _____
4. _____
5. _____
6. _____
7. _____
8. _____
9. _____
10. _____
11. _____

1-10	91	82	73	64	55	45	36	27	18	9
11	0									

Moltiplicazioni con la linea numerata Nome: **Soluzioni**

Usa la linea numerata per risolvere ogni operazione.

1) 3 × 3 =
3 × 3 =

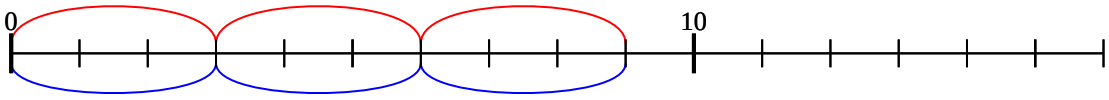

2) 3 × 2 =
2 × 3 =

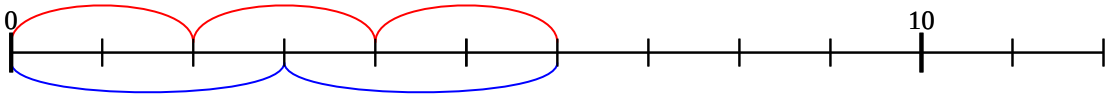

3) 3 × 4 =
4 × 3 =

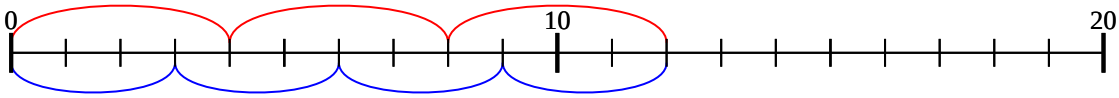

4) 3 × 5 =
5 × 3 =

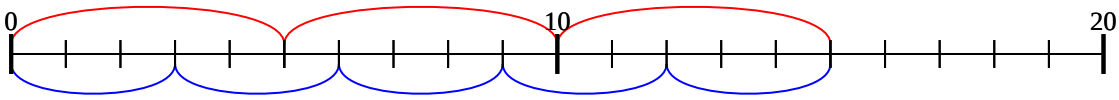

5) 4 × 7 =
7 × 4 =

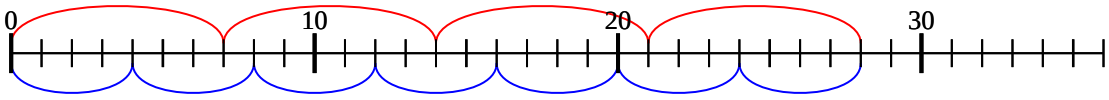

6) 4 × 10 =
10 × 4 =

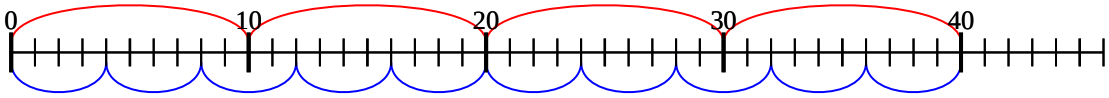

7) 4 × 6 =
6 × 4 =

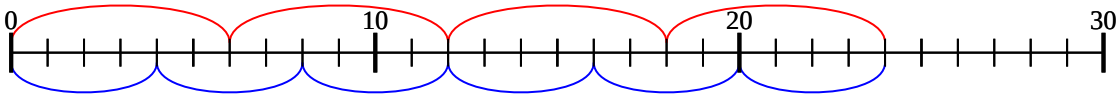

8) 3 × 10 =
10 × 3 =

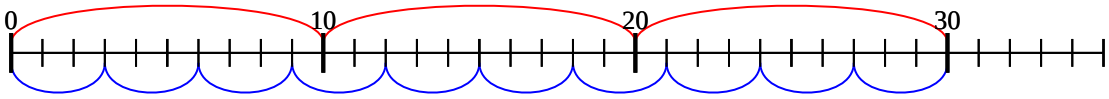

9) 5 × 6 =
6 × 5 =

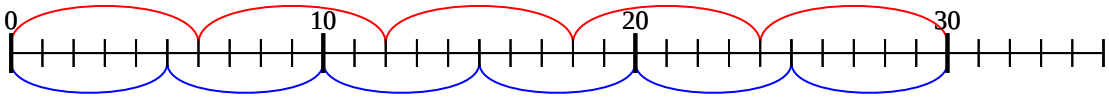

10) 4 × 3 =
3 × 4 =

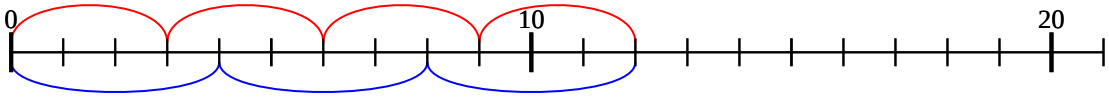

11) 3 × 6 =
6 × 3 =

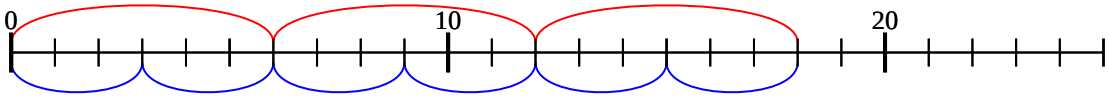

Risposte

1. **9**
2. **6**
3. **12**
4. **15**
5. **28**
6. **40**
7. **24**
8. **30**
9. **30**
10. **12**
11. **18**

1-10	91	82	73	64	55	45	36	27	18	9
11	0									

Moltiplicazioni con la linea numerata

Nome:

Usa la linea numerata per risolvere ogni operazione.

1) 3 × 5 =
5 × 3 =

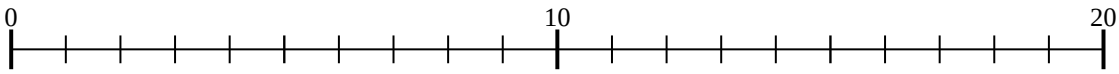

2) 4 × 7 =
7 × 4 =

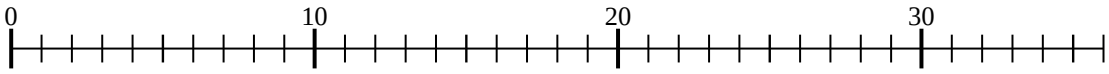

3) 2 × 8 =
8 × 2 =

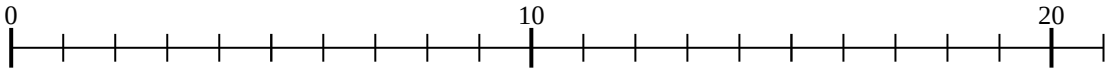

4) 4 × 9 =
9 × 4 =

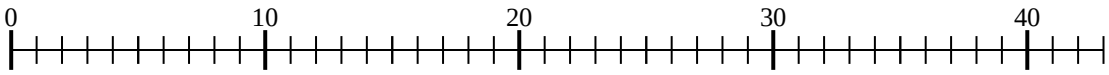

5) 4 × 2 =
2 × 4 =

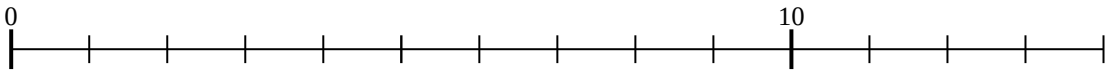

6) 4 × 4 =
4 × 4 =

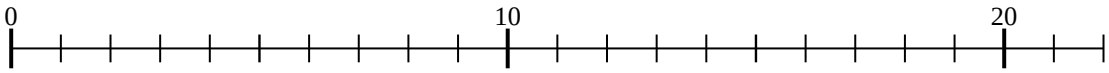

7) 3 × 2 =
2 × 3 =

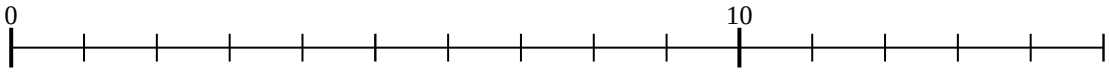

8) 2 × 5 =
5 × 2 =

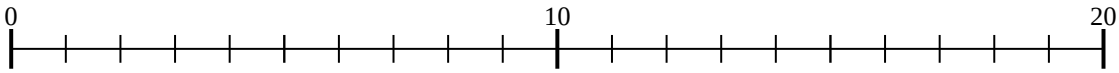

9) 2 × 3 =
3 × 2 =

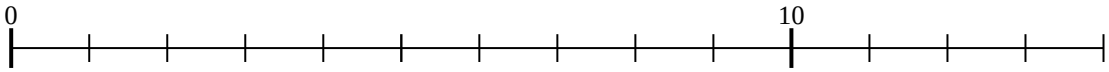

10) 5 × 7 =
7 × 5 =

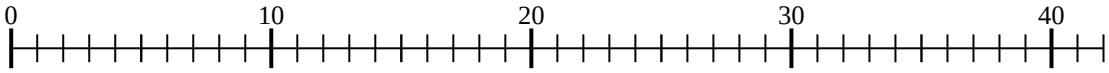

11) 5 × 2 =
2 × 5 =

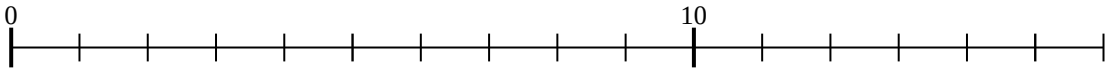

Risposte

1. _____
2. _____
3. _____
4. _____
5. _____
6. _____
7. _____
8. _____
9. _____
10. _____
11. _____

1-10	91	82	73	64	55	45	36	27	18	9
11	0									

Moltiplicazioni con la linea numerata Nome: **Soluzioni**

Usa la linea numerata per risolvere ogni operazione.

1) 3 × 5 =
5 × 3 =

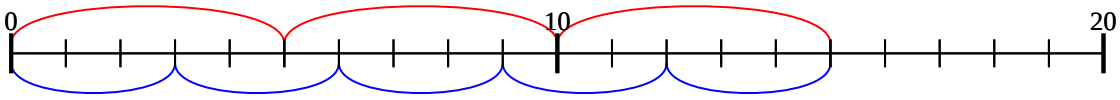

2) 4 × 7 =
7 × 4 =

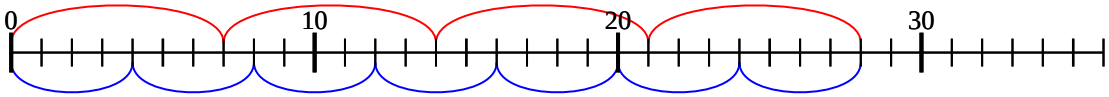

3) 2 × 8 =
8 × 2 =

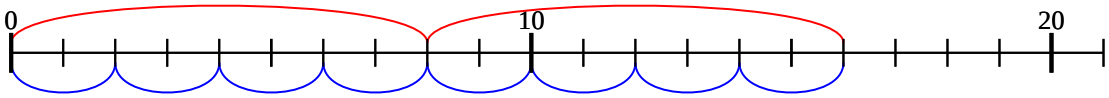

4) 4 × 9 =
9 × 4 =

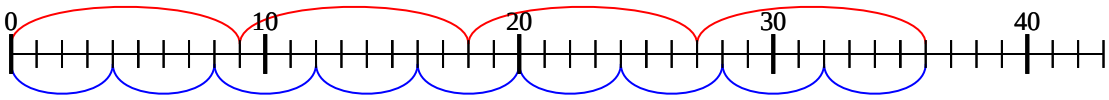

5) 4 × 2 =
2 × 4 =

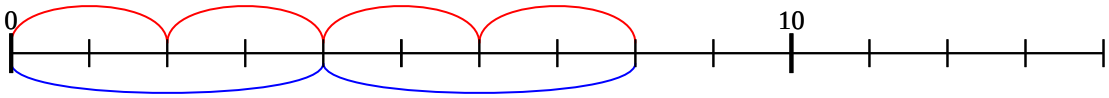

6) 4 × 4 =
4 × 4 =

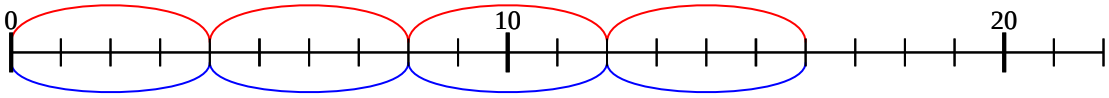

7) 3 × 2 =
2 × 3 =

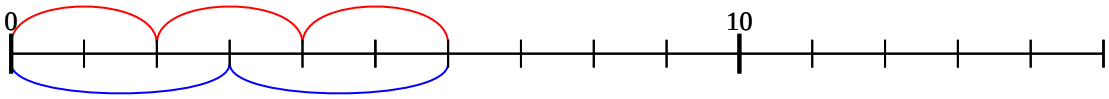

8) 2 × 5 =
5 × 2 =

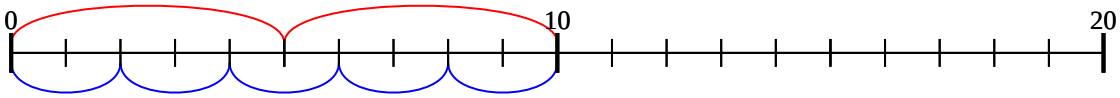

9) 2 × 3 =
3 × 2 =

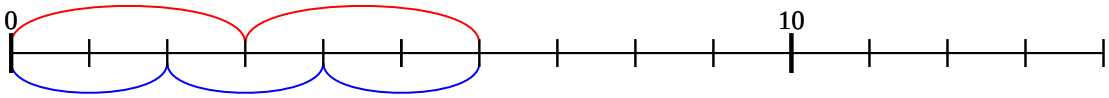

10) 5 × 7 =
7 × 5 =

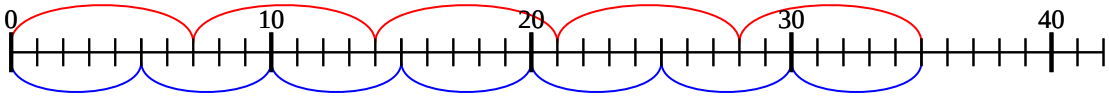

11) 5 × 2 =
2 × 5 =

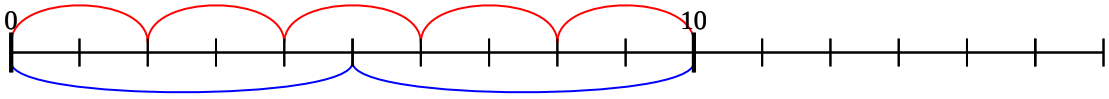

Risposte

1. **15**
2. **28**
3. **16**
4. **36**
5. **8**
6. **16**
7. **6**
8. **10**
9. **6**
10. **35**
11. **10**

1-10	91	82	73	64	55	45	36	27	18	9
11	0									

Moltiplicazioni con la linea numerata

Nome:

Usa la linea numerata per risolvere ogni operazione.

1) 3 × 10 =

10 × 3 =

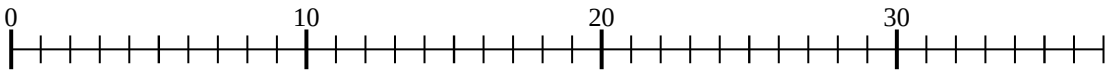

2) 4 × 7 =

7 × 4 =

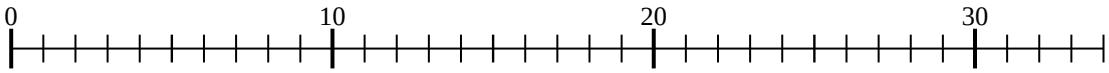

3) 2 × 3 =

3 × 2 =

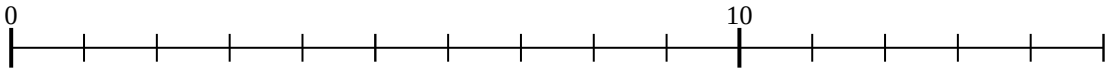

4) 4 × 8 =

8 × 4 =

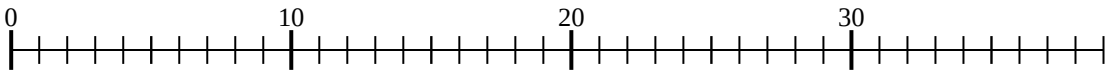

5) 5 × 3 =

3 × 5 =

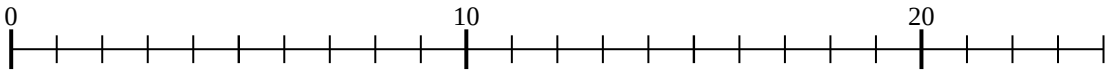

6) 2 × 5 =

5 × 2 =

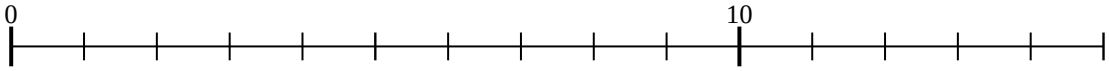

7) 3 × 6 =

6 × 3 =

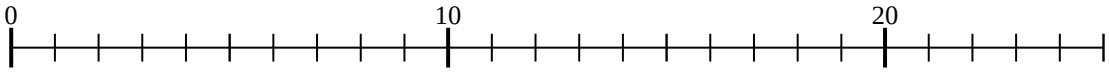

8) 2 × 10 =

10 × 2 =

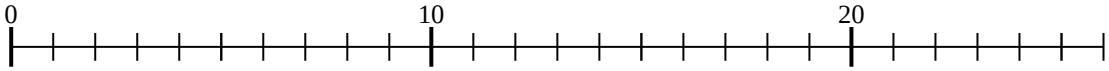

9) 4 × 9 =

9 × 4 =

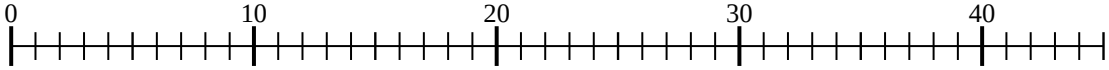

10) 5 × 8 =

8 × 5 =

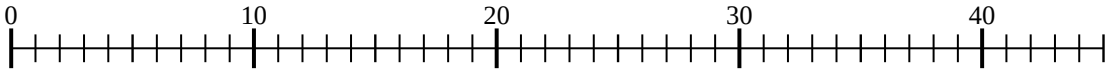

11) 3 × 3 =

3 × 3 =

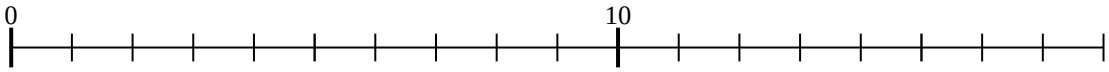

Risposte

1. _____
2. _____
3. _____
4. _____
5. _____
6. _____
7. _____
8. _____
9. _____
10. _____
11. _____

1-10	91	82	73	64	55	45	36	27	18	9
11	0									

Moltiplicazioni con la linea numerata Nome: **Soluzioni**

Usa la linea numerata per risolvere ogni operazione.

1) 3 × 10 =
10 × 3 =

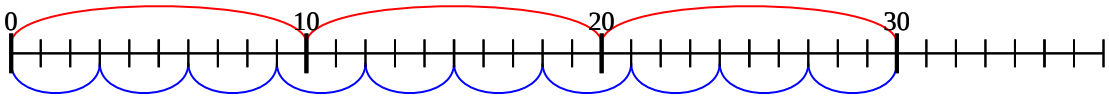

2) 4 × 7 =
7 × 4 =

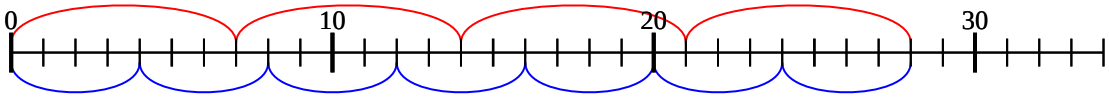

3) 2 × 3 =
3 × 2 =

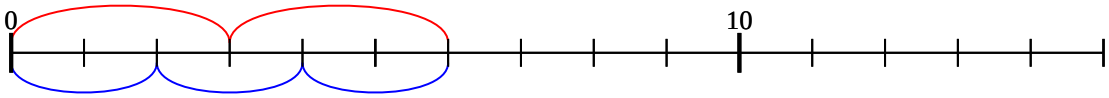

4) 4 × 8 =
8 × 4 =

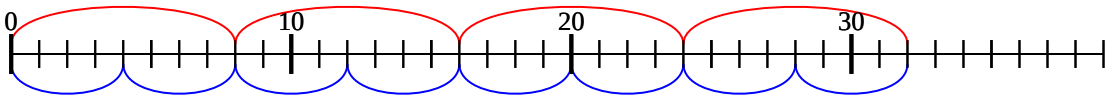

5) 5 × 3 =
3 × 5 =

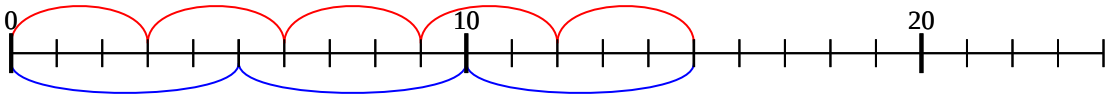

6) 2 × 5 =
5 × 2 =

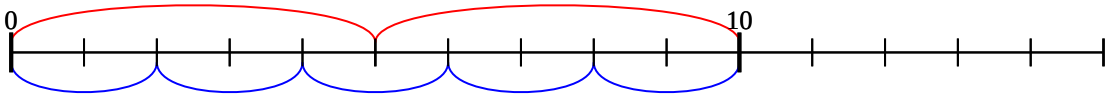

7) 3 × 6 =
6 × 3 =

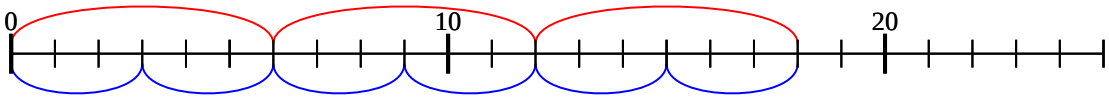

8) 2 × 10 =
10 × 2 =

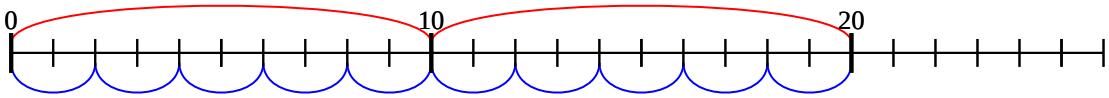

9) 4 × 9 =
9 × 4 =

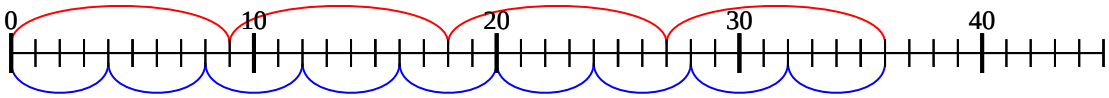

10) 5 × 8 =
8 × 5 =

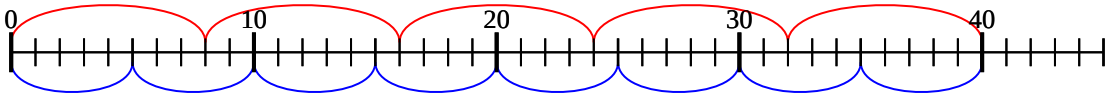

11) 3 × 3 =
3 × 3 =

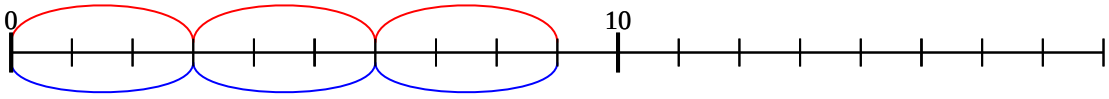

Risposte

1. **30**
2. **28**
3. **6**
4. **32**
5. **15**
6. **10**
7. **18**
8. **20**
9. **36**
10. **40**
11. **9**

1-10	91	82	73	64	55	45	36	27	18	9
11	0									

Moltiplicazioni con la linea numerata Nome:

Usa la linea numerata per risolvere ogni operazione.

1) 3 × 3 =

3 × 3 =

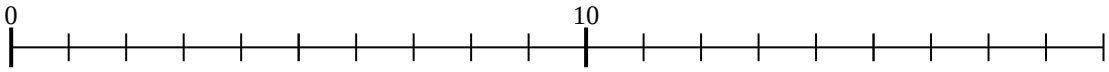

2) 2 × 5 =

5 × 2 =

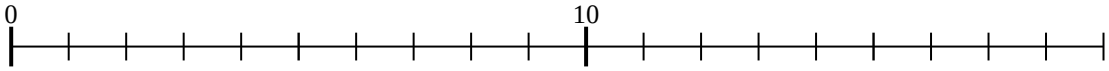

3) 4 × 8 =

8 × 4 =

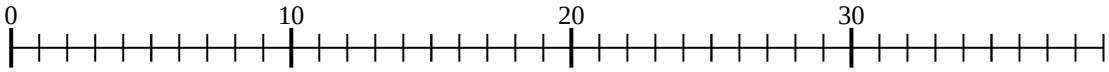

4) 4 × 2 =

2 × 4 =

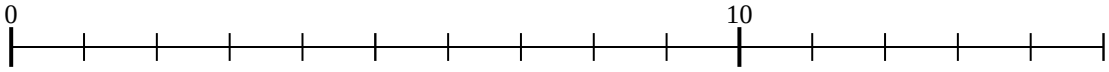

5) 4 × 6 =

6 × 4 =

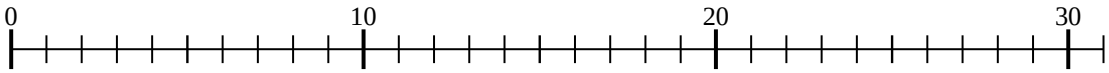

6) 3 × 7 =

7 × 3 =

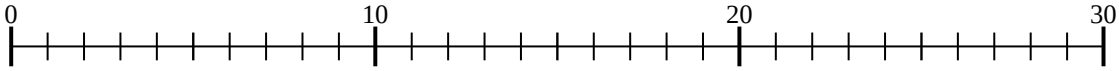

7) 2 × 2 =

2 × 2 =

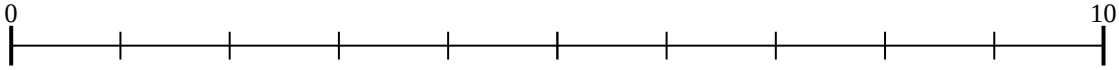

8) 5 × 6 =

6 × 5 =

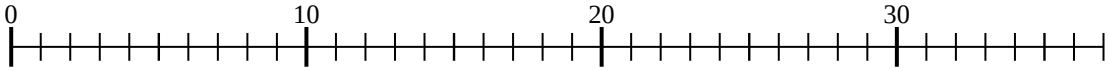

9) 5 × 4 =

4 × 5 =

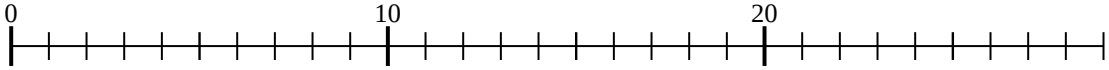

10) 5 × 3 =

3 × 5 =

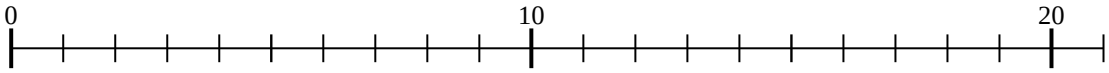

11) 3 × 4 =

4 × 3 =

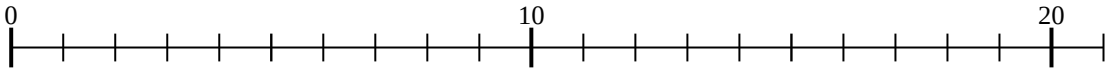

Risposte

1. _____
2. _____
3. _____
4. _____
5. _____
6. _____
7. _____
8. _____
9. _____
10. _____
11. _____

1-10	91	82	73	64	55	45	36	27	18	9
11	0									

Moltiplicazioni con la linea numerata

Nome: **Soluzioni**

Usa la linea numerata per risolvere ogni operazione.

1) 3 × 3 =

3 × 3 =

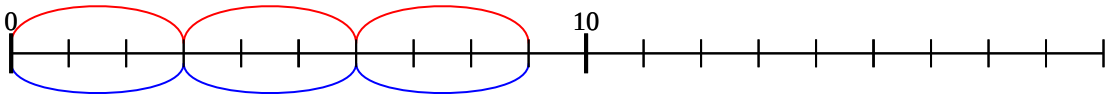

2) 2 × 5 =

5 × 2 =

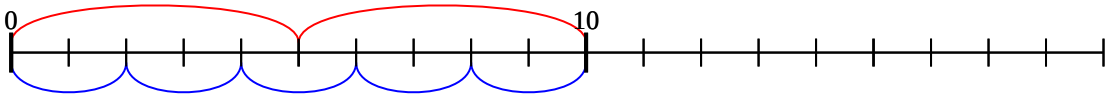

3) 4 × 8 =

8 × 4 =

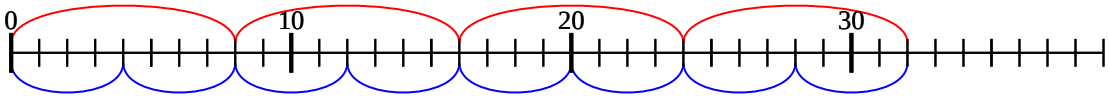

4) 4 × 2 =

2 × 4 =

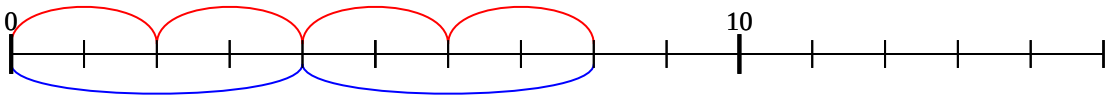

5) 4 × 6 =

6 × 4 =

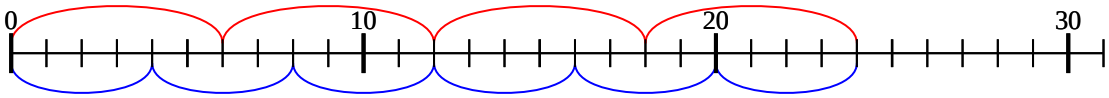

6) 3 × 7 =

7 × 3 =

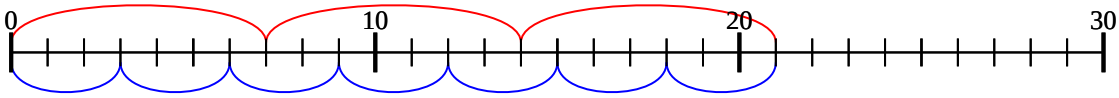

7) 2 × 2 =

2 × 2 =

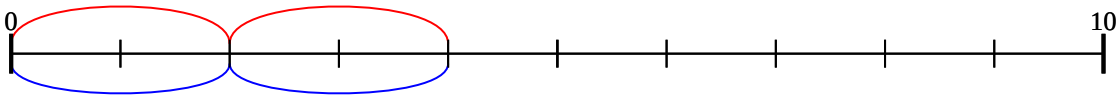

8) 5 × 6 =

6 × 5 =

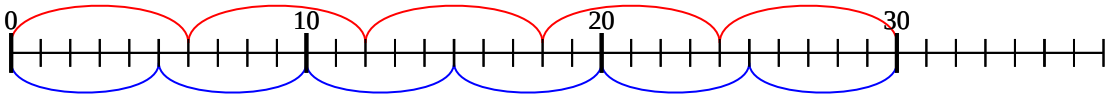

9) 5 × 4 =

4 × 5 =

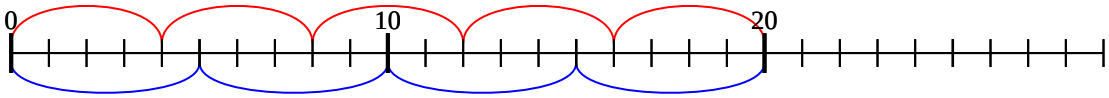

10) 5 × 3 =

3 × 5 =

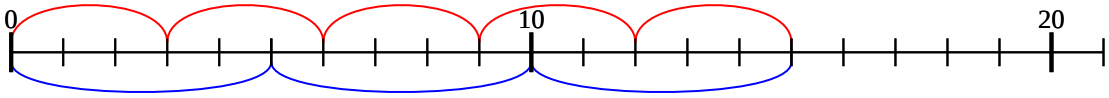

11) 3 × 4 =

4 × 3 =

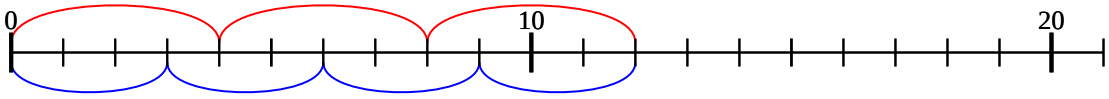

Risposte

1. **9**
2. **10**
3. **32**
4. **8**
5. **24**
6. **21**
7. **4**
8. **30**
9. **20**
10. **15**
11. **12**

1-10	91	82	73	64	55	45	36	27	18	9
11	0									

Moltiplicazioni con la linea numerata

Nome:

Usa la linea numerata per risolvere ogni operazione.

1) 5 × 7 =
7 × 5 =

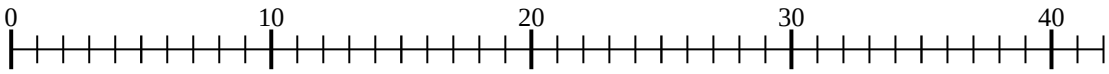

2) 3 × 7 =
7 × 3 =

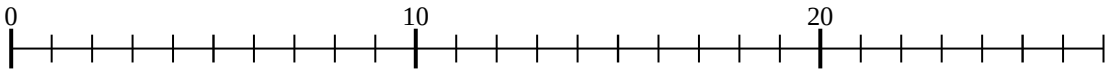

3) 2 × 6 =
6 × 2 =

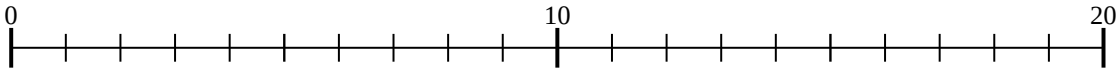

4) 3 × 2 =
2 × 3 =

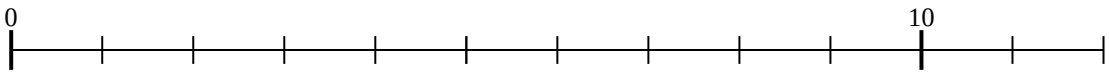

5) 4 × 8 =
8 × 4 =

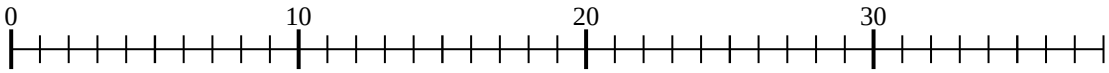

6) 5 × 2 =
2 × 5 =

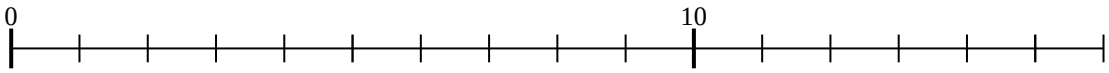

7) 5 × 8 =
8 × 5 =

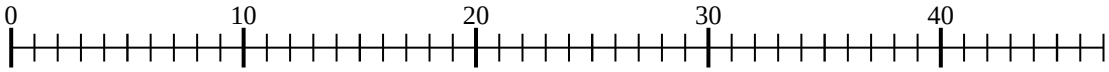

8) 2 × 7 =
7 × 2 =

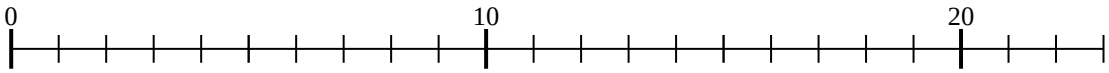

9) 2 × 5 =
5 × 2 =

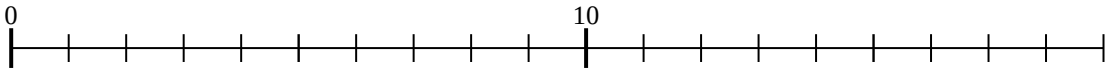

10) 2 × 9 =
9 × 2 =

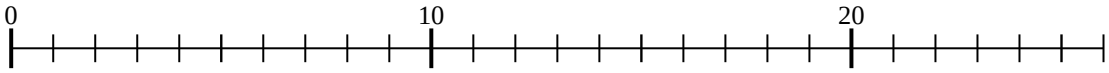

11) 4 × 6 =
6 × 4 =

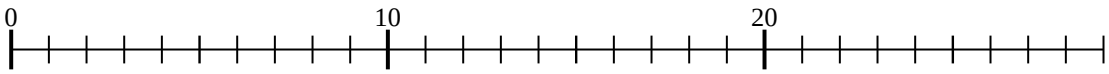

Risposte

1. _____
2. _____
3. _____
4. _____
5. _____
6. _____
7. _____
8. _____
9. _____
10. _____
11. _____

1-10	91	82	73	64	55	45	36	27	18	9
11	0									

Moltiplicazioni con la linea numerata Nome: **Soluzioni**

Usa la linea numerata per risolvere ogni operazione.

1) 5 × 7 =
7 × 5 =

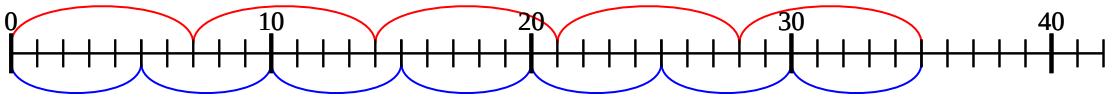

2) 3 × 7 =
7 × 3 =

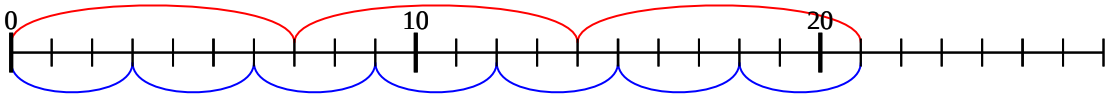

3) 2 × 6 =
6 × 2 =

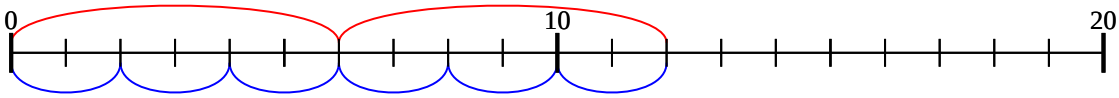

4) 3 × 2 =
2 × 3 =

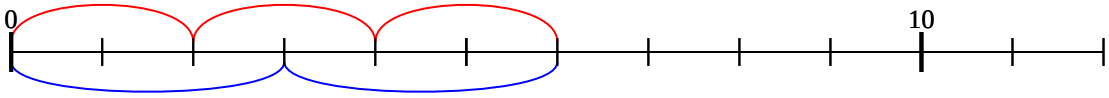

5) 4 × 8 =
8 × 4 =

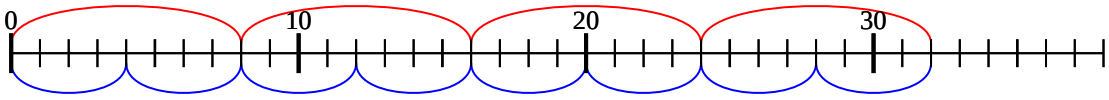

6) 5 × 2 =
2 × 5 =

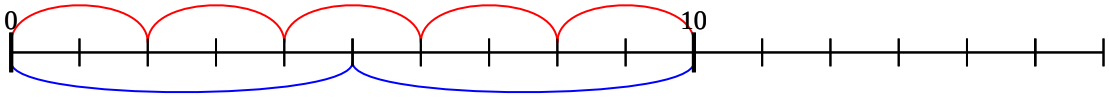

7) 5 × 8 =
8 × 5 =

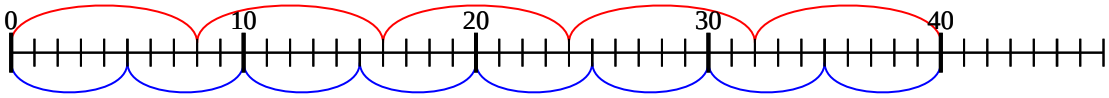

8) 2 × 7 =
7 × 2 =

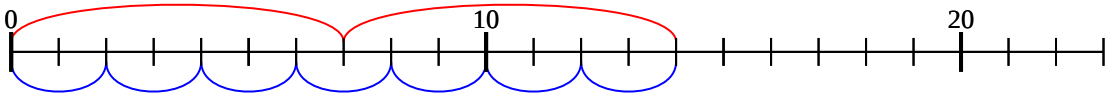

9) 2 × 5 =
5 × 2 =

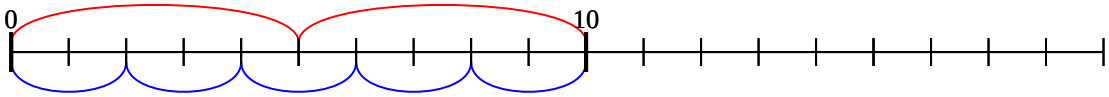

10) 2 × 9 =
9 × 2 =

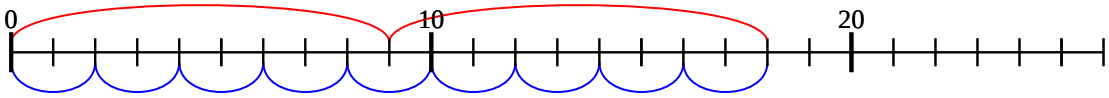

11) 4 × 6 =
6 × 4 =

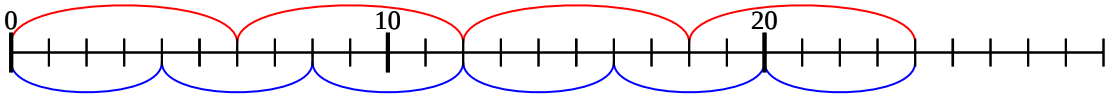

Risposte

1. **35**
2. **21**
3. **12**
4. **6**
5. **32**
6. **10**
7. **40**
8. **14**
9. **10**
10. **18**
11. **24**

1-10	91	82	73	64	55	45	36	27	18	9
11	0									

Moltiplicazioni con la linea numerata

Nome:

Usa la linea numerata per risolvere ogni operazione.

1) 2 × 6 =

6 × 2 =

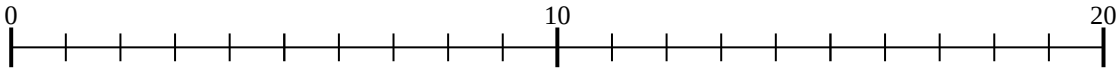

2) 5 × 10 =

10 × 5 =

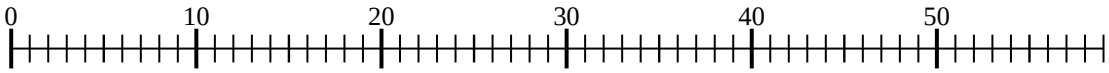

3) 3 × 2 =

2 × 3 =

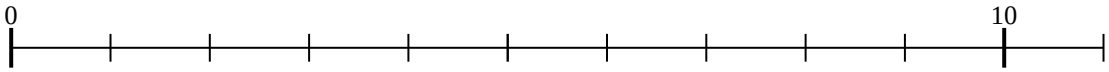

4) 4 × 9 =

9 × 4 =

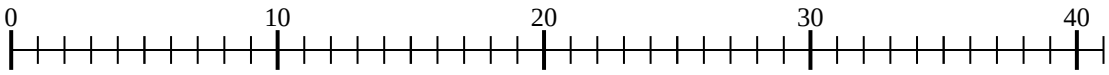

5) 2 × 8 =

8 × 2 =

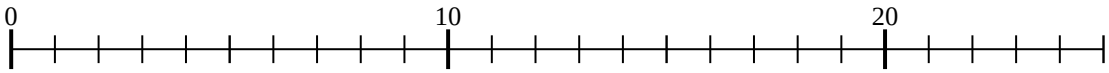

6) 4 × 2 =

2 × 4 =

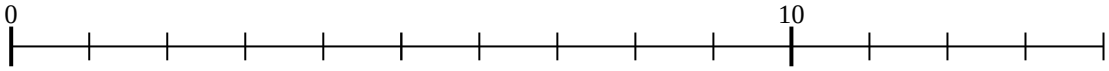

7) 5 × 7 =

7 × 5 =

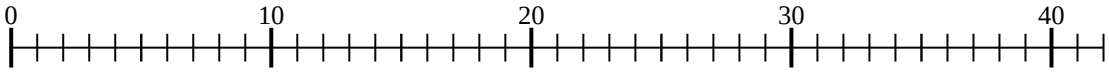

8) 4 × 10 =

10 × 4 =

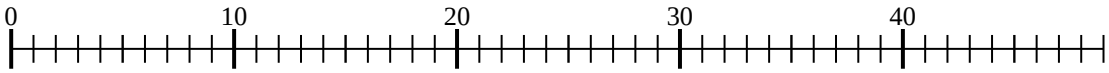

9) 3 × 6 =

6 × 3 =

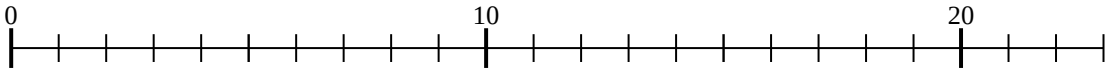

10) 5 × 4 =

4 × 5 =

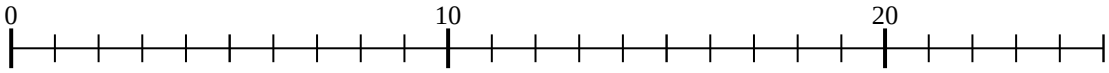

11) 5 × 6 =

6 × 5 =

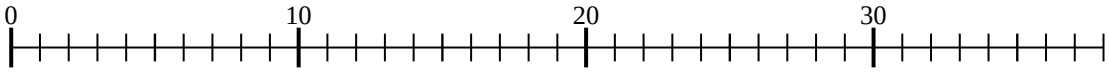

Risposte

1. _____
2. _____
3. _____
4. _____
5. _____
6. _____
7. _____
8. _____
9. _____
10. _____
11. _____

1-10	91	82	73	64	55	45	36	27	18	9
11	0									

Moltiplicazioni con la linea numerata Nome: **Soluzioni**

Usa la linea numerata per risolvere ogni operazione.

1) 2 × 6 =
6 × 2 =

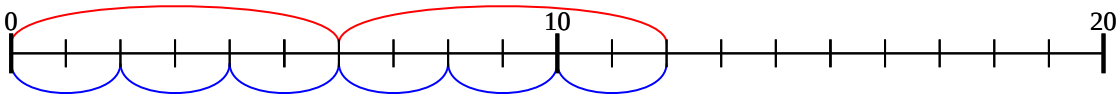

2) 5 × 10 =
10 × 5 =

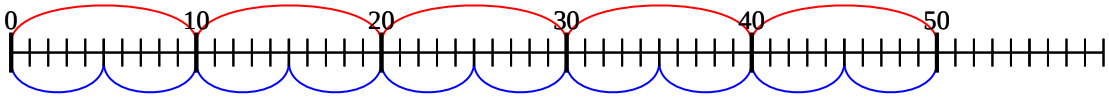

3) 3 × 2 =
2 × 3 =

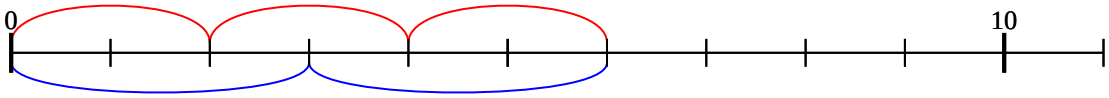

4) 4 × 9 =
9 × 4 =

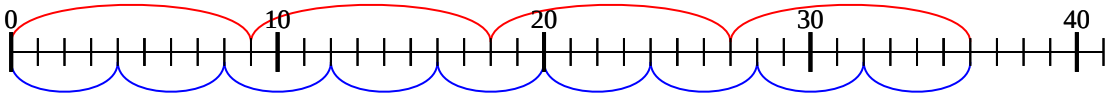

5) 2 × 8 =
8 × 2 =

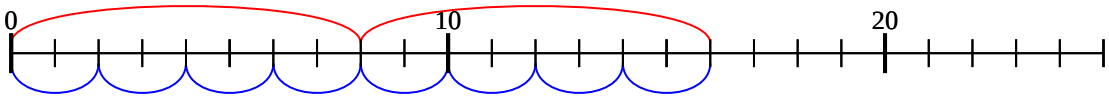

6) 4 × 2 =
2 × 4 =

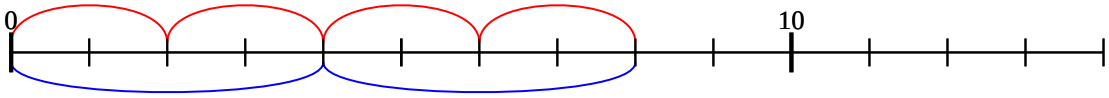

7) 5 × 7 =
7 × 5 =

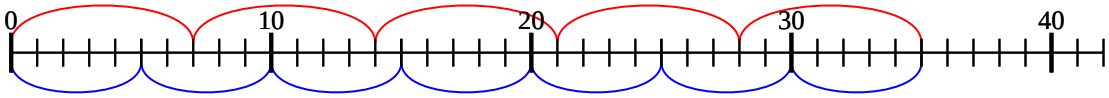

8) 4 × 10 =
10 × 4 =

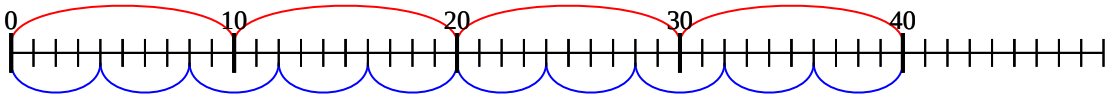

9) 3 × 6 =
6 × 3 =

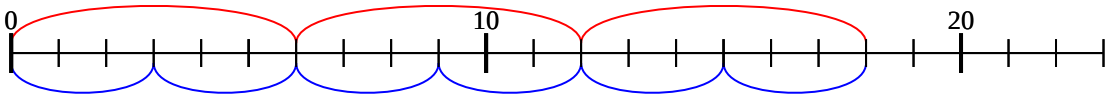

10) 5 × 4 =
4 × 5 =

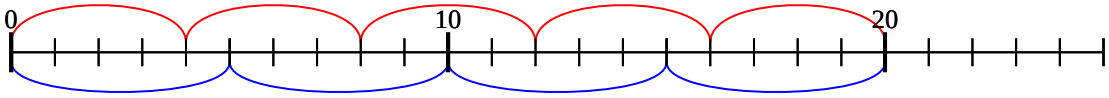

11) 5 × 6 =
6 × 5 =

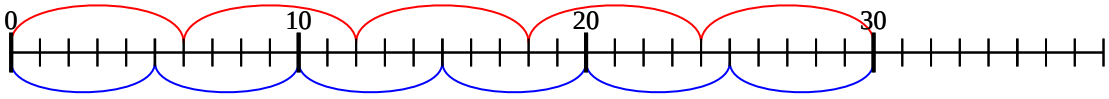

Risposte

1. **12**
2. **50**
3. **6**
4. **36**
5. **16**
6. **8**
7. **35**
8. **40**
9. **18**
10. **20**
11. **30**

1-10	91	82	73	64	55	45	36	27	18	9
11	0									

Moltiplicazioni con la linea numerata

Nome:

Usa la linea numerata per risolvere ogni operazione.

1) 4 × 6 =

6 × 4 =

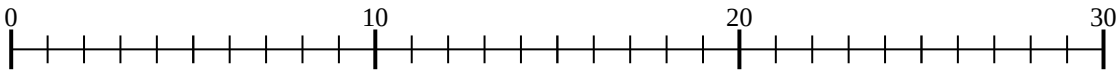

2) 2 × 8 =

8 × 2 =

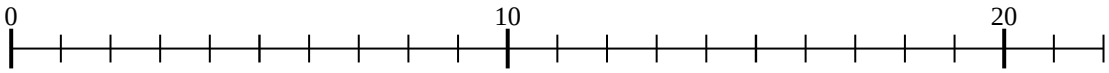

3) 5 × 2 =

2 × 5 =

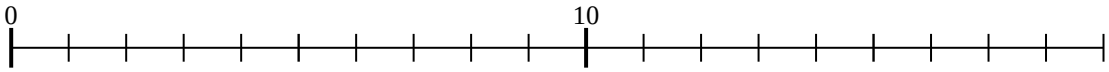

4) 5 × 8 =

8 × 5 =

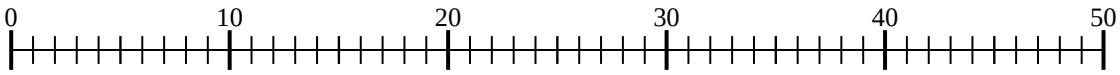

5) 3 × 2 =

2 × 3 =

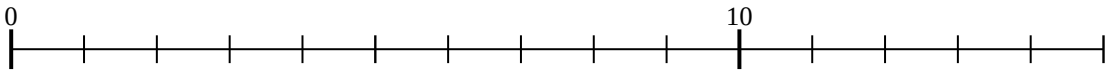

6) 4 × 10 =

10 × 4 =

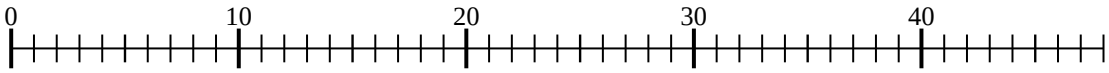

7) 5 × 4 =

4 × 5 =

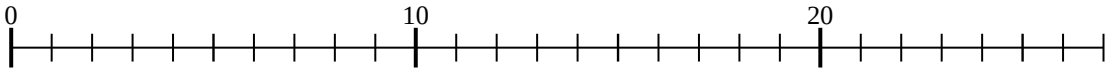

8) 2 × 9 =

9 × 2 =

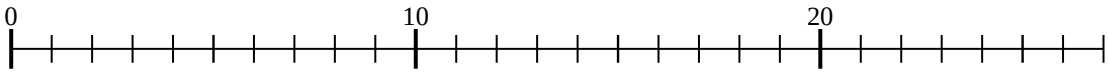

9) 3 × 9 =

9 × 3 =

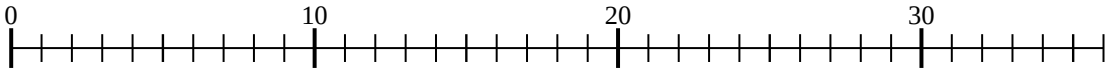

10) 4 × 9 =

9 × 4 =

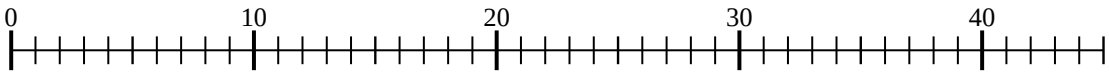

11) 2 × 4 =

4 × 2 =

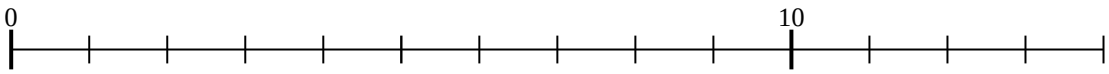

Risposte

1. _____
2. _____
3. _____
4. _____
5. _____
6. _____
7. _____
8. _____
9. _____
10. _____
11. _____

1-10	91	82	73	64	55	45	36	27	18	9
11	0									

Usa la linea numerata per risolvere ogni operazione.

1) 4 × 6 =
6 × 4 =

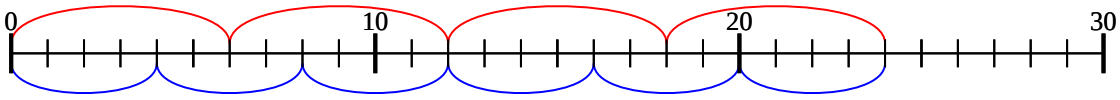

2) 2 × 8 =
8 × 2 =

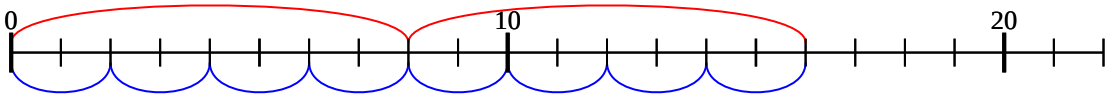

3) 5 × 2 =
2 × 5 =

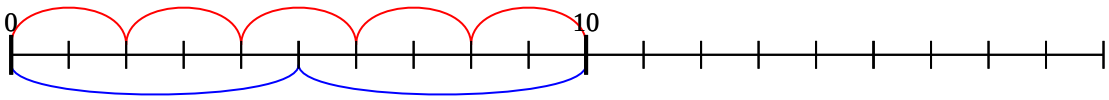

4) 5 × 8 =
8 × 5 =

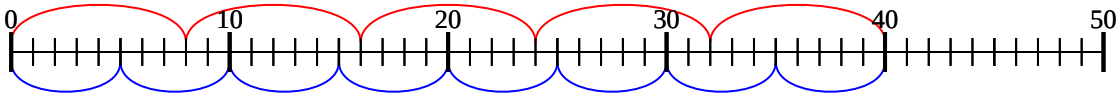

5) 3 × 2 =
2 × 3 =

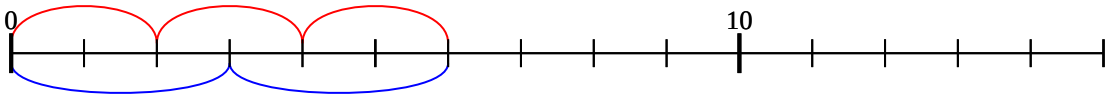

6) 4 × 10 =
10 × 4 =

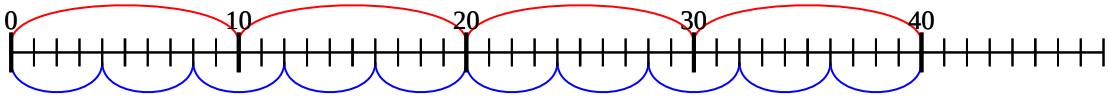

7) 5 × 4 =
4 × 5 =

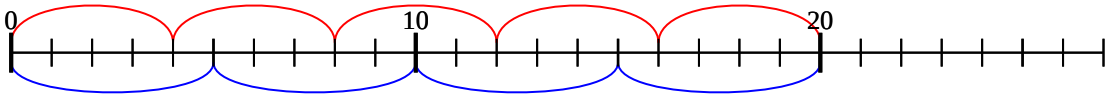

8) 2 × 9 =
9 × 2 =

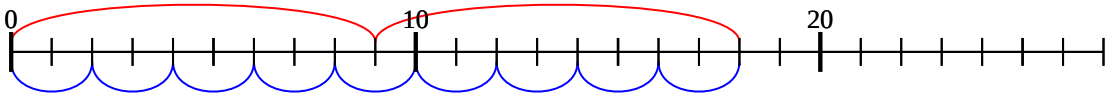

9) 3 × 9 =
9 × 3 =

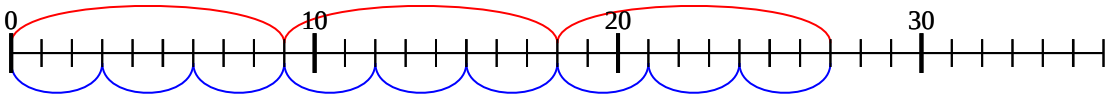

10) 4 × 9 =
9 × 4 =

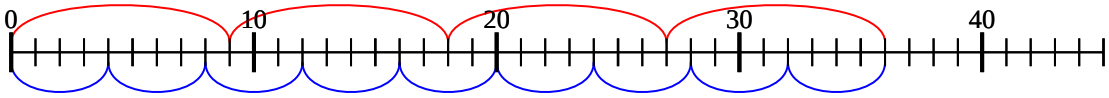

11) 2 × 4 =
4 × 2 =

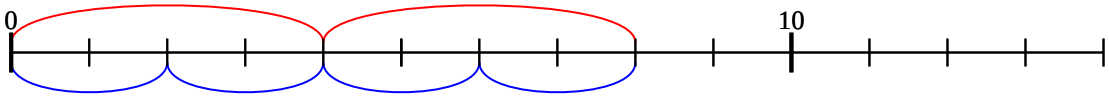

Risposte

1. **24**
2. **16**
3. **10**
4. **40**
5. **6**
6. **40**
7. **20**
8. **18**
9. **27**
10. **36**
11. **8**

1-10	91	82	73	64	55	45	36	27	18	9
11	0									

Moltiplicazioni con la linea numerata

Nome:

Usa la linea numerata per risolvere ogni operazione.

1) 5 × 10 =

10 × 5 =

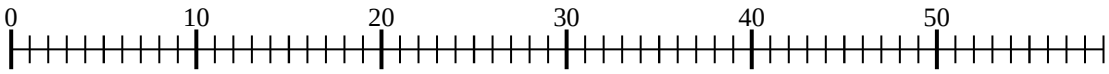

2) 4 × 4 =

4 × 4 =

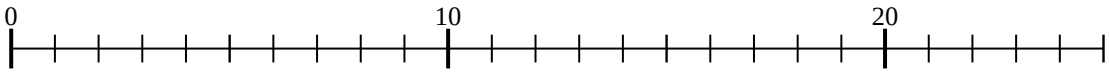

3) 2 × 7 =

7 × 2 =

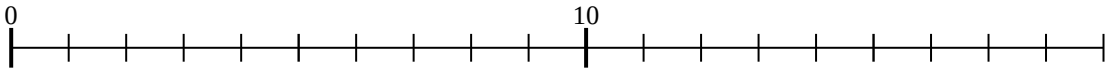

4) 4 × 7 =

7 × 4 =

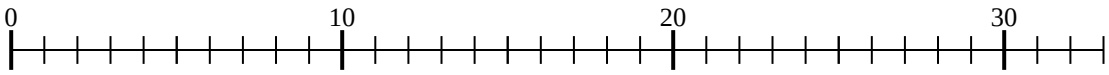

5) 5 × 4 =

4 × 5 =

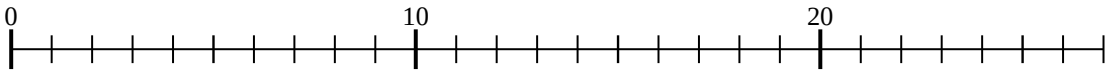

6) 5 × 9 =

9 × 5 =

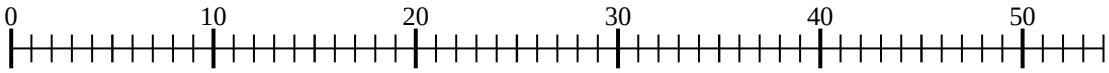

7) 2 × 10 =

10 × 2 =

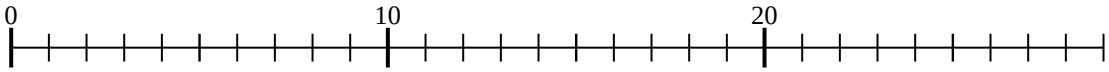

8) 2 × 8 =

8 × 2 =

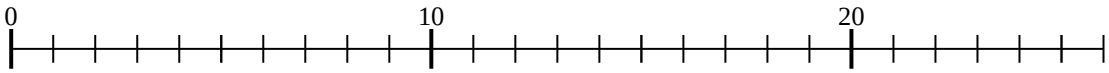

9) 5 × 3 =

3 × 5 =

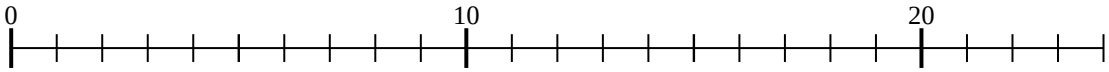

10) 3 × 5 =

5 × 3 =

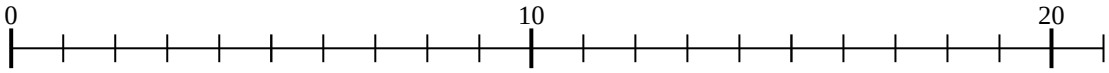

11) 4 × 9 =

9 × 4 =

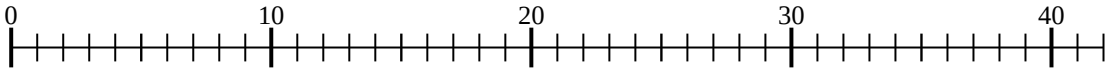

Risposte

1. _____
2. _____
3. _____
4. _____
5. _____
6. _____
7. _____
8. _____
9. _____
10. _____
11. _____

1-10	91	82	73	64	55	45	36	27	18	9
11	0									

Moltiplicazioni con la linea numerata Nome: **Soluzioni**

Usa la linea numerata per risolvere ogni operazione.

1) 5 × 10 =
10 × 5 =

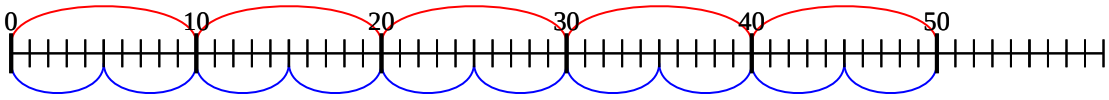

2) 4 × 4 =
4 × 4 =

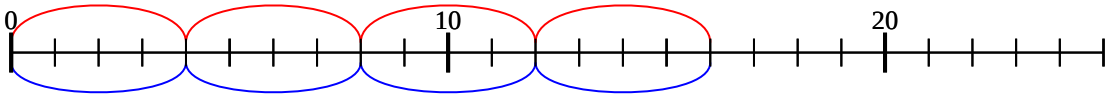

3) 2 × 7 =
7 × 2 =

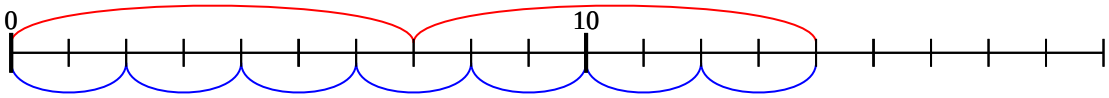

4) 4 × 7 =
7 × 4 =

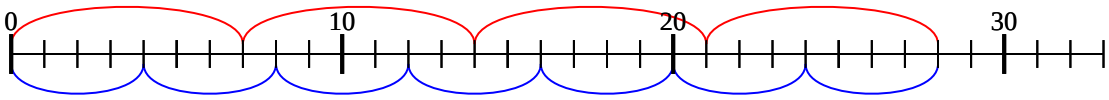

5) 5 × 4 =
4 × 5 =

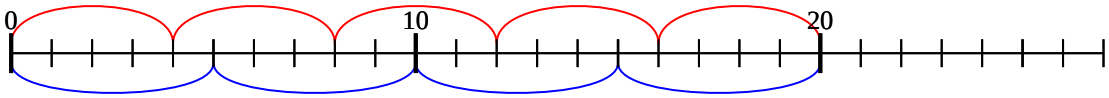

6) 5 × 9 =
9 × 5 =

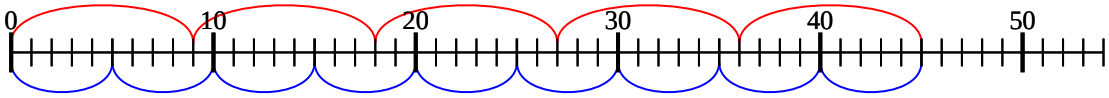

7) 2 × 10 =
10 × 2 =

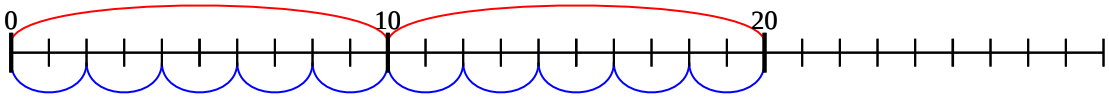

8) 2 × 8 =
8 × 2 =

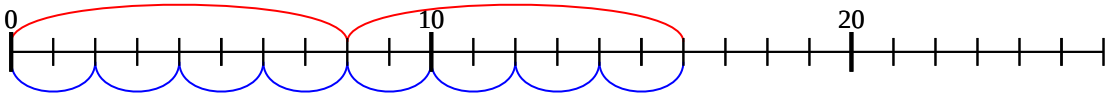

9) 5 × 3 =
3 × 5 =

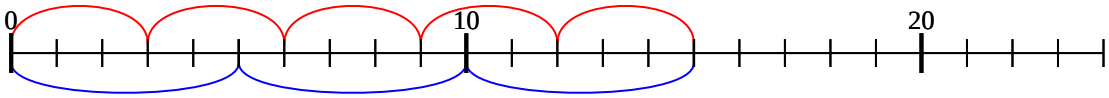

10) 3 × 5 =
5 × 3 =

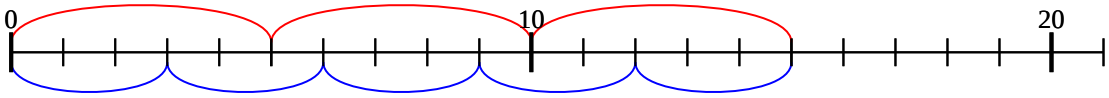

11) 4 × 9 =
9 × 4 =

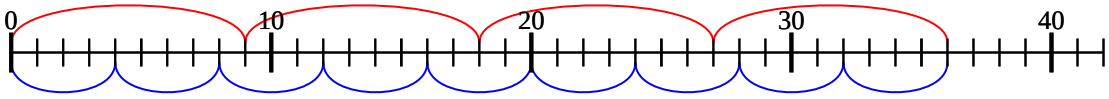

Risposte

1. **50**
2. **16**
3. **14**
4. **28**
5. **20**
6. **45**
7. **20**
8. **16**
9. **15**
10. **15**
11. **36**

1-10	91	82	73	64	55	45	36	27	18	9
11	0									

Moltiplicazioni con la linea numerata

Nome:

Usa la linea numerata per risolvere ogni operazione.

1) 3 × 2 =

2 × 3 =

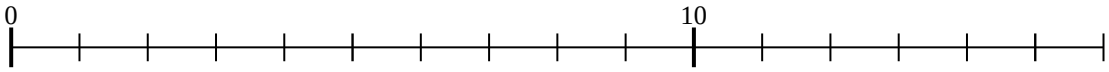

2) 2 × 9 =

9 × 2 =

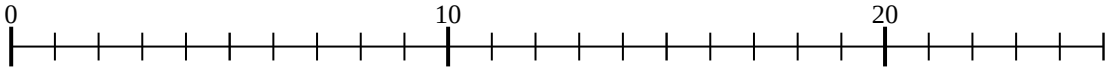

3) 4 × 7 =

7 × 4 =

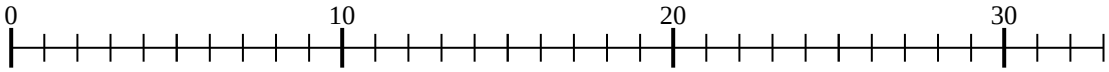

4) 5 × 9 =

9 × 5 =

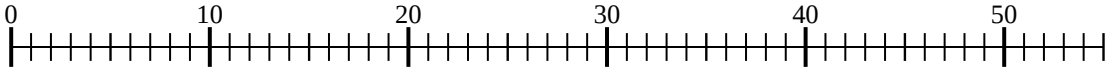

5) 2 × 4 =

4 × 2 =

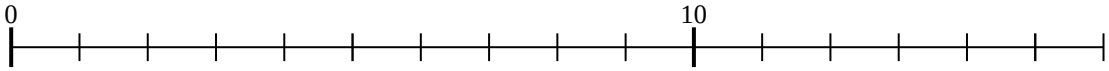

6) 3 × 10 =

10 × 3 =

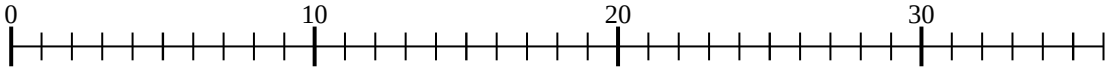

7) 4 × 5 =

5 × 4 =

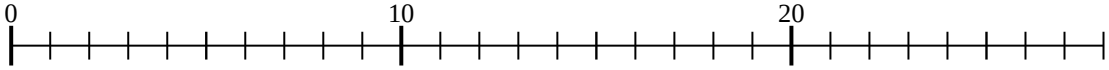

8) 3 × 3 =

3 × 3 =

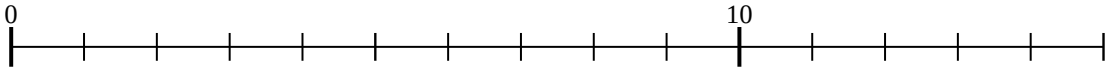

9) 2 × 3 =

3 × 2 =

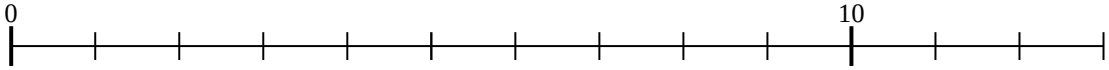

10) 2 × 6 =

6 × 2 =

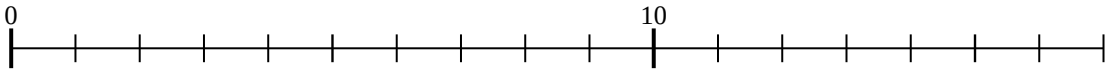

11) 5 × 5 =

5 × 5 =

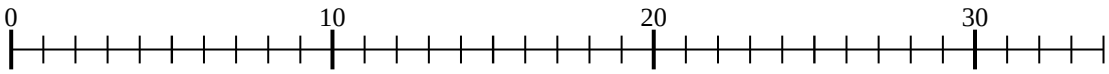

Risposte

1. _____
2. _____
3. _____
4. _____
5. _____
6. _____
7. _____
8. _____
9. _____
10. _____
11. _____

1-10	91	82	73	64	55	45	36	27	18	9
11	0									

Moltiplicazioni con la linea numerata

Nome: **Soluzioni**

Usa la linea numerata per risolvere ogni operazione.

1) 3 × 2 =
2 × 3 =

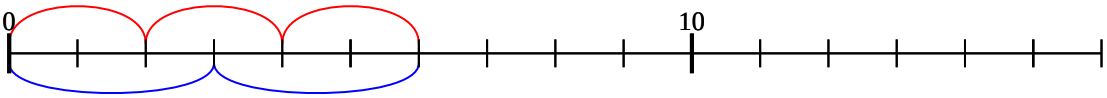

2) 2 × 9 =
9 × 2 =

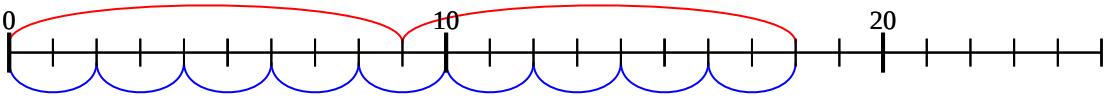

3) 4 × 7 =
7 × 4 =

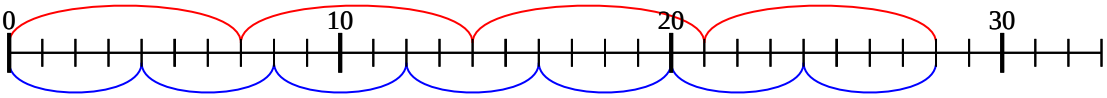

4) 5 × 9 =
9 × 5 =

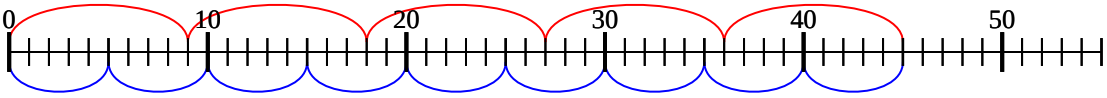

5) 2 × 4 =
4 × 2 =

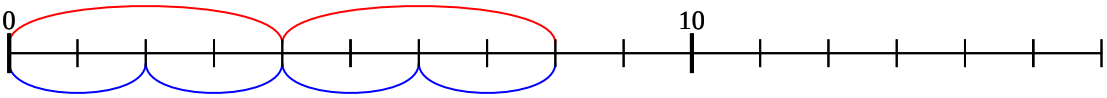

6) 3 × 10 =
10 × 3 =

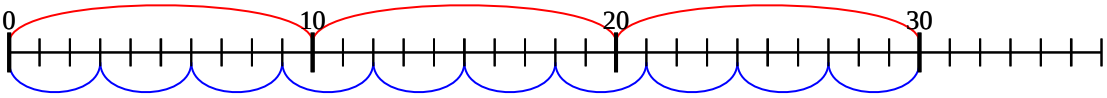

7) 4 × 5 =
5 × 4 =

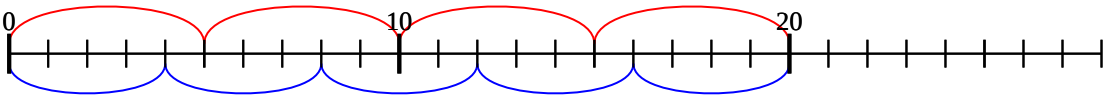

8) 3 × 3 =
3 × 3 =

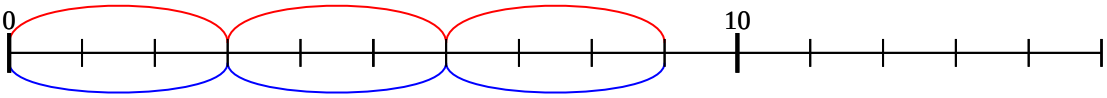

9) 2 × 3 =
3 × 2 =

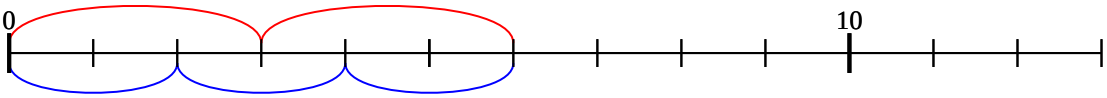

10) 2 × 6 =
6 × 2 =

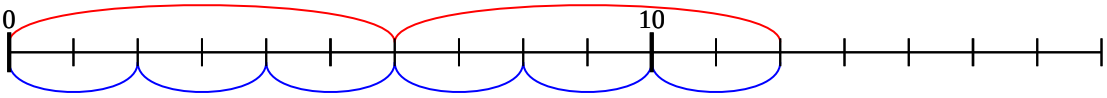

11) 5 × 5 =
5 × 5 =

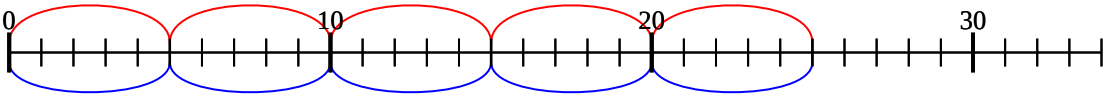

Risposte

1. **6**
2. **18**
3. **28**
4. **45**
5. **8**
6. **30**
7. **20**
8. **9**
9. **6**
10. **12**
11. **25**

1-10	91	82	73	64	55	45	36	27	18	9
11	0									

Moltiplicazioni con la linea numerata

Nome:

Usa la linea numerata per risolvere ogni operazione.

1) 2 × 9 =
9 × 2 =

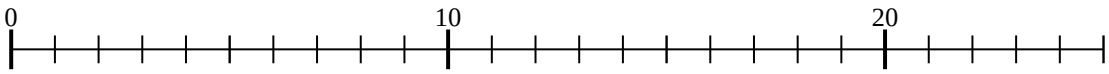

2) 3 × 5 =
5 × 3 =

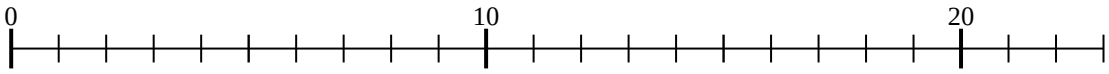

3) 4 × 2 =
2 × 4 =

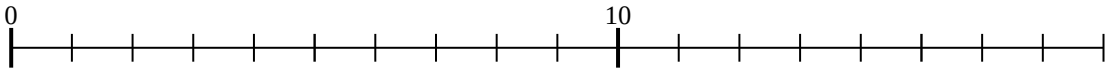

4) 4 × 4 =
4 × 4 =

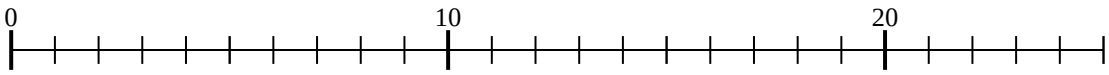

5) 4 × 10 =
10 × 4 =

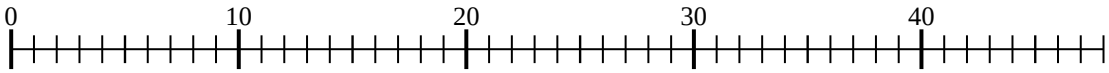

6) 2 × 2 =
2 × 2 =



7) 5 × 9 =
9 × 5 =

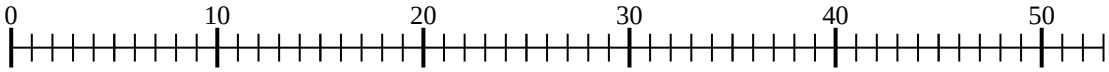

8) 5 × 3 =
3 × 5 =

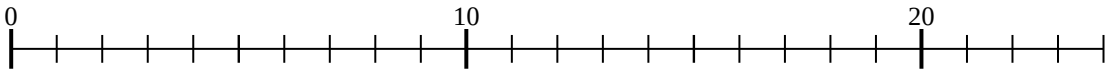

9) 4 × 7 =
7 × 4 =

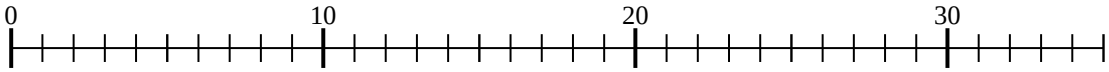

10) 2 × 8 =
8 × 2 =

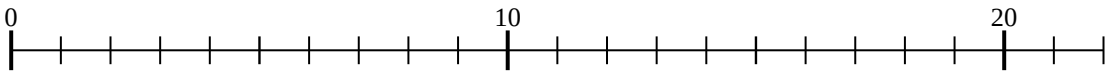

11) 2 × 4 =
4 × 2 =

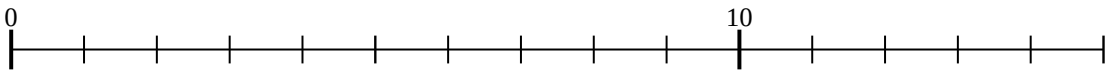

Risposte

1. _____
2. _____
3. _____
4. _____
5. _____
6. _____
7. _____
8. _____
9. _____
10. _____
11. _____

1-10	91	82	73	64	55	45	36	27	18	9
11	0									

Moltiplicazioni con la linea numerata Nome: **Soluzioni**

Usa la linea numerata per risolvere ogni operazione.

1) 2 × 9 =
9 × 2 =

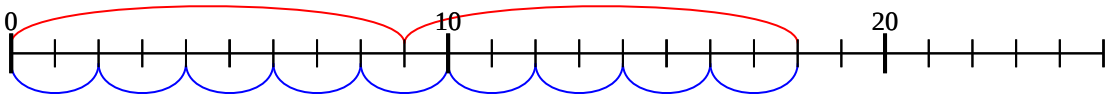

2) 3 × 5 =
5 × 3 =

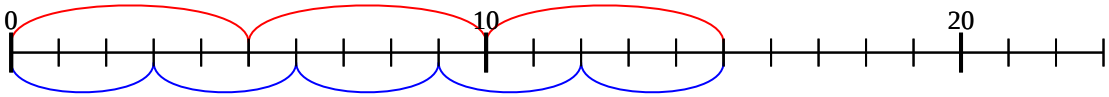

3) 4 × 2 =
2 × 4 =

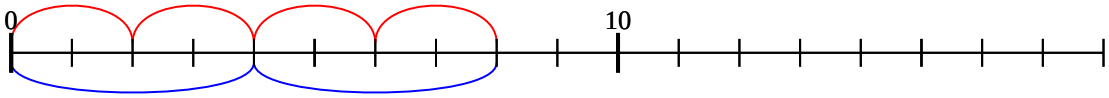

4) 4 × 4 =
4 × 4 =

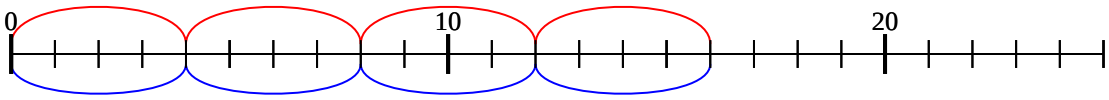

5) 4 × 10 =
10 × 4 =

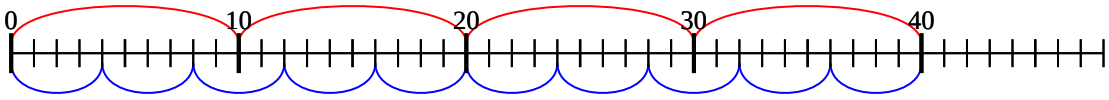

6) 2 × 2 =
2 × 2 =

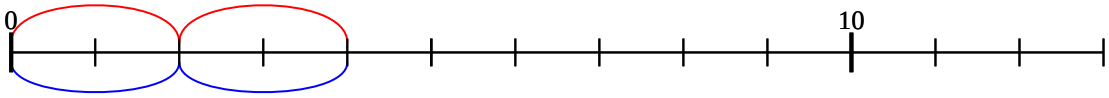

7) 5 × 9 =
9 × 5 =

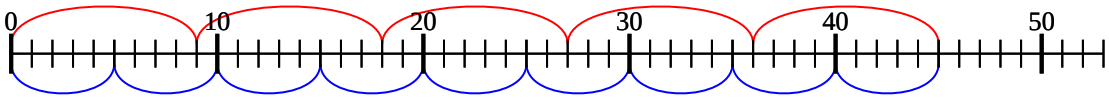

8) 5 × 3 =
3 × 5 =

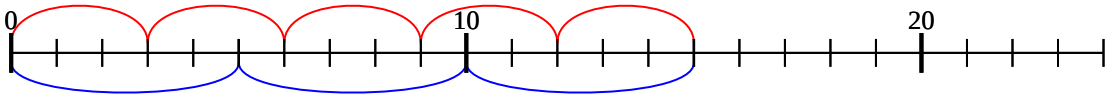

9) 4 × 7 =
7 × 4 =

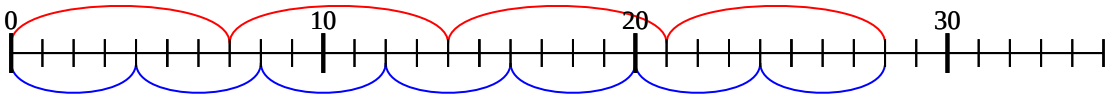

10) 2 × 8 =
8 × 2 =

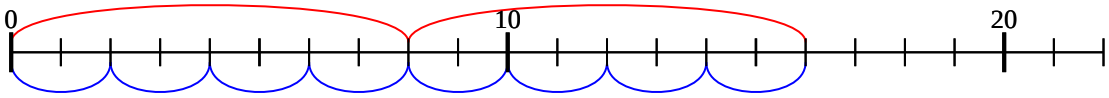

11) 2 × 4 =
4 × 2 =

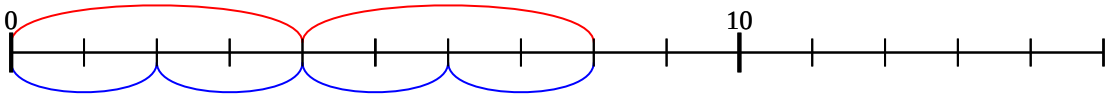

Risposte

1. **18**
2. **15**
3. **8**
4. **16**
5. **40**
6. **4**
7. **45**
8. **15**
9. **28**
10. **16**
11. **8**

1-10	91	82	73	64	55	45	36	27	18	9
11	0									