Moltiplicazioni con la linea numerata

Nome:

Usa la linea numerata per risolvere ogni operazione.

1) 5 × 6 =
6 × 5 =

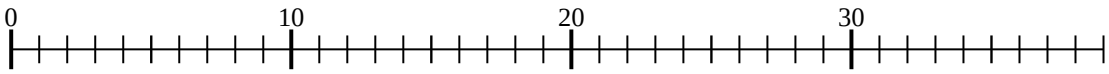

2) 3 × 5 =
5 × 3 =

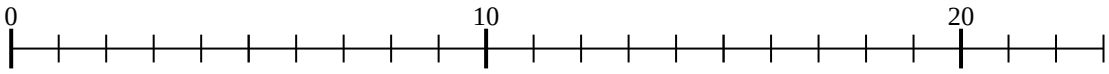

3) 3 × 7 =
7 × 3 =

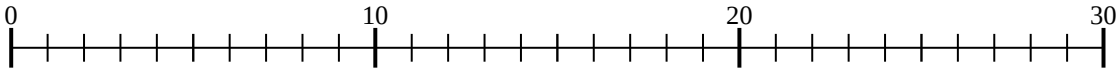

4) 4 × 5 =
5 × 4 =

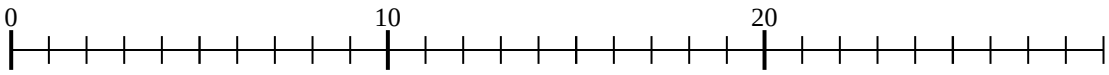

5) 4 × 10 =
10 × 4 =

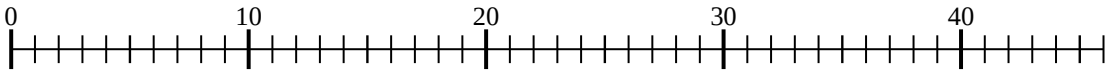

6) 5 × 3 =
3 × 5 =

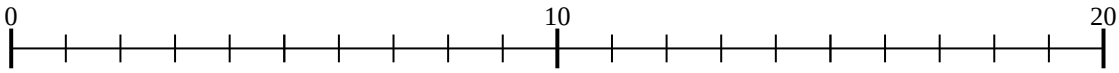

7) 2 × 3 =
3 × 2 =

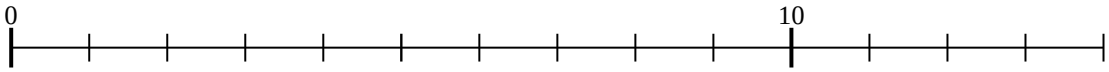

8) 2 × 7 =
7 × 2 =

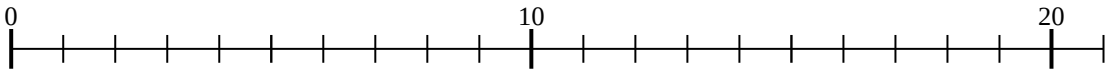

9) 5 × 9 =
9 × 5 =

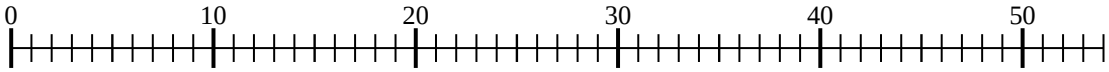

10) 5 × 5 =
5 × 5 =

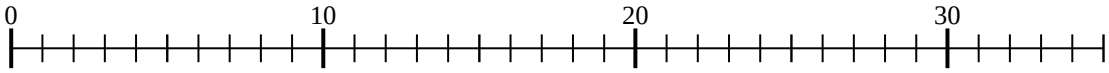

11) 3 × 8 =
8 × 3 =

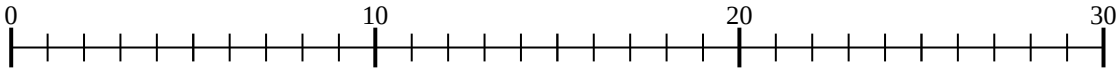

Risposte

1. _____
2. _____
3. _____
4. _____
5. _____
6. _____
7. _____
8. _____
9. _____
10. _____
11. _____

Moltiplicazioni con la linea numerata Nome: **Soluzioni**

Usa la linea numerata per risolvere ogni operazione.

1) 5 × 6 =
6 × 5 =

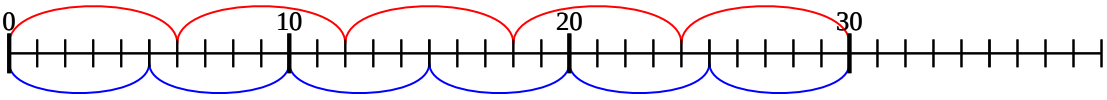

2) 3 × 5 =
5 × 3 =

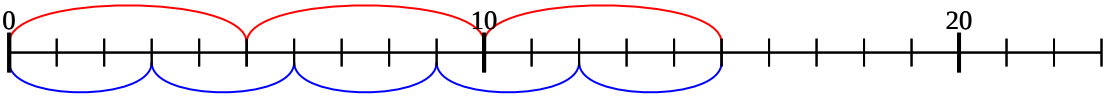

3) 3 × 7 =
7 × 3 =

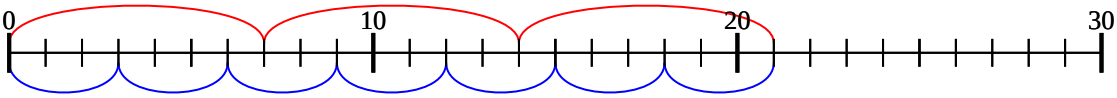

4) 4 × 5 =
5 × 4 =

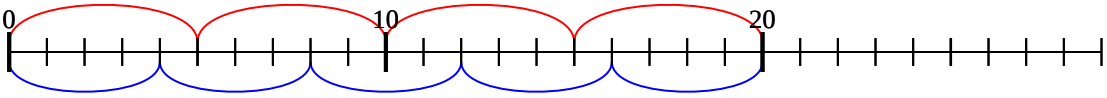

5) 4 × 10 =
10 × 4 =

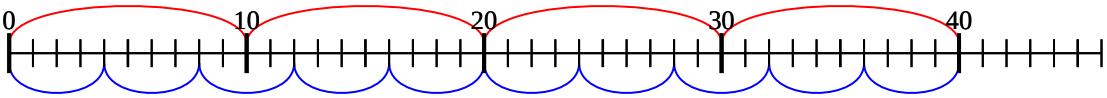

6) 5 × 3 =
3 × 5 =

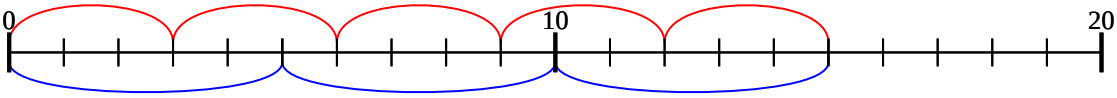

7) 2 × 3 =
3 × 2 =

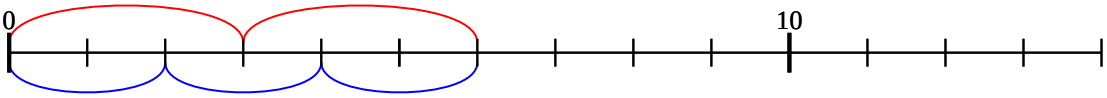

8) 2 × 7 =
7 × 2 =

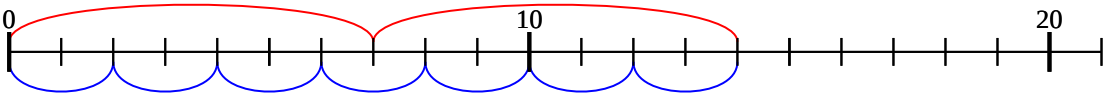

9) 5 × 9 =
9 × 5 =

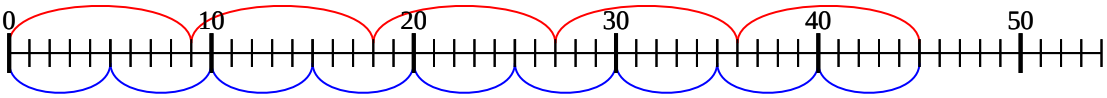

10) 5 × 5 =
5 × 5 =

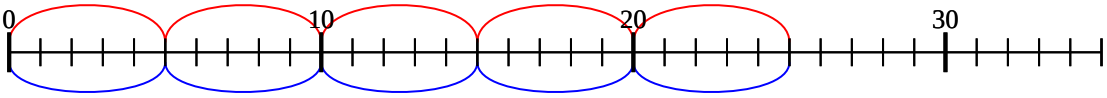

11) 3 × 8 =
8 × 3 =

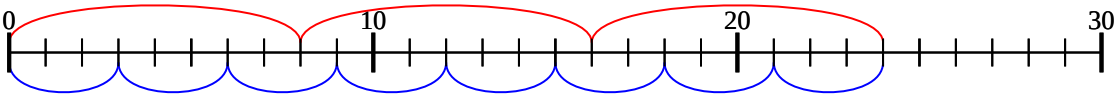

Risposte

1. **30**
2. **15**
3. **21**
4. **20**
5. **40**
6. **15**
7. **6**
8. **14**
9. **45**
10. **25**
11. **24**