Riscrivi le moltiplicazioni (graficamente)

Nome:

Scrivi ogni blocco sotto forma di moltiplicazione e calcola il risultato.

Es)

1)

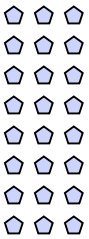

2)



3)

4)

5)



6)

7)



8)



9)

10)

11)

Risposte

Es. **9 × 4 = 36**

1. _____
2. _____
3. _____
4. _____
5. _____
6. _____
7. _____
8. _____
9. _____
10. _____
11. _____

Riscrivi le moltiplicazioni (graficamente) Nome: **Soluzioni**

Scrivi ogni blocco sotto forma di moltiplicazione e calcola il risultato.

Es)

1)

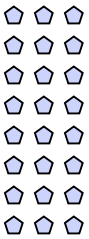

2)



3)

4)

5)



6)

7)



8)



9)

10)

11)

Risposte

Es. **9 × 4 = 36**

1. **8 × 3 = 24**
2. **9 × 2 = 18**
3. **3 × 5 = 15**
4. **7 × 3 = 21**
5. **10 × 2 = 20**
6. **5 × 3 = 15**
7. **4 × 4 = 16**
8. **6 × 9 = 54**
9. **4 × 10 = 40**
10. **6 × 8 = 48**
11. **3 × 2 = 6**

1-10	91	82	73	64	55	45	36	27	18	9
11	0									