Funzioni (Addizioni e sottrazioni) Nome:

Determina quale regola viene usata nelle seguenti funzioni.

Es)

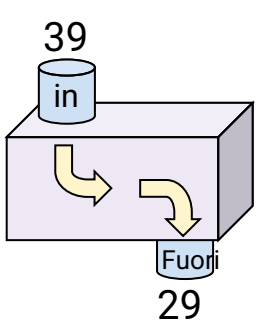

Sottrai 10

1)

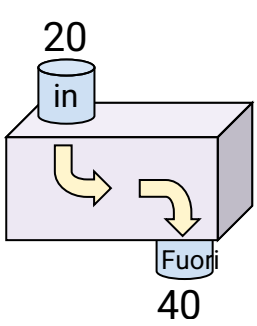

2)

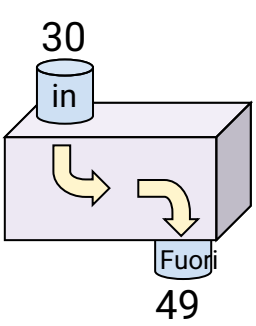

3)

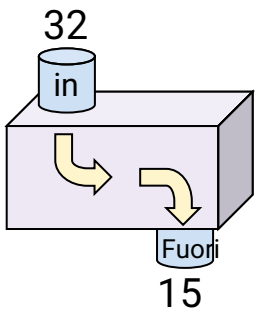

4)

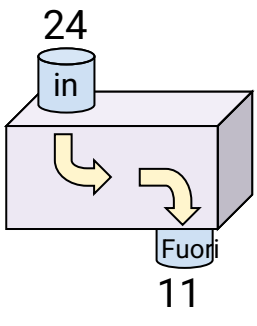

5)

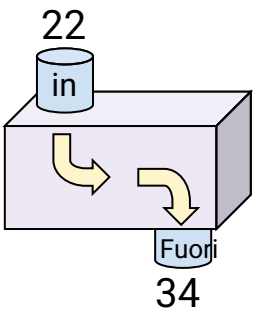

6)

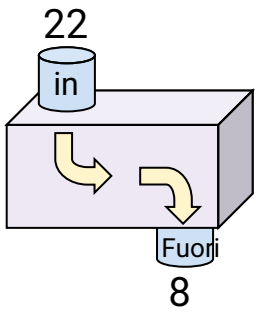

7)

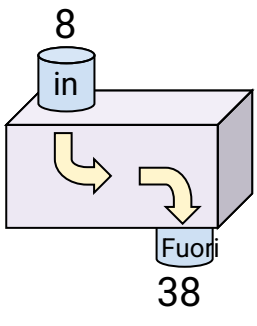

8)

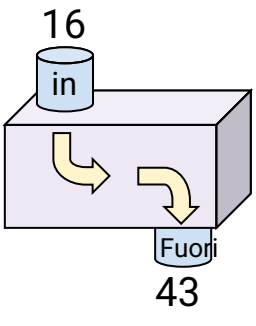

9)

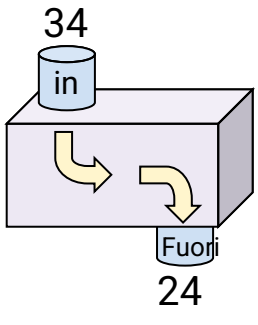

10)

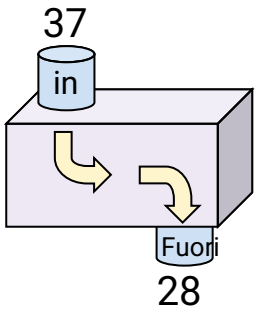

11)

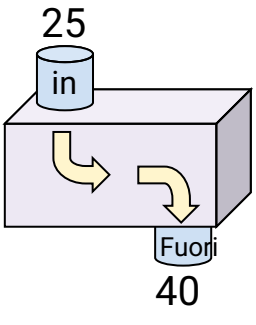

Risposte

Es. Sottrai 10

1. _____
2. _____
3. _____
4. _____
5. _____
6. _____
7. _____
8. _____
9. _____
10. _____
11. _____

Funzioni (Addizioni e sottrazioni) Nome: **Soluzioni**

Determina quale regola viene usata nelle seguenti funzioni.

Es)

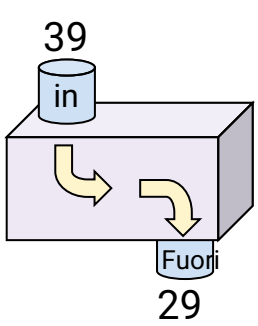

Sottrai 10

1)

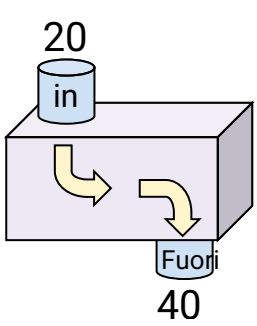

Aggiungi 20

2)

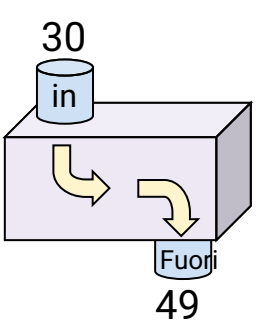

Aggiungi 19

3)

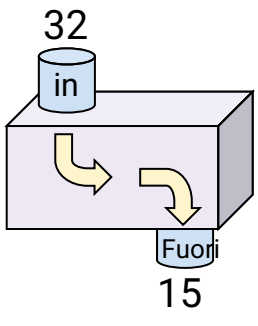

Sottrai 17

4)

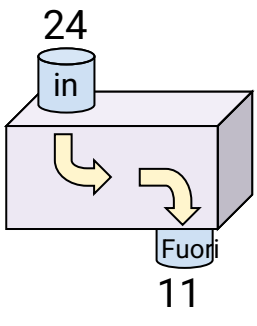

Sottrai 13

5)

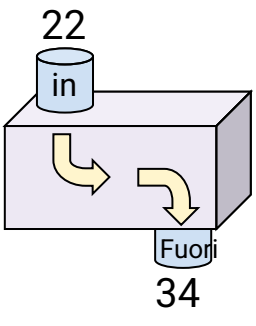

Aggiungi 12

6)

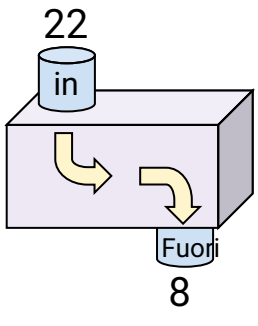

Sottrai 14

7)

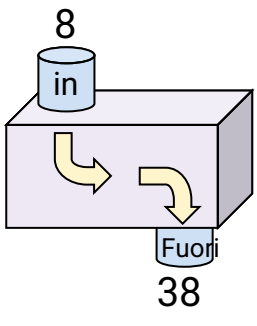

Aggiungi 30

8)

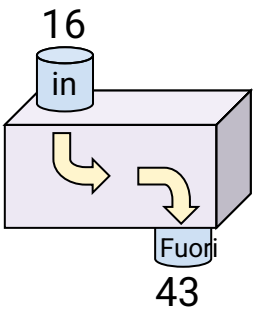

Aggiungi 27

9)

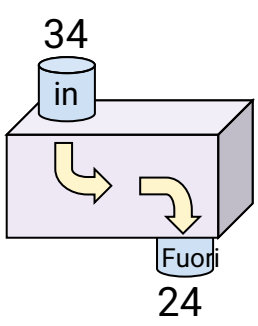

Sottrai 10

10)

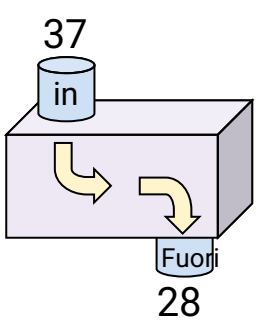

Sottrai 9

11)

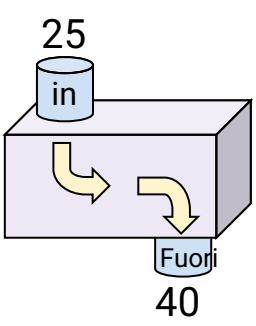

Aggiungi 15

Risposte

Es.	Sottrai 10
1.	Aggiungi 20
2.	Aggiungi 19
3.	Sottrai 17
4.	Sottrai 13
5.	Aggiungi 12
6.	Sottrai 14
7.	Aggiungi 30
8.	Aggiungi 27
9.	Sottrai 10
10.	Sottrai 9
11.	Aggiungi 15