Contare le figure

Nome:

Conta il numero delle forme in ogni quadrato.



Es) = 7

1)  = _____

2) = _____

3) = _____



4) = _____

5) = _____

6) = _____

7) = _____



8) = _____

9) = _____

10) = _____

11) = _____

Contare le figure

Nome: **Soluzioni**

Conta il numero delle forme in ogni quadrato.



Es) = 7

1)  = 3

2) = 4

3) = 4



4) = 4

5) = 4

6) = 2

7) = 4



8) = 3

9) = 5

10) = 2

11) = 6