Valore della posizione graficamente (meno di 20) Nome:

Riempi gli spazi per trovare la quantità.

Es)

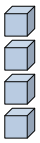

0 decine 4 decine

1)

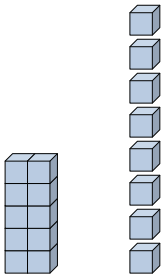

decine decine

2)

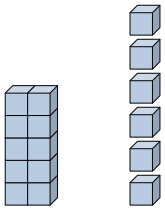

decine decine

3)

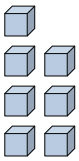

decine decine

4)

decine decine

5)

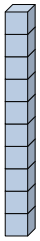

decine decine

6)

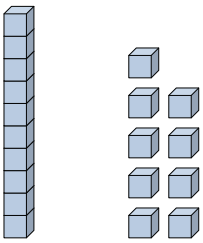

decine decine

7)

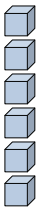

decine decine

8)

decine decine

9)

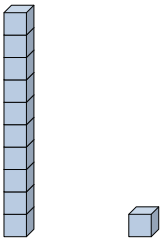

decine decine

10)

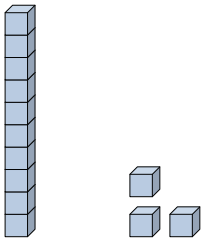

decine decine

11)

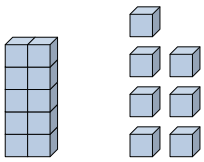

decine decine

Risposte

Es. 4

1. _____
2. _____
3. _____
4. _____
5. _____
6. _____
7. _____
8. _____
9. _____
10. _____
11. _____

Valore della posizione graficamente (meno di 20) Nome: **Soluzioni**

Riempi gli spazi per trovare la quantità.

Es)

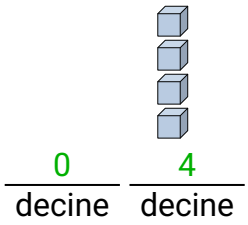

0 decine 4 decine

1)

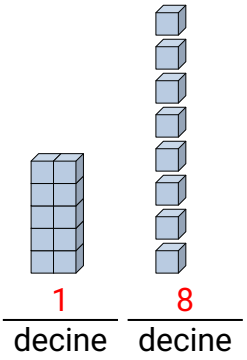

1 decine 8 decine

2)

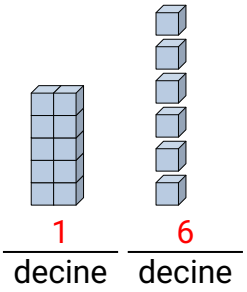

1 decine 6 decine

3)

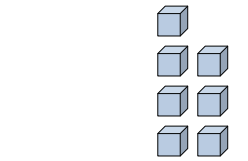

0 decine 7 decine

4)

0 decine 2 decine

5)

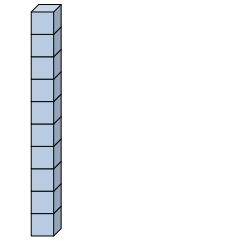

1 decine 0 decine

6)

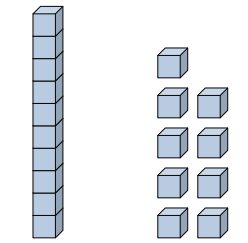

1 decine 9 decine

7)

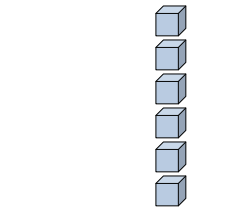

0 decine 6 decine

8)

0 decine 1 decine

9)

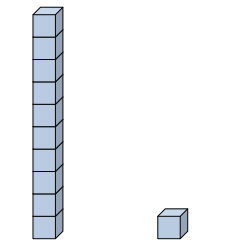

1 decine 1 decine

10)

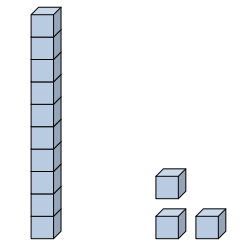

1 decine 3 decine

11)

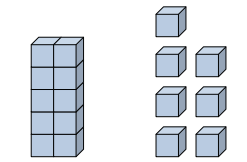

1 decine 7 decine

Risposte

Es.	4
1.	18
2.	16
3.	7
4.	2
5.	10
6.	19
7.	6
8.	1
9.	11
10.	13
11.	17