Valore della posizione graficamente (meno di 20) Nome:

Riempi gli spazi per trovare la quantità.

Es)

0 4

decine unità

1)

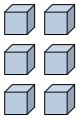

decine unità

2)

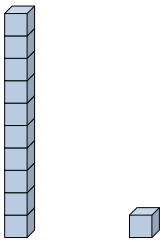

decine unità

3)

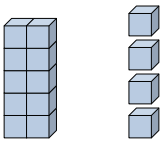

decine unità

4)

decine unità

5)

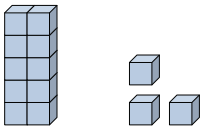

decine unità

6)

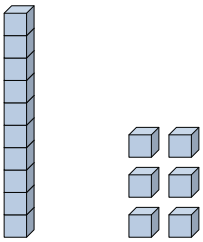

decine unità

7)

decine unità

8)

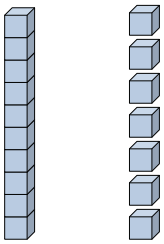

decine unità

9)

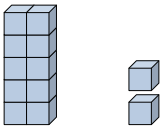

decine unità

10)

decine unità

11)

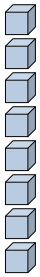

decine unità

Risposte

Es. 4

1. _____
2. _____
3. _____
4. _____
5. _____
6. _____
7. _____
8. _____
9. _____
10. _____
11. _____

1-10	91	82	73	64	55	45	36	27	18	9
11	0									

Valore della posizione graficamente (meno di 20) Nome: **Soluzioni**

Riempi gli spazi per trovare la quantità.

Es)

0 decine 4 unità

1)

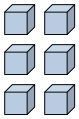

0 decine 6 unità

2)

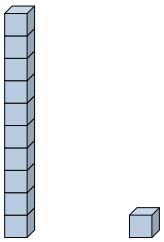

1 decine 1 unità

3)

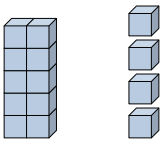

1 decine 4 unità

4)

0 decine 2 unità

5)

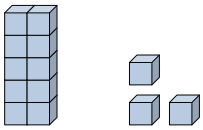

1 decine 3 unità

6)

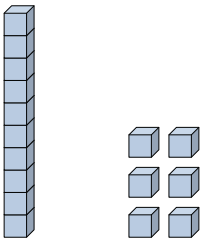

1 decine 6 unità

7)

0 decine 3 unità

8)

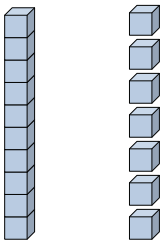

1 decine 7 unità

9)

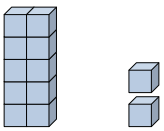

1 decine 2 unità

10)

0 decine 9 unità

11)

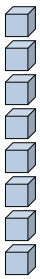

0 decine 8 unità

Risposte

Es.	4
1.	6
2.	11
3.	14
4.	2
5.	13
6.	16
7.	3
8.	17
9.	12
10.	9
11.	8

1-10	91	82	73	64	55	45	36	27	18	9
11	0									